OXFORD AQA
INTERNATIONAL QUALIFICATIONS

Please write clearly in block capitals.

Centre number | | | | | | Candidate number | | | | |

Surname _____

Forename(s) _____

Candidate signature _____
I declare this is my own work.

INTERNATIONAL A-LEVEL
PHYSICS

Unit 5 Physics in practice

Thursday 12 June 2025 | 07:00 GMT | Time allowed: 2 hours

Materials
For this paper you must have:
- a Data and Formulae Booklet as a loose insert
- a ruler with millimetre measurements
- a scientific calculator, which you are expected to use where appropriate
- a protractor.

Instructions
- Use black ink or black ball-point pen.
- Fill in the boxes at the top of this page.
- Answer **all** questions.
- You must answer the questions in the spaces provided. Do not write outside the box around each page or on blank pages.
- All working must be shown.
- If you need extra space for your answer(s), use the lined pages at the end of this book. Write the question number against your answer(s).
- Do all rough work in this book. Cross through any work you do not want to be marked.

Information
- The marks for questions are shown in brackets.
- The maximum mark for this paper is 80.

For Examiner's Use	
Question	Mark
1	
2	
3	
4	
5	
6	
TOTAL	

Do not write outside the box

Section A

Answer **all** questions in this section.

0 1 This question is about interference of light.

0 1 . 1 In a Young's double-slit experiment with a laser, the fringe spacing is determined to be $4.5\ \text{mm} \pm 2\%$.

The distance between the double slit and the screen is measured using a metre ruler as $0.503\ \text{m} \pm 0.2\%$.

The double-slit spacing is $0.05\ \text{mm} \pm 5\%$.

Determine the wavelength of the light.
Go on to determine its absolute uncertainty.

[4 marks]

wavelength = _____ ± _____ m

Do not write outside the box

A student does another Young's double-slit experiment to determine the wavelength of light from a different laser.

Figure 1 shows the whole screen and the fringe pattern produced on it.
A ruler is shown next to the screen. The smallest division of this ruler is 1 mm.

Figure 1

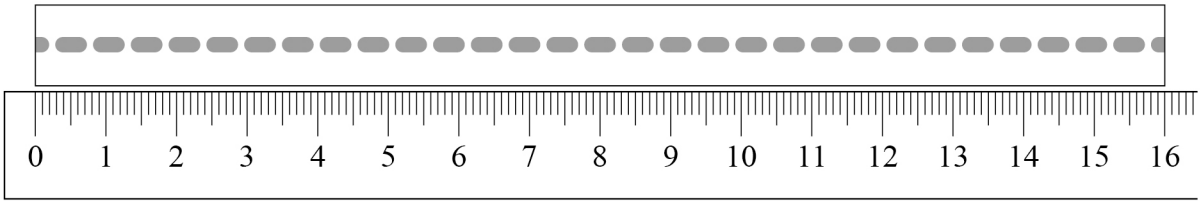

0 1 . 2 Explain why the student determines the fringe spacing by making the measurement across multiple fringes.

[1 mark]

_____

_____

_____

_____

0 1 . 3 Determine an accurate value for the fringe spacing.
Annotate **Figure 1** to show the readings you take from the ruler.

[2 marks]

fringe spacing = _____ mm

Question 1 continues on the next page

Do not write outside the box

0 1 . 4 Calculate the percentage uncertainty in your answer to Question **01.3**.

[2 marks]

percentage uncertainty = ± _____ %

Do not write outside the box

0 1 . 5 The student now compares the double-slit pattern shown in **Figure 1** with the pattern from a diffraction grating.

W_1 is the width of the pattern that fits on the screen using the double slit, as shown in **Figure 1**.

The same screen and the same laser are used for both patterns. The distance between the screen and the diffraction grating is the same as the distance between the screen and the double slit.

The student ensures that the zero order ($n = 0$) for the diffraction-grating pattern is in the centre of the screen.

W_2 is the maximum width of the pattern that fits on the screen using the diffraction grating.

W_1 and W_2 are measured with the same measuring device.

Discuss whether W_2 has a smaller percentage uncertainty than W_1.

wavelength of laser light = 550 nm
diffraction-grating spacing = 5.0×10^{-6} m
distance between screen and diffraction grating = 0.503 m

[3 marks]

12

Do not write outside the box

0 2 This question is about an experiment to determine the speed of light in water using a range finder.

The range finder measures the time between the emission of a pulse of light and the reception of the reflected pulse.

The range finder then converts this time into a distance, based on the assumption that the light is travelling in air. The speed of light in air is $3.00 \times 10^8 \text{ m s}^{-1}$.

Figure 2 shows the range finder measuring the distance h to the bottom of an empty measuring cylinder.

Figure 2

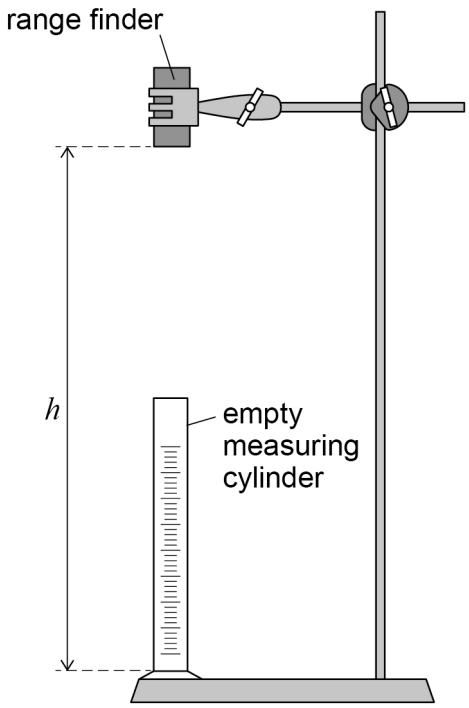

The distance reading on the range finder is l.

l is equal to h when the measuring cylinder is empty.

Do not write outside the box

Figure 3 shows the same arrangement after a volume V of water has been added to the measuring cylinder.

Figure 3

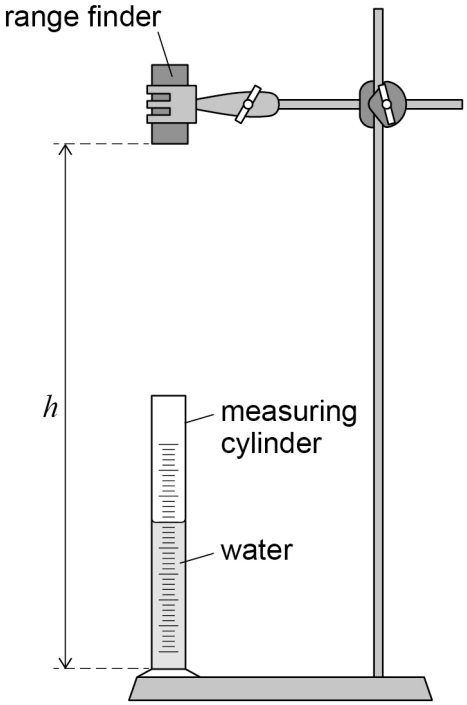

The pulse of light now travels through the air and the water and is reflected from the bottom of the measuring cylinder back to the range finder.

0 2 . 1 Explain why l is now greater than h.

[2 marks]

Question 2 continues on the next page

Do not write outside the box

V is varied and the reading l on the range finder is recorded.
h is kept constant throughout the experiment.

Table 1 shows measurements of V and l from the experiment.

Table 1

V / 10^{-6} m^3	l / 10^{-3} m
100	527
120	533
140	538
160	544
200	555

0 2 . 2 Draw, on **Figure 4**, a graph of l against V.
Use a false origin on the l axis.

[4 marks]

0 2 . 3 Determine the gradient of your graph.

[2 marks]

gradient = _____

Do not write outside the box

Figure 4



Question 2 continues on the next page

Do not write outside the box

The relationship between V and l is given by

$$4V\left(\frac{c}{c_w} - 1\right) = (l - h)\pi d^2$$

where

c_w is the speed of light in water
d is the diameter of the measuring cylinder.

0 2 . 4 Determine c_w.

$d = 3.93 \times 10^{-2}$ m

[3 marks]

$c_w =$ _____ m s^{-1}

0 2 . 5 h is the y-intercept of the graph of l against V.

Determine h.

[2 marks]

$h =$ _____ m

Do not write outside the box

The internal diameter of a different measuring cylinder is measured using vernier calipers.

Figure 5 shows part of the vernier calipers.

Figure 5

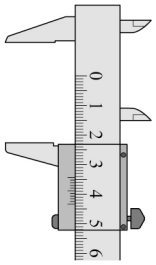

0 2 . 6 Draw, on **Figure 5**, an empty measuring cylinder to show how its **internal** diameter is measured.

[1 mark]

0 2 . 7 **Figure 6** shows part of the scale on the vernier calipers when measuring the internal diameter of the measuring cylinder.

Figure 6

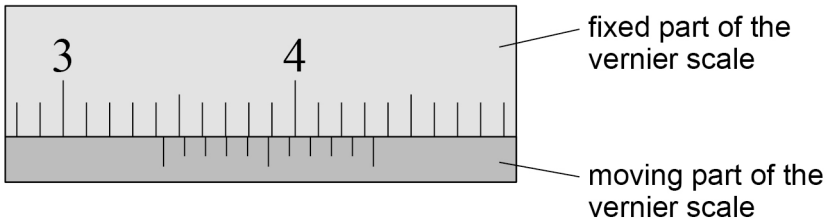

The smallest division on the fixed part of the scale is 1 mm.

State the internal diameter of this measuring cylinder.

[1 mark]

internal diameter = _____ mm

15

Do not write outside the box

0 3 This question is about the damped oscillations of a ball on a curved track.

Figure 7 shows the curved track on a table.

Figure 7

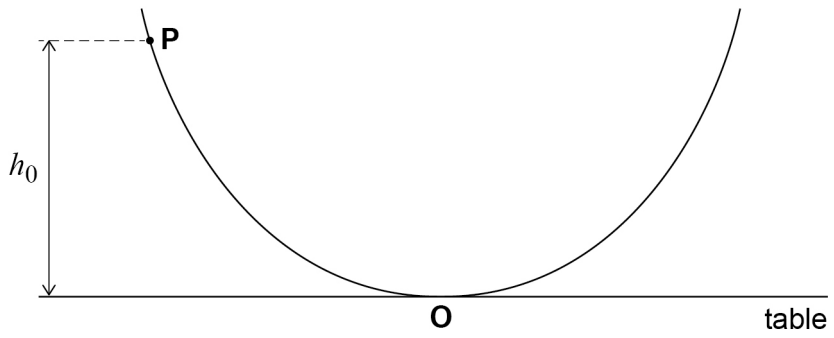

A black pen is used to make a mark at point **P** on the track at a height h_0 above the table. h_0 is less than $1\ \mathrm{m}$.

0 3 . 1 Explain how to measure h_0 accurately using a metre ruler.
Other laboratory equipment is also available.
You may annotate **Figure 7** as part of your answer.

[2 marks]

Do not write outside the box

The lowest point on the ball is placed level with **P** as shown in **Figure 8**.

Figure 8

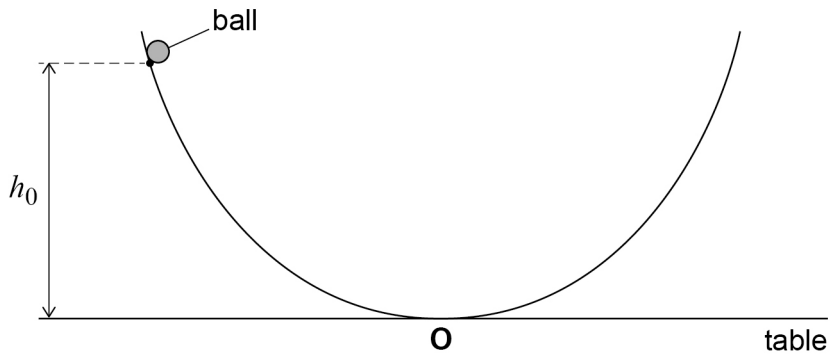

The ball is released from a height h_0 and rolls along the track.

The oscillations of the ball about point **O** are damped. The height reached by the ball after each oscillation decreases until the ball eventually comes to rest at **O**.

A student suggests that the height reached by the ball at the end of each oscillation decreases exponentially.

0 3 . 2 After one complete oscillation, the lowest point on the ball reaches a height h_1.

Describe how to make an accurate measurement of h_1 with a metre ruler.
You do not need to repeat information from your answer to Question **03.1**.

[2 marks]

Question 3 continues on the next page

Do not write outside the box

0 3 . 3 The ball is released from $h_0 = 751$ mm.

The height reached by the ball is measured after each oscillation.
Table 2 shows the data.

Table 2

Number of complete oscillations	Height / mm
1	642
2	545
3	474

Determine whether the height reached by the ball decreases exponentially with the number of oscillations.

[2 marks]

Do not write outside the box

0 3 . 4 The student suggests that the time for each oscillation of the ball is constant.

Describe how this suggestion could be tested using a stopwatch.
Go on to explain how to ensure the accuracy of the measurement.

[3 marks]

9

END OF SECTION A

Do not write outside the box

Section B

Answer **all** questions in this section.

0 4 The Voyager 2 spacecraft was launched in 1977 and has travelled to the edge of the Solar System. It was designed to operate until 2023 when it would be at a distance of 2.0×10^{13} m from the Sun.

0 4 . 1 Satellites in orbit around the Earth use solar panels for power. Voyager 2 has a similar power requirement to these satellites.

Explain why solar panels are **not** suitable to power Voyager 2 when it is at a distance of 2.0×10^{13} m from the Sun.

Support your answer with a calculation.

distance from the Earth to the Sun = 1.5×10^{11} m

[3 marks]

Do not write outside the box

0 4 . 2 Voyager 2 is powered by radioisotope thermoelectric generators (RTGs). In these RTGs, the radioactive decay of plutonium-238 provides heat which is converted into electrical energy.

When Voyager 2 was launched in 1977 the RTGs were able to supply the spacecraft with a total power of 471 W.

Calculate the power available from the RTGs after 46 years.
Assume that the efficiency of the RTGs remains constant.

half-life of plutonium-238 = 87.7 years

[3 marks]

power = _____ W

Question 4 continues on the next page

Do not write outside the box

0 4 . 3 In 1981 Voyager 2 passed the planet Saturn and collected the following data at a point in Saturn's atmosphere:

- temperature at the point was 143 K
- pressure at the point was 1.2×10^5 Pa
- 25% of the particles were helium atoms
- 75% of the particles were hydrogen molecules.

Estimate the density of Saturn's atmosphere at this point.

molar mass of helium atoms = $4.0\ \text{g mol}^{-1}$
molar mass of hydrogen molecules = $2.0\ \text{g mol}^{-1}$

[3 marks]

density = _____ kg m^{-3}

Do not write outside the box

0 4 . 4 Voyager 2 does not have any rockets or thrusters to provide a driving force.

In 1989 it passed Neptune travelling at a speed v.
The distance between Neptune and the Sun is 4.5×10^{12} m.

In 2023 Voyager 2 had a speed of 1.53×10^{4} m s^{-1} when it was at a distance of 2.0×10^{13} m from the Sun.

The mass of Voyager 2 is 722 kg.

Calculate v.
You should only consider the effect of the Sun's gravitational field on Voyager 2.

[3 marks]

$v =$ _____ m s^{-1}

12

Turn over for the next question

Do not write outside the box

There are no questions printed on this page

DO NOT WRITE ON THIS PAGE
ANSWER IN THE SPACES PROVIDED

Do not write outside the box

0 5 A magnet **P** is suspended from a spring. **P** is initially stationary and in equilibrium, with its centre of mass at position **O**.

Figure 9 shows **P** in this equilibrium position in a coil of wire.
The coil is connected to an oscilloscope. The oscilloscope has a very high resistance.

Figure 9

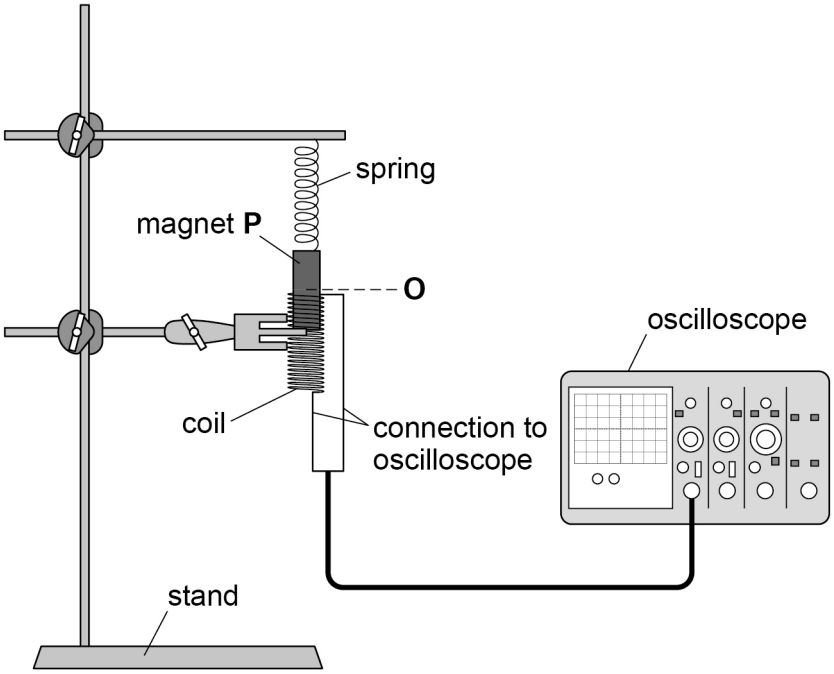

P is pulled a distance y below **O** and released. **P** oscillates about **O**.

0 5 . 1 Explain why the oscillations of **P** induce an emf across the coil.

[2 marks]

Question 5 continues on the next page

Do not write outside the box

Figure 10 shows the controls on the oscilloscope and the trace on the screen as **P** oscillates about **O**.

Figure 10

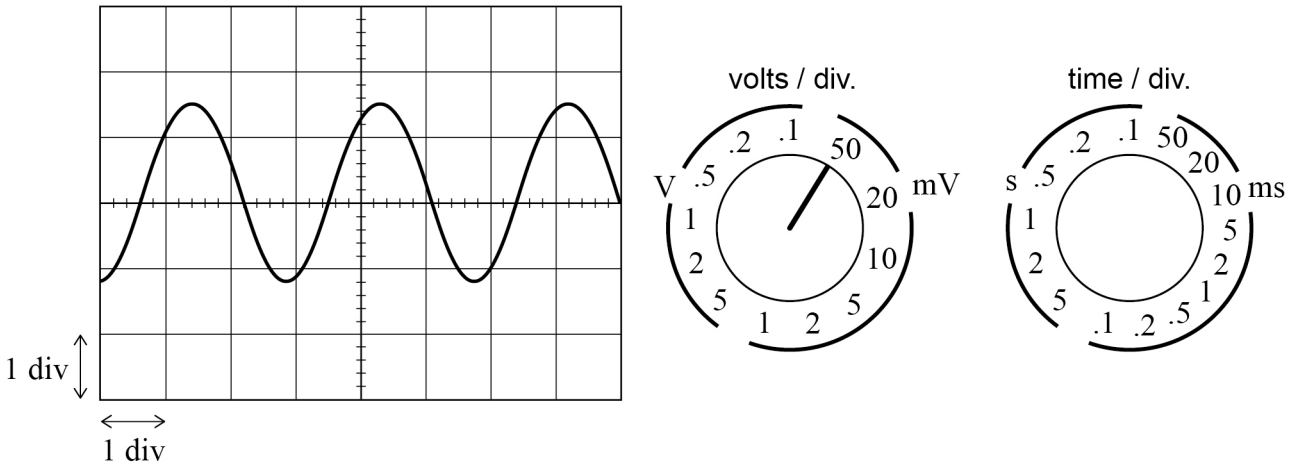

0 5 . 2 Determine the peak value of the voltage shown in **Figure 10**.

[3 marks]

peak value = _____ mV

The spring has a stiffness of $29.3\ \mathrm{N\ m^{-1}}$.
The mass m of **P** is $250\ \mathrm{g}$.

0 5 . 3 Determine the time-base setting on the oscilloscope.
State the unit for this time-base setting.

[3 marks]

time-base = _____ unit _____

Do not write outside the box

0 5 . 4 **P** has a magnetic flux density of B at its poles.

P is replaced with magnet **Q** that has:
- a mass of $2m$
- a magnetic flux density of $2B$ at its poles.

The height of the spring is adjusted so that the centre of mass of **Q** is initially at **O** as in **Figure 9**.
Q is then pulled down by the same distance y and released.
The settings on the oscilloscope are **not** changed.

Figure 11 shows the oscilloscope screen as **Q** oscillates about **O**.

Figure 11

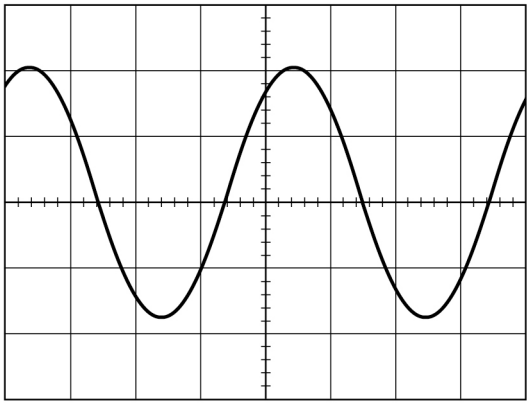

Explain the differences between the trace in **Figure 11** and the trace in **Figure 10**.
Support your answer with calculations.

[4 marks]

Question 5 continues on the next page

Do not write outside the box

0 5 . 5 After several oscillations, **Q** comes to rest.

The oscilloscope acts like a high-resistance voltmeter.

The oscilloscope is replaced with an ammeter that is connected across the coil.
Q is pulled down by the same distance y and released.

Explain the effect of replacing the oscilloscope with the ammeter on the time taken for **Q** to come to rest.

[4 marks]

16

Do not write outside the box

0 6 Stone pillars are used in buildings.

A stone pillar is initially flat on the ground. **Figure 12** shows how a steel cable and a frictionless pulley are used to raise the pillar to a vertical position.
As the pillar is raised, it pivots about point **P**.

Figure 12

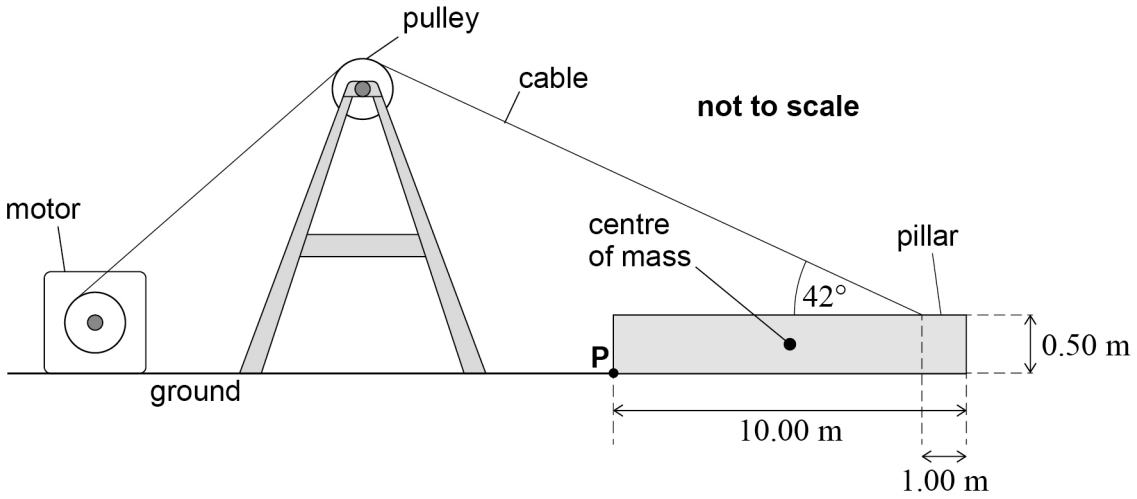

The pillar is of uniform cross-section and has a length of 10.00 m and a thickness of 0.50 m.
The cable is attached to the pillar at a distance of 1.00 m from its right-hand edge.

0 6 . 1 Explain why the horizontal component of the tension in the cable has a moment about **P**.

[1 mark]

The minimum tension needed so that the pillar pivots about **P** is 74 kN.
The pillar is of uniform density.

0 6 . 2 Calculate the weight of the pillar.
Assume that all of the forces are coplanar.

[3 marks]

weight = _____ N

Question 6 continues on the next page

Do not write outside the box

A motor pulls the cable and raises the pillar.

Figure 13 shows the pillar when its centre of mass is directly above **P**. The cable is now horizontal.

Figure 13

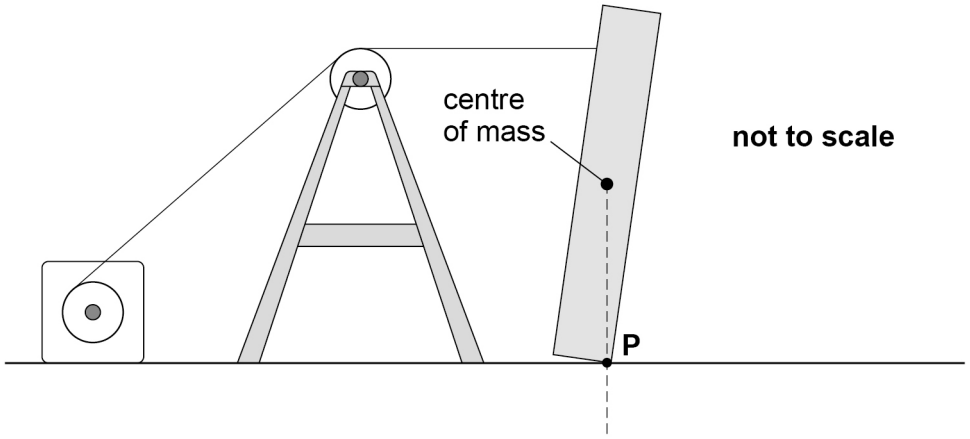

0 6 . 3 The output power of the motor varies as the pillar is lifted slowly from its initial position to the position shown in **Figure 13**. The motor rotates with a constant angular speed.

State and explain the changes in the output power as the pillar is lifted.

[4 marks]

Do not write outside the box

A different pillar **B** has the same dimensions as the original pillar but has a greater weight.
When the system is used to raise **B**, the maximum tension in the cable is 85 kN.

0 6 . 4 The breaking stress of the cable is 699 MPa.
For safety reasons, the maximum stress in the cable must not exceed 20% of the breaking stress.

Calculate the minimum diameter of cable required to raise **B** safely.

[3 marks]

minimum diameter = _____ m

Question 6 continues on the next page

Do not write outside the box

The motor is attached to a cylinder which winds the cable to raise **B**.

Figure 14 shows the cylinder attached to the cable.

Figure 14

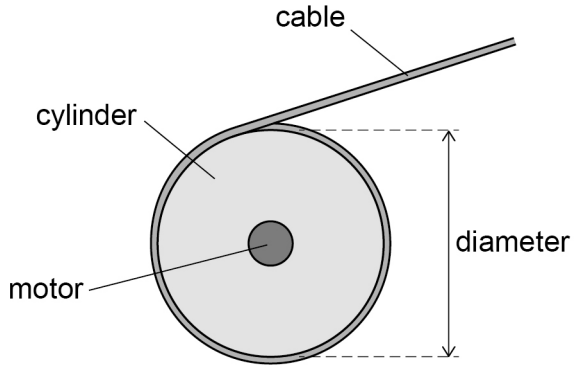

The maximum torque produced by the motor is 8.88×10^3 N m.

0 6 . 5 Calculate the minimum diameter of cylinder required to raise **B**.
Ignore the diameter of the cable in your calculation.

[2 marks]

diameter = _____ m

Do not write outside the box

0 6 . 6 When the motor is producing its maximum torque:

- the cylinder rotates with an angular speed of $0.075\ \text{rad s}^{-1}$
- the voltage across the motor is $240\ \text{V}$
- the current in the motor is $3.9\ \text{A}$.

Calculate the percentage efficiency of the motor when delivering maximum torque to raise **B**.

[3 marks]

efficiency = _____ %

16

END OF QUESTIONS

Do not write outside the box

There are no questions printed on this page

DO NOT WRITE ON THIS PAGE
ANSWER IN THE SPACES PROVIDED

Do not write outside the box

Question number	**Additional page, if required.** **Write the question numbers in the left-hand margin.**

Do not write outside the box

Question number	**Additional page, if required.** **Write the question numbers in the left-hand margin.**

Copyright information

For confidentiality purposes, all acknowledgements of third-party copyright material are published in a separate booklet. This booklet is published after each live examination series and is available for free download from www.oxfordaqa.com

Permission to reproduce all copyright material has been applied for. In some cases, efforts to contact copyright-holders may have been unsuccessful and OxfordAQA will be happy to rectify any omissions of acknowledgements. If you have any queries please contact the Copyright Team.

Copyright © 2025 OxfordAQA International Examinations and its licensors. All rights reserved.