OCR
Oxford Cambridge and RSA

Tuesday 20 June 2023 – Afternoon

A Level Mathematics A

H240/03 Pure Mathematics and Mechanics

Time allowed: 2 hours

You must have:
- the Printed Answer Booklet
- a scientific or graphical calculator

QP

INSTRUCTIONS
- Use black ink. You can use an HB pencil, but only for graphs and diagrams.
- Write your answer to each question in the space provided in the **Printed Answer Booklet**. If you need extra space use the lined pages at the end of the Printed Answer Booklet. The question numbers must be clearly shown.
- Fill in the boxes on the front of the Printed Answer Booklet.
- Answer **all** the questions.
- Where appropriate, your answer should be supported with working. Marks might be given for using a correct method, even if your answer is wrong.
- Give non-exact numerical answers correct to **3** significant figures unless a different degree of accuracy is specified in the question.
- The acceleration due to gravity is denoted by $g\,\mathrm{m\,s^{-2}}$. When a numerical value is needed use $g = 9.8$ unless a different value is specified in the question.
- Do **not** send this Question Paper for marking. Keep it in the centre or recycle it.

INFORMATION
- The total mark for this paper is **100**.
- The marks for each question are shown in brackets **[ ]**.
- This document has **12** pages.

ADVICE
- Read each question carefully before you start your answer.

© OCR 2023 [603/1038/8]
DC (CJ/CT) 324586/3
OCR is an exempt Charity

Formulae
A Level Mathematics A (H240)

Arithmetic series

$S_n = \frac{1}{2}n(a+l) = \frac{1}{2}n\{2a+(n-1)d\}$

Geometric series

$$S_n = \frac{a(1-r^n)}{1-r}$$

$$S_\infty = \frac{a}{1-r} \quad \text{for } |r| < 1$$

Binomial series

$$(a+b)^n = a^n + {}^n\mathrm{C}_1 a^{n-1}b + {}^n\mathrm{C}_2 a^{n-2}b^2 + \ldots + {}^n\mathrm{C}_r a^{n-r}b^r + \ldots + b^n \qquad (n \in \mathbb{N}),$$

where ${}^n\mathrm{C}_r = {}_n\mathrm{C}_r = \binom{n}{r} = \frac{n!}{r!(n-r)!}$

$$(1+x)^n = 1 + nx + \frac{n(n-1)}{2!}x^2 + \ldots + \frac{n(n-1)\ldots(n-r+1)}{r!}x^r + \ldots \qquad (|x| < 1,\ n \in \mathbb{R})$$

Differentiation

$\mathrm{f}(x)$	$\mathrm{f}'(x)$
$\tan kx$	$k\sec^2 kx$
$\sec x$	$\sec x \tan x$
$\cot x$	$-\mathrm{cosec}^2 x$
$\mathrm{cosec}\, x$	$-\mathrm{cosec}\, x \cot x$

Quotient rule $y = \frac{u}{v}$, $\frac{\mathrm{d}y}{\mathrm{d}x} = \frac{v\frac{\mathrm{d}u}{\mathrm{d}x} - u\frac{\mathrm{d}v}{\mathrm{d}x}}{v^2}$

Differentiation from first principles

$$\mathrm{f}'(x) = \lim_{h \to 0} \frac{\mathrm{f}(x+h) - \mathrm{f}(x)}{h}$$

Integration

$$\int \frac{\mathrm{f}'(x)}{\mathrm{f}(x)}\,\mathrm{d}x = \ln|\mathrm{f}(x)| + c$$

$$\int \mathrm{f}'(x)\big(\mathrm{f}(x)\big)^n\,\mathrm{d}x = \frac{1}{n+1}\big(\mathrm{f}(x)\big)^{n+1} + c$$

Integration by parts $\int u\frac{\mathrm{d}v}{\mathrm{d}x}\,\mathrm{d}x = uv - \int v\frac{\mathrm{d}u}{\mathrm{d}x}\,\mathrm{d}x$

Small angle approximations

$\sin\theta \approx \theta$, $\cos\theta \approx 1 - \frac{1}{2}\theta^2$, $\tan\theta \approx \theta$ where θ is measured in radians

© OCR 2023

Trigonometric identities

$\sin(A \pm B) = \sin A \cos B \pm \cos A \sin B$

$\cos(A \pm B) = \cos A \cos B \mp \sin A \sin B$

$\tan(A \pm B) = \dfrac{\tan A \pm \tan B}{1 \mp \tan A \tan B} \qquad \left(A \pm B \neq (k + \tfrac{1}{2})\pi\right)$

Numerical methods

Trapezium rule: $\int_a^b y\,\mathrm{d}x \approx \frac{1}{2}h\{(y_0 + y_n) + 2(y_1 + y_2 + \ldots + y_{n-1})\}$, where $h = \dfrac{b-a}{n}$

The Newton-Raphson iteration for solving $\mathrm{f}(x) = 0$: $x_{n+1} = x_n - \dfrac{\mathrm{f}(x_n)}{\mathrm{f}'(x_n)}$

Probability

$\mathrm{P}(A \cup B) = \mathrm{P}(A) + \mathrm{P}(B) - \mathrm{P}(A \cap B)$

$\mathrm{P}(A \cap B) = \mathrm{P}(A)\mathrm{P}(B \mid A) = \mathrm{P}(B)\mathrm{P}(A \mid B)$ **or** $\mathrm{P}(A \mid B) = \dfrac{\mathrm{P}(A \cap B)}{\mathrm{P}(B)}$

Standard deviation

$\sqrt{\dfrac{\Sigma(x-\bar{x})^2}{n}} = \sqrt{\dfrac{\Sigma x^2}{n} - \bar{x}^2}$ **or** $\sqrt{\dfrac{\Sigma f(x-\bar{x})^2}{\Sigma f}} = \sqrt{\dfrac{\Sigma f x^2}{\Sigma f} - \bar{x}^2}$

The binomial distribution

If $X \sim \mathrm{B}(n, p)$ then $\mathrm{P}(X = x) = \binom{n}{x} p^x (1-p)^{n-x}$, mean of X is np, variance of X is $np(1-p)$

Hypothesis test for the mean of a normal distribution

If $X \sim \mathrm{N}(\mu, \sigma^2)$ then $\bar{X} \sim \mathrm{N}\left(\mu, \dfrac{\sigma^2}{n}\right)$ and $\dfrac{\bar{X} - \mu}{\sigma / \sqrt{n}} \sim \mathrm{N}(0, 1)$

Percentage points of the normal distribution

If Z has a normal distribution with mean 0 and variance 1 then, for each value of p, the table gives the value of z such that $\mathrm{P}(Z \leqslant z) = p$.

p	0.75	0.90	0.95	0.975	0.99	0.995	0.9975	0.999	0.9995
z	0.674	1.282	1.645	1.960	2.326	2.576	2.807	3.090	3.291

Kinematics

Motion in a straight line	Motion in two dimensions
$v = u + at$	$\mathbf{v} = \mathbf{u} + \mathbf{a}t$
$s = ut + \frac{1}{2}at^2$	$\mathbf{s} = \mathbf{u}t + \frac{1}{2}\mathbf{a}t^2$
$s = \frac{1}{2}(u + v)t$	$\mathbf{s} = \frac{1}{2}(\mathbf{u} + \mathbf{v})t$
$v^2 = u^2 + 2as$	
$s = vt - \frac{1}{2}at^2$	$\mathbf{s} = \mathbf{v}t - \frac{1}{2}\mathbf{a}t^2$

Section A
Pure Mathematics

1 Using logarithms, solve the equation

$$4^{2x+1} = 5^x,$$

giving your answer correct to **3** significant figures. **[3]**

2 **(a)** Express $3\sin x - 4\cos x$ in the form $R\sin(x-\alpha)$, where $R > 0$ and $0° < \alpha < 90°$. Give the value of α correct to **4** significant figures. **[3]**

(b) Hence solve the equation $3\sin x - 4\cos x = 2$ for $0° < x < 90°$, giving your answer correct to **3** significant figures. **[2]**

3 The cubic polynomial $\mathrm{f}(x)$ is defined by $\mathrm{f}(x) = x^3 + px + q$, where p and q are constants.

(a) **(i)** Given that $\mathrm{f}'(2) = 13$, find the value of p. **[2]**

(ii) Given also that $(x-2)$ is a factor of $\mathrm{f}(x)$, find the value of q. **[2]**

The curve $y = \mathrm{f}(x)$ is translated by the vector $\begin{pmatrix} 2 \\ -3 \end{pmatrix}$.

(b) Using the values from part **(a)**, determine the equation of the curve after it has been translated. Give your answer in the form $y = x^3 + ax^2 + bx + c$, where a, b and c are integers to be found. **[4]**

4 A circle C has equation $x^2 + y^2 - 6x + 10y + k = 0$.

(a) Find the set of possible values of k. **[2]**

(b) It is given that $k = -46$.

Determine the coordinates of the **two** points on C at which the gradient of the tangent is $\frac{1}{2}$. **[5]**

5 A mathematics department is designing a new emblem to place on the walls outside its classrooms. The design for the emblem is shown in the diagram below.

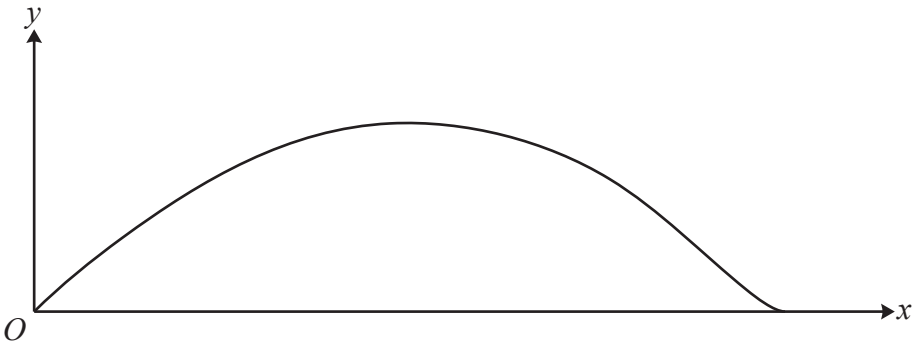

The emblem is modelled by the region between the x-axis and the curve with parametric equations

$x = 1 + 0.2t - \cos t, \qquad y = k\sin^2 t,$

where k is a positive constant and $0 \leqslant t \leqslant \pi$.

Lengths are in metres and the area of the emblem must be $1\,\text{m}^2$.

(a) Show that $k\int_0^{\pi}(0.2 + \sin t - 0.2\cos^2 t - \sin t\cos^2 t)\,\mathrm{d}t = 1$. **[3]**

(b) Determine the exact value of k. **[6]**

6 The first, third and fourth terms of an arithmetic progression are u_1, u_3 and u_4 respectively, where

$u_1 = 2\sin\theta, \qquad u_3 = -\sqrt{3}\cos\theta, \qquad u_4 = \frac{7}{2}\sin\theta,$

and $\frac{1}{2}\pi < \theta < \pi$.

(a) Determine the exact value of θ. **[3]**

(b) Hence determine the value of $\sum_{r=1}^{100} u_r$. **[3]**

7 A car C is moving horizontally in a straight line with velocity $v\,\mathrm{m\,s^{-1}}$ at time t seconds, where $v > 0$ and $t \geqslant 0$. The acceleration, $a\,\mathrm{m\,s^{-2}}$, of C is modelled by the equation

$$a = v\left(\frac{8t}{7+4t^2} - \frac{1}{2}\right).$$

(a) **In this question you must show detailed reasoning.**

Find the times when the acceleration of C is zero. **[3]**

At $t = 0$ the velocity of C is $17.5\,\mathrm{m\,s^{-1}}$ and at $t = T$ the velocity of C is $5\,\mathrm{m\,s^{-1}}$.

(b) By setting up and solving a differential equation, show that T satisfies the equation

$$T = 2\ln\left(\frac{7+4T^2}{2}\right).$$ **[6]**

(c) Use an iterative formula, based on the equation in part **(b)**, to find the value of T, giving your answer correct to **4** significant figures. Use an initial value of 11.25 and show the result of each step of the iteration process. **[2]**

(d) The diagram below shows the velocity-time graph for the motion of C.

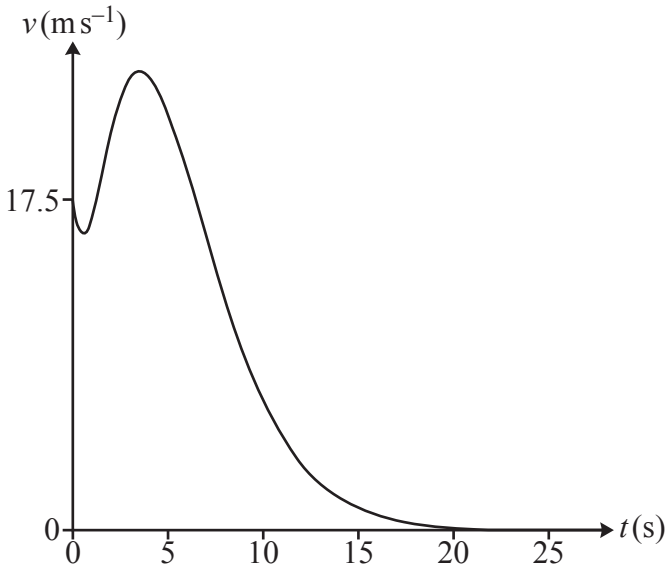

Find the time taken for C to decelerate from travelling at its maximum speed until it is travelling at $5\,\mathrm{m\,s^{-1}}$. **[1]**

Section B
Mechanics

8 A particle P moves with constant acceleration $(3\mathbf{i}-2\mathbf{j})\,\mathrm{m\,s^{-2}}$. At time $t = 4$ seconds, P has velocity $6\mathbf{i}\,\mathrm{m\,s^{-1}}$.

Determine the speed of P at time $t = 0$ seconds. **[4]**

9

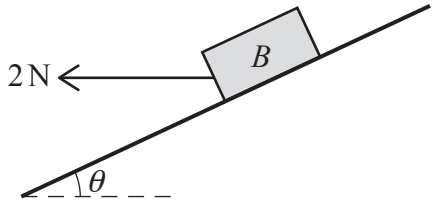

A block B of weight 10 N lies at rest in equilibrium on a rough plane inclined at θ to the horizontal. A horizontal force of magnitude 2 N, acting above a line of greatest slope, is applied to B (see diagram).

(a) Complete the diagram in the Printed Answer Booklet to show all the forces acting on B. **[1]**

It is given that B remains at rest and the coefficient of friction between B and the plane is 0.8.

(b) Determine the greatest possible value of $\tan\theta$. **[5]**

10 A particle P of mass m kg is moving on a smooth horizontal surface under the action of two constant horizontal forces $(-4\mathbf{i}+2\mathbf{j})$ N and $(a\mathbf{i}+b\mathbf{j})$ N. The resultant of these two forces is $\mathbf{R}$ N. It is given that $\mathbf{R}$ acts in a direction which is parallel to the vector $-\mathbf{i}+3\mathbf{j}$.

(a) Show that $3a+b = 10$. **[3]**

It is given that $a = 6$ and that P moves with an acceleration of magnitude $5\sqrt{10}\,\mathrm{m\,s^{-2}}$.

(b) Determine the value of m. **[4]**

11

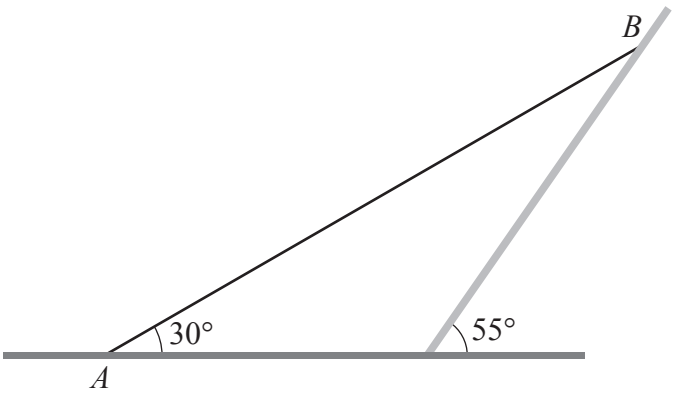

A uniform rod AB, of weight 20 N and length 2.8 m, rests in equilibrium with the end A in contact with rough horizontal ground and the end B resting against a smooth wall inclined at 55° to the horizontal. The rod, which rests in a vertical plane that is perpendicular to the wall, is inclined at 30° to the horizontal (see diagram).

(a) Show that the magnitude of the force acting on the rod at B is 9.56 N, correct to **3** significant figures. **[3]**

(b) Determine the magnitude of the contact force between the rod and the ground. Give your answer correct to **3** significant figures. **[5]**

12 In this question you should take the acceleration due to gravity to be $10\,\mathrm{m\,s^{-2}}$.

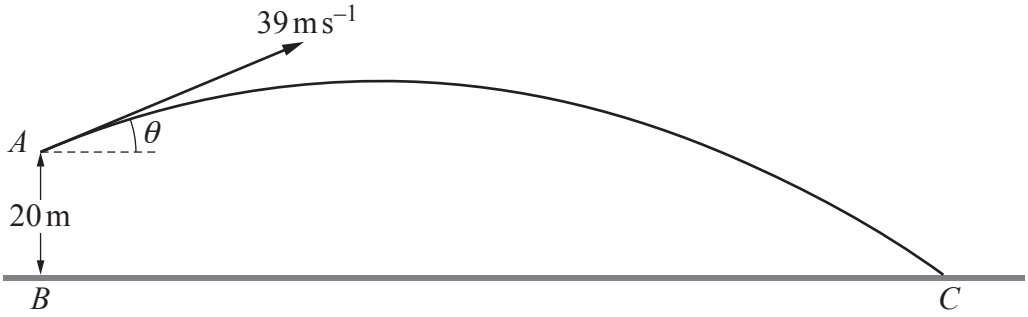

A small ball P is projected from a point A with speed $39\,\mathrm{m\,s^{-1}}$ at an angle of elevation θ, where $\sin\theta = \frac{5}{13}$ and $\cos\theta = \frac{12}{13}$. Point A is 20 m vertically above a point B on horizontal ground. The ball first lands at a point C on the horizontal ground (see diagram).

The ball P is modelled as a particle moving freely under gravity.

(a) Find the maximum height of P above the ground during its motion. **[3]**

The time taken for P to travel from A to C is T seconds.

(b) Determine the value of T. **[3]**

(c) State **one** limitation of the model, other than air resistance or the wind, that could affect the answer to part **(b)**. **[1]**

At the instant that P is projected, a second small ball Q is released from rest at B and moves towards C along the horizontal ground.

At time t seconds, where $t \geqslant 0$, the velocity $v\,\mathrm{m\,s^{-1}}$ of Q is given by

$$v = kt^3 + 6t^2 + \tfrac{3}{2}t,$$

where k is a positive constant.

(d) Given that P and Q collide at C, determine the acceleration of Q immediately before this collision. **[6]**

13

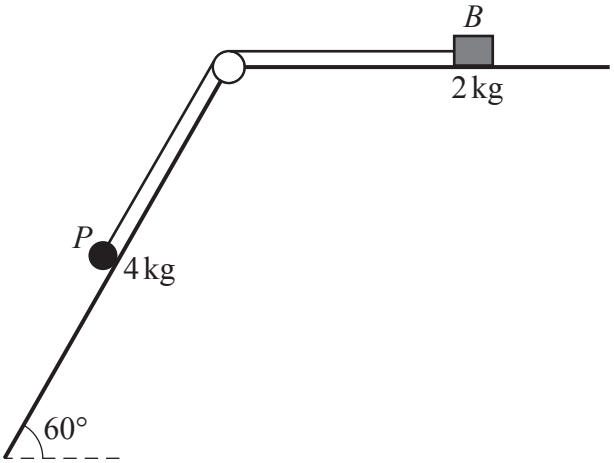

The diagram shows a small block B, of mass 2 kg, and a particle P, of mass 4 kg, which are attached to the ends of a light inextensible string. The string is taut and passes over a small smooth pulley fixed at the intersection of a horizontal surface and an inclined plane. The particle can move on the inclined plane, which is rough, and which makes an angle of 60° with the horizontal. The block can move on the horizontal surface, which is also rough.

The system is released from rest, and in the subsequent motion P moves down the plane and B does not reach the pulley.

It is given that the coefficient of friction between P and the inclined plane is twice the coefficient of friction between B and the horizontal surface.

(a) Determine, in terms of g, the tension in the string. **[7]**

When P is moving at $2\,\text{m}\,\text{s}^{-1}$ the string breaks. In the 0.5 seconds after the string breaks P moves 1.9 m down the plane.

(b) Determine the deceleration of B after the string breaks. Give your answer correct to **3** significant figures. **[5]**

END OF QUESTION PAPER

BLANK PAGE

OCR
Oxford Cambridge and RSA

Copyright Information

OCR is committed to seeking permission to reproduce all third-party content that it uses in its assessment materials. OCR has attempted to identify and contact all copyright holders whose work is used in this paper. To avoid the issue of disclosure of answer-related information to candidates, all copyright acknowledgements are reproduced in the OCR Copyright Acknowledgements Booklet. This is produced for each series of examinations and is freely available to download from our public website (www.ocr.org.uk) after the live examination series.

If OCR has unwittingly failed to correctly acknowledge or clear any third-party content in this assessment material, OCR will be happy to correct its mistake at the earliest possible opportunity.

For queries or further information please contact The OCR Copyright Team, The Triangle Building, Shaftesbury Road, Cambridge CB2 8EA.

OCR is part of Cambridge University Press & Assessment, which is itself a department of the University of Cambridge.

© OCR 2023