Please check the examination details below before entering your candidate information

Candidate surname	Other names

Centre Number | Candidate Number

Pearson Edexcel Level 1/Level 2 GCSE (9–1)

Thursday 22 May 2025

Morning (Time: 1 hour 45 minutes)

Paper reference **1PH0/1F**

Physics
PAPER 1

Foundation Tier

You must have:
Calculator, ruler, Equation Booklet (enclosed)

Total Marks

Instructions

- Use **black** ink or ball-point pen.
- **Fill in the boxes** at the top of this page with your name, centre number and candidate number.
- Answer **all** questions.
- Answer the questions in the spaces provided – *there may be more space than you need.*

Information

- The total mark for this paper is 100.
- The marks for **each** question are shown in brackets – *use this as a guide as to how much time to spend on each question.*
- In questions marked with an **asterisk (*)**, marks will be awarded for your ability to structure your answer logically, showing how the points that you make are related or follow on from each other where appropriate.

Advice

- Read each question carefully before you start to answer it.
- Try to answer every question.
- Check your answers if you have time at the end.

Turn over

©2025 Pearson Education Ltd.
Y:1/1/1/1/1/1/1/1/1/1/1/1/

P 7 8 7 2 7 R A 0 1 3 6

Pearson

Answer ALL questions. Write your answers in the spaces provided.

Some questions must be answered with a cross in one of the four boxes ☒. If you change your mind about an answer, put a line through the box ☒ and then mark your new answer with a cross ☒.

1 (a) Figure 1 shows a ray of light incident on a mirror.

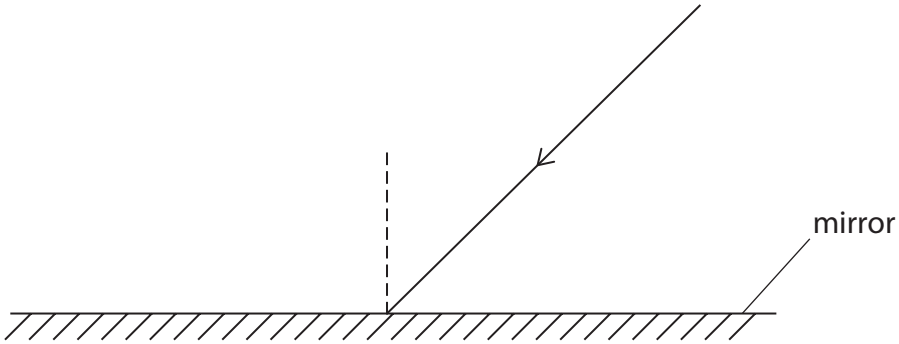

Figure 1

(i) Draw the reflected ray on Figure 1.

(1)

(ii) On Figure 1, label the angle of incidence with the letter **i** and the angle of reflection with the letter **r**.

(2)

DO NOT WRITE IN THIS AREA
DO NOT WRITE IN THIS AREA
DO NOT WRITE IN THIS AREA

(b) A lens has a focal length of 17 cm.

Calculate the power of the lens in dioptres.

Use the equation

$$\text{power (in dioptres)} = \frac{1}{\text{focal length (in metres)}}$$

(3)

power = ... dioptres

(c) Which of these is the best reason for explaining why a leaf appears green in daylight?

(1)

☒ **A** the leaf absorbs green light only

☒ **B** the leaf absorbs yellow and blue light only

☒ **C** the leaf reflects green light only

☒ **D** the leaf reflects yellow and blue light only

(Total for Question 1 = 7 marks)

DO NOT WRITE IN THIS AREA
DO NOT WRITE IN THIS AREA
DO NOT WRITE IN THIS AREA

BLANK PAGE

DO NOT WRITE IN THIS AREA
DO NOT WRITE IN THIS AREA
DO NOT WRITE IN THIS AREA

DO NOT WRITE IN THIS AREA
DO NOT WRITE IN THIS AREA
DO NOT WRITE IN THIS AREA

2 (a) Draw **one** straight line from each electromagnetic radiation to its correct description.

(3)

electromagnetic radiation	**description**
infrared	used in night vision cameras
gamma	the least dangerous radiation
ultraviolet	may damage eyes, so sunglasses worn as protection
radio waves	the most dangerous radiation

(b) Different colours of light have different frequencies.

Which of these colours has the highest frequency?

(1)

☐ **A** blue

☐ **B** green

☐ **C** red

☐ **D** yellow

(c) Figure 2 is a diagram of a glass block being used to investigate the refraction of light.

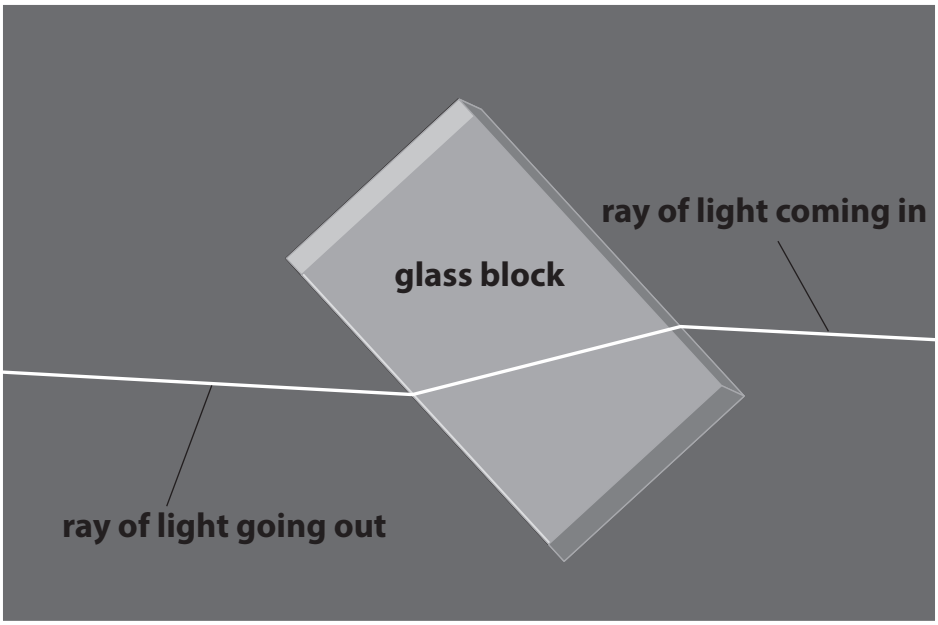

(Source: © ajizai/docstoc.com)

Figure 2

The angle of incidence was varied and the angle of refraction was measured each time.

Figure 3 shows the results in a table.

angle of incidence in degrees	angle of refraction in degrees
20	13
30	20
40	25
50	31
60	35
70	39
80	41

Figure 3

DO NOT WRITE IN THIS AREA
DO NOT WRITE IN THIS AREA
DO NOT WRITE IN THIS AREA

Figure 4 shows a graph of these results.

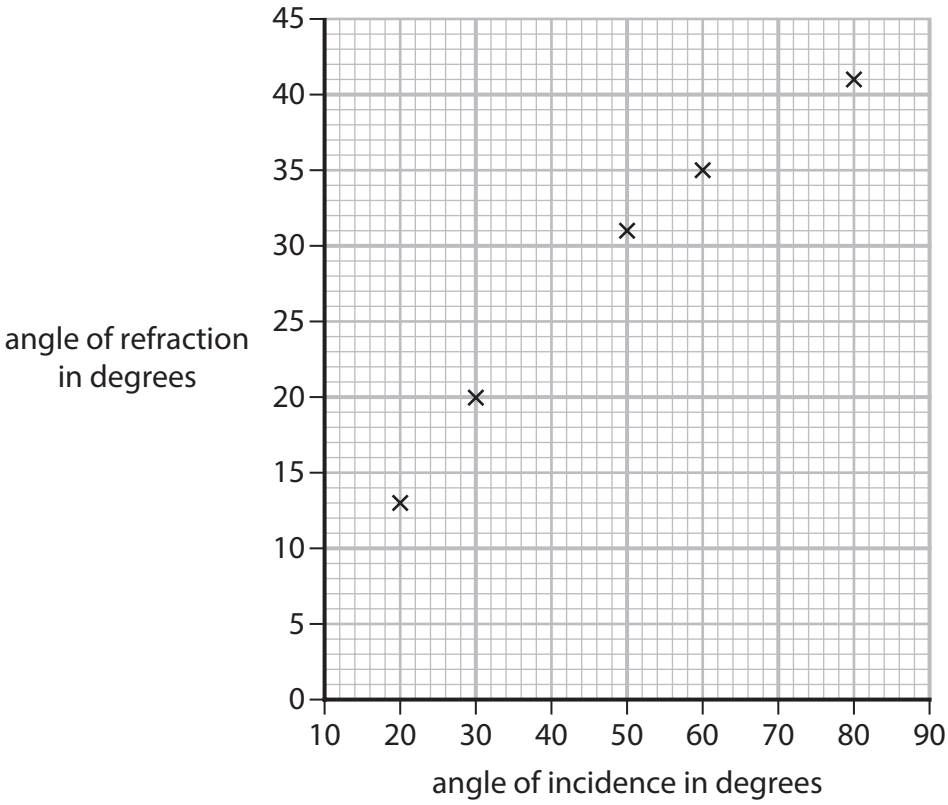

Figure 4

(i) The two shaded rows in Figure 3 are not plotted on the graph in Figure 4.

Plot these missing results on the graph in Figure 4.

(2)

(ii) Draw a curve of best fit through the points on the graph in Figure 4.

(1)

(iii) Using Figure 4, describe the relationship between the angle of refraction and the angle of incidence.

(2)

.....

.....

.....

.....

(Total for Question 2 = 9 marks)

DO NOT WRITE IN THIS AREA
DO NOT WRITE IN THIS AREA
DO NOT WRITE IN THIS AREA

3 Figure 5 shows a velocity / time graph for a car moving on a test track.

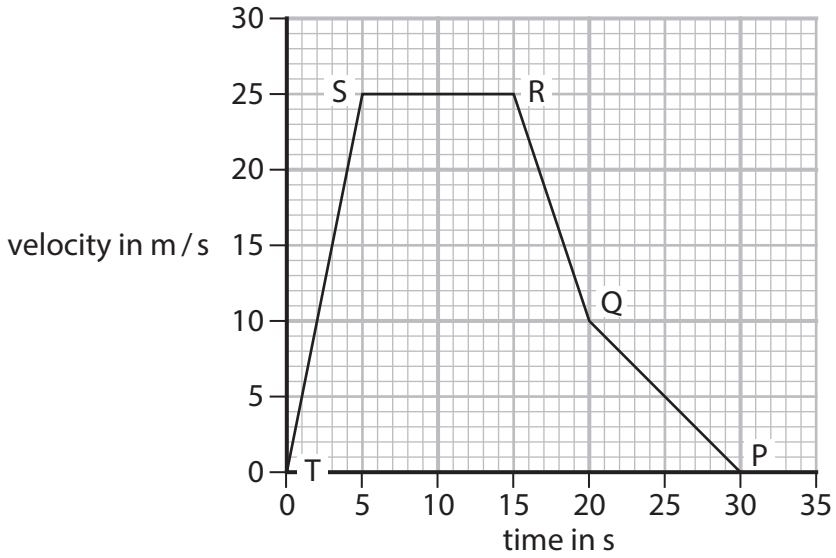

Figure 5

(a) (i) Use this graph to describe the velocity of the car in stages TS, SR and RQ.

(3)

TS

.....

.....

SR

.....

.....

RQ

.....

.....

(ii) State how the motion of the car is different in RQ compared with QP.

(1)

.....

.....

DO NOT WRITE IN THIS AREA
DO NOT WRITE IN THIS AREA
DO NOT WRITE IN THIS AREA

(b) (i) Calculate the acceleration of the car in Figure 5 in the first 5 s.

Use the equation

$$\text{acceleration} = \frac{\text{change in velocity}}{\text{time taken}}$$

(2)

acceleration = ... m / s^2

(ii) Calculate the distance travelled by the car in Figure 5 from 5 s to 15 s.

(2)

distance = ... m

(Total for Question 3 = 8 marks)

DO NOT WRITE IN THIS AREA
DO NOT WRITE IN THIS AREA
DO NOT WRITE IN THIS AREA

4 (a) Figure 6 shows a diagram of a helium atom.

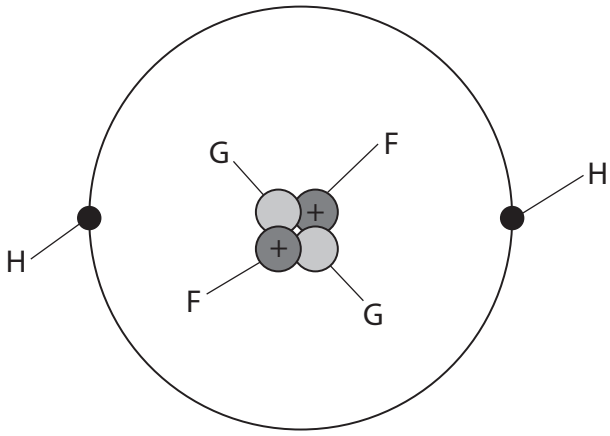

Figure 6

Complete the table for particles G and H, as shown in Figure 6.

(4)

particle	name of particle	charge
F	proton	positive
G		
H		

(b) An atom of beryllium has the symbol

$$^{9}_{4}\text{Be}$$

The beryllium atom has 4 protons.

(i) Determine the number of neutrons in this atom.

(1)

number of neutrons .....

(ii) Determine the number of electrons in this atom.

(1)

number of electrons .....

DO NOT WRITE IN THIS AREA
DO NOT WRITE IN THIS AREA
DO NOT WRITE IN THIS AREA

(c) (i) Which of these is the unit for the activity of a radioactive isotope?

(1)

☒ **A** second (s)

☒ **B** kilogram (kg)

☒ **C** kelvin (K)

☒ **D** becquerel (Bq)

(ii) The isotope nitrogen-13 (N-13) has a half-life of 10 minutes.

A sample of N-13 has an initial mass of 120 g.

Calculate the mass of N-13 that remains after 30 minutes.

(2)

mass remaining = ... g

(Total for Question 4 = 9 marks)

DO NOT WRITE IN THIS AREA
DO NOT WRITE IN THIS AREA
DO NOT WRITE IN THIS AREA

5 (a) Which of these is a typical human reaction time?

(1)

☒ **A** 0.0027 s

☒ **B** 0.027 s

☒ **C** 0.27 s

☒ **D** 2.7 s

(b) There are several factors that affect the overall stopping distance of a van.

State **two** factors that may affect the overall stopping distance of a van.

(2)

1 .....

.....

2 .....

.....

(c) Figure 7 is a velocity / time graph for a van braking from an initial velocity of 25 m / s.

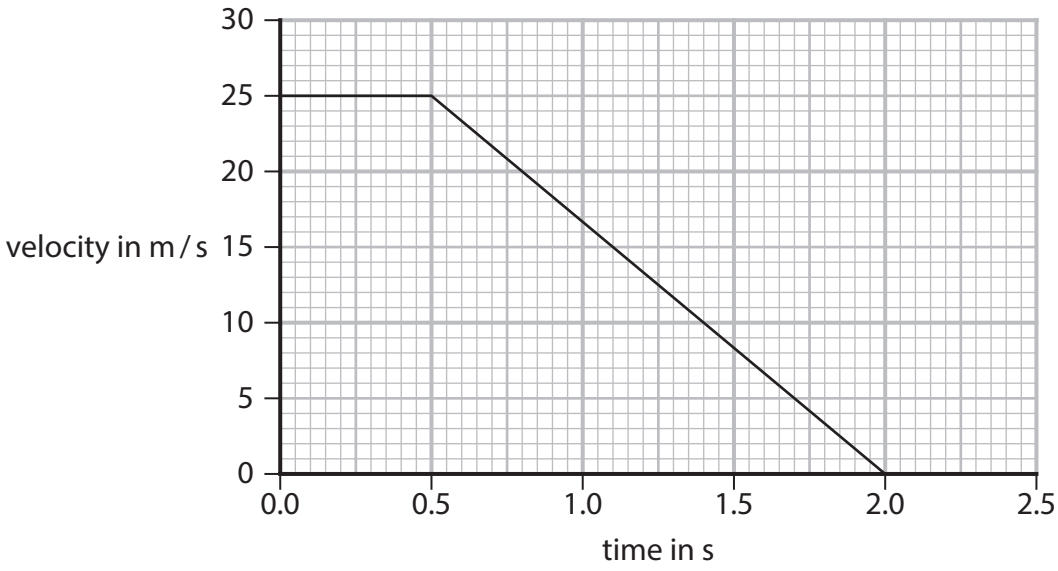

Figure 7

(i) On Figure 7 draw a similar graph for the same van braking from an initial velocity of 15 m / s.

Assume the thinking time and the braking force remain the same.

(2)

DO NOT WRITE IN THIS AREA
DO NOT WRITE IN THIS AREA
DO NOT WRITE IN THIS AREA

(ii) The van's brakes are applied to stop a van in a distance of 21.5 m.

The work done by the brakes is 375 kJ.

Calculate the braking force in newtons.

Use the equation

$$\text{force} = \frac{\text{work done}}{\text{distance travelled}}$$

(3)

braking force = ... N

(iii) The van is travelling along a horizontal road when the brakes are applied.

Which of these will have the same value as the work done by the brakes?

(1)

☒ **A** the kinetic energy of the van before braking

☒ **B** the kinetic energy of the van after braking

☒ **C** the gravitational potential energy of the van before braking

☒ **D** the gravitational potential energy of the van after braking

(Total for Question 5 = 9 marks)

DO NOT WRITE IN THIS AREA
DO NOT WRITE IN THIS AREA
DO NOT WRITE IN THIS AREA

6 (a) Figure 8 shows apparatus set up to investigate the speed of a falling object.

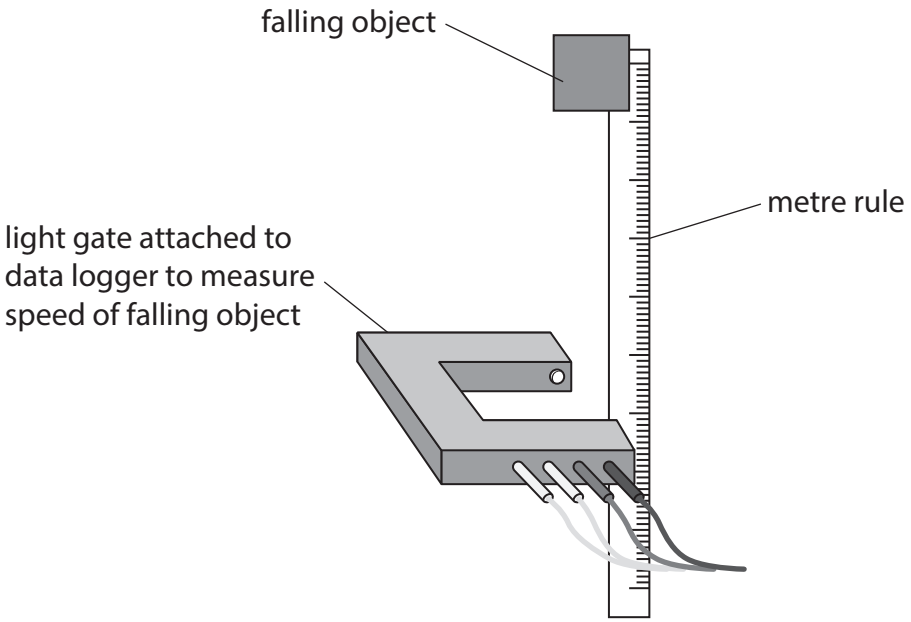

Figure 8

The object is dropped from rest at the position shown.
The object falls through the light gate.

(i) The speed of the object, after it has fallen through a height, h, is measured by the light gate.

Label Figure 8 to show the height, h.
Your label should look like this

(1)

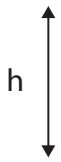

DO NOT WRITE IN THIS AREA
DO NOT WRITE IN THIS AREA
DO NOT WRITE IN THIS AREA

(ii) The speed is measured at least four times for each drop height.

Give **one** reason for repeating the measurements.

(1)

.....

.....

(iii) The metre rule shown in Figure 8 is used to measure the height, h.

Suggest **two** ways to make the measurement of h as accurate as possible.

(2)

1 .....

.....

2 .....

.....

(b) As the object in Figure 8 falls, energy is transferred.

These energy transfers are represented in Figure 9.

Complete the labels of the energy stores involved.

(3)

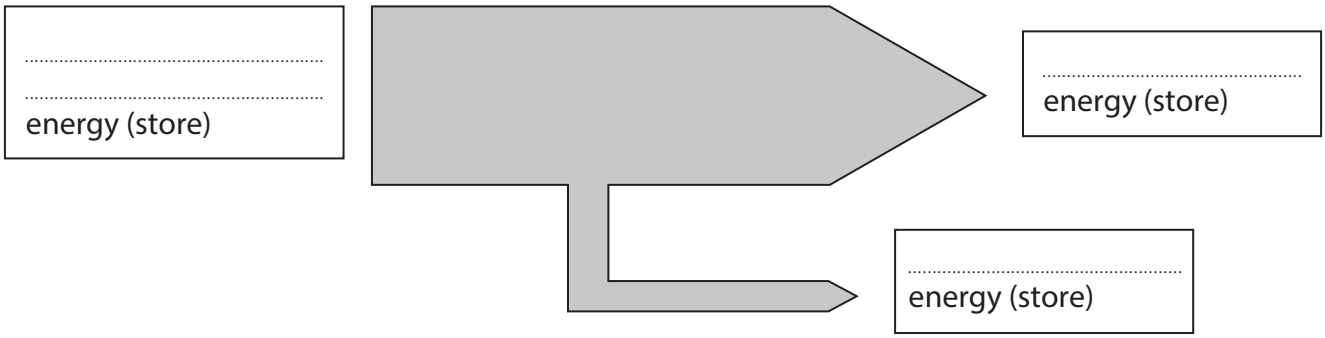

Figure 9

DO NOT WRITE IN THIS AREA
DO NOT WRITE IN THIS AREA
DO NOT WRITE IN THIS AREA

(c) Figure 10 shows wind power generation from the year 2000 onwards.

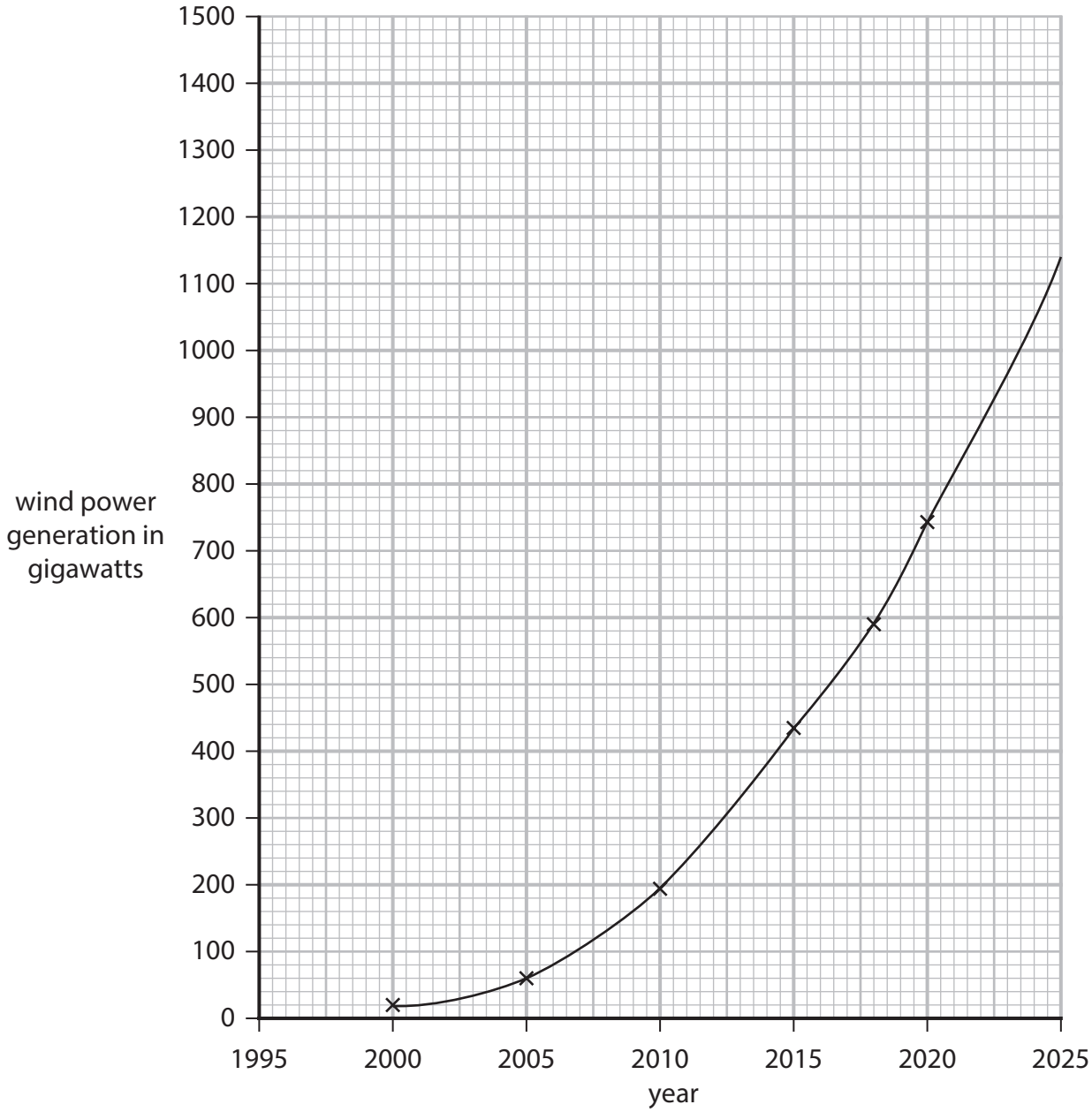

Figure 10

Estimate the percentage change in wind power generation from 2005 to 2020.

(3)

percentage change = ... %

(Total for Question 6 = 10 marks)

DO NOT WRITE IN THIS AREA
DO NOT WRITE IN THIS AREA
DO NOT WRITE IN THIS AREA

DO NOT WRITE IN THIS AREA
DO NOT WRITE IN THIS AREA
DO NOT WRITE IN THIS AREA

BLANK PAGE

7 (a) Figure 11 gives the values of gravitational field strength, g, on the surfaces of Earth, the Moon and Mars.

	value of g in N / kg
Earth	10
The Moon	1.6
Mars	3.7

Figure 11

(i) Calculate the ratio

$$\frac{\text{value of } g \text{ on Earth}}{\text{value of } g \text{ on Mars}}$$

(2)

ratio = ...

(ii) A person has a weight of 730 N on Earth.

Calculate the person's weight on the Moon, using information from Figure 11.

(2)

weight on the Moon = ... N

DO NOT WRITE IN THIS AREA
DO NOT WRITE IN THIS AREA
DO NOT WRITE IN THIS AREA

(iii) The gravitational field strength, g, is different on the surfaces of Earth, the Moon and Mars.

Explain why this is the case.

(2)

.....

.....

.....

.....

(b) Asteroids have elliptical (oval) orbits around

(1)

☒ **A** the Sun

☒ **B** the Moon

☒ **C** Mars

☒ **D** the Earth

DO NOT WRITE IN THIS AREA
DO NOT WRITE IN THIS AREA
DO NOT WRITE IN THIS AREA

*(c) Scientists have been searching beyond the Solar System to find planets where life could exist.

One requirement for life to exist on a planet is that there is water on the surface of the planet.

The planets where surface water could exist are in a region called the habitable zone.

Figure 12 is a diagram showing our Sun, with its five closest planets, and a more distant star with three of its planets labelled A, B and C.
The habitable zone is shaded.

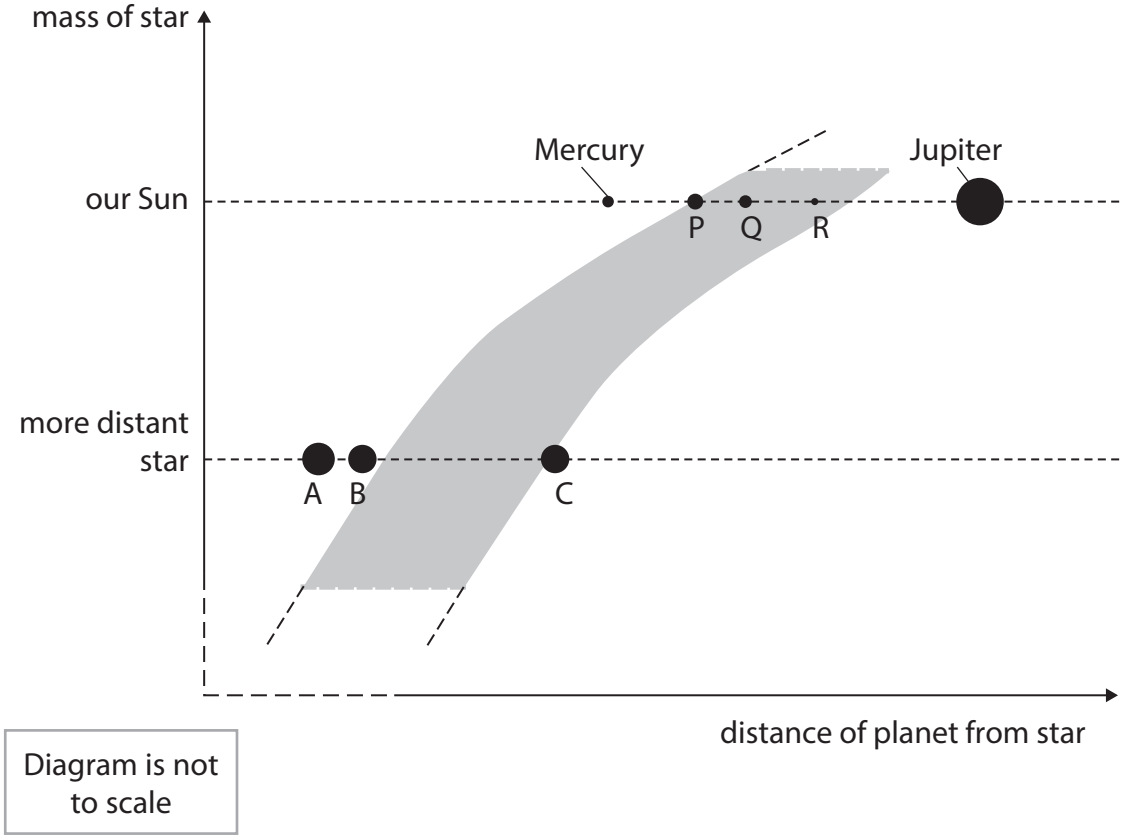

Figure 12

(Source adapted from: https://www.researchgate.net/publication/23993674_Darwin_-A_Mission_to_Detect_and_Search_for_Life_on_Extrasolar_Planets/figures?lo=1)

Discuss the chance of life existing on the planets shown in Figure 12.

Your answer should refer to

- the five planets shown from our Solar System, giving the names of P, Q and R.
- the three planets, A, B and C, orbiting the more distant star.

(6)

DO NOT WRITE IN THIS AREA
DO NOT WRITE IN THIS AREA
DO NOT WRITE IN THIS AREA

DO NOT WRITE IN THIS AREA
DO NOT WRITE IN THIS AREA
DO NOT WRITE IN THIS AREA

(Total for Question 7 = 13 marks)

8 (a) (i) Which row of the table shows the correct units of weight and of mass?

(1)

		unit of weight	unit of mass
☒	**A**	kilogram	newton
☒	**B**	newton	kilogram
☒	**C**	newton per kilogram	newton
☒	**D**	newton per kilogram	kilogram

(ii) State the name of a piece of equipment that can be used to measure mass.

(1)

.....

DO NOT WRITE IN THIS AREA
DO NOT WRITE IN THIS AREA
DO NOT WRITE IN THIS AREA

(b) Figure 13 shows the two forces acting on a beach ball as it falls through the air.



(Source: © Stepan Bormotov/Shutterstock)

Figure 13

The resultant of these two forces is 0.92 N downwards.

(i) The mass of the beach ball is 0.25 kg.

Calculate the acceleration of the beach ball as it falls.

Use the equation

$$F = m \times a$$

(3)

acceleration = ... m / s^2

(ii) Calculate the size of the air resistance force on the beach ball.

(1)

air resistance = ... N

DO NOT WRITE IN THIS AREA
DO NOT WRITE IN THIS AREA
DO NOT WRITE IN THIS AREA

(c) Some students are investigating forces.

They use a newton meter to keep a trolley stationary on a sloping runway, as shown in Figure 14.

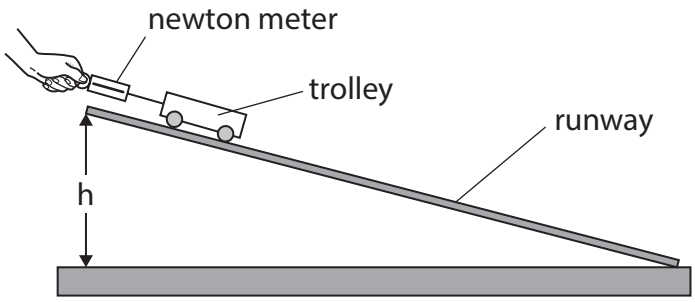

Figure 14

They measure the force needed to keep the trolley stationary on the sloping runway.

(i) They do this at four different places on the runway.

When the height, h, of the runway is 0.60 m, their four readings for force are

2.1 N 2.7 N 2.5 N 2.2 N

Calculate the mean value of these forces.

(1)

mean force = ... N

DO NOT WRITE IN THIS AREA
DO NOT WRITE IN THIS AREA
DO NOT WRITE IN THIS AREA

The students then measure values of the force, F, for several different values of h, the height of the runway.

Figure 15 is a graph of F against h.

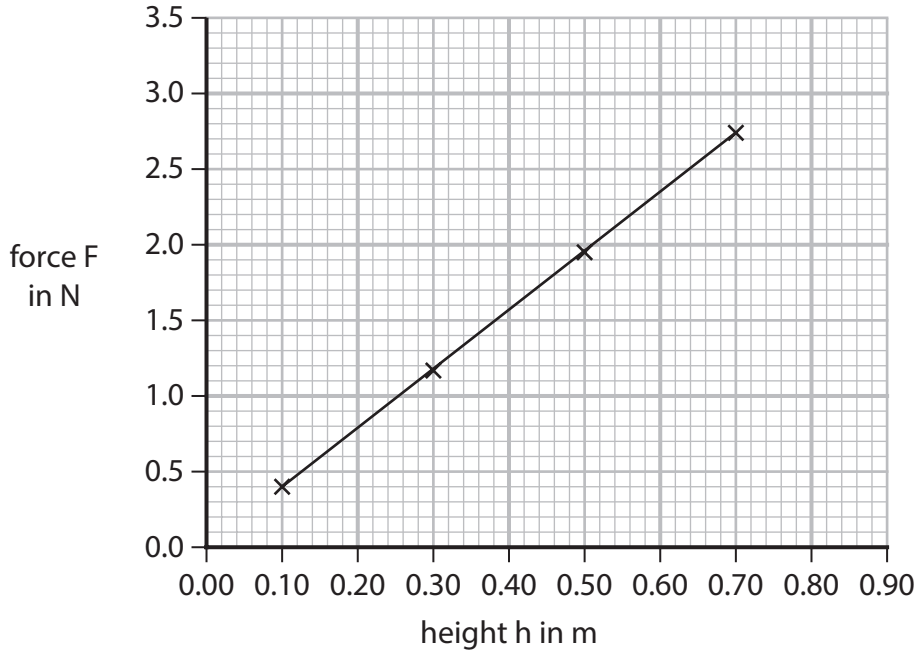

Figure 15

(ii) Use the graph in Figure 15 to determine the value of F when h = 0.80 m.

(2)

F = ... N

(iii) Determine the gradient of the graph in Figure 15.

(2)

gradient = ... N / m

(Total for Question 8 = 11 marks)

DO NOT WRITE IN THIS AREA
DO NOT WRITE IN THIS AREA
DO NOT WRITE IN THIS AREA

9 (a) Figure 16 is a diagram of part of a water wave.

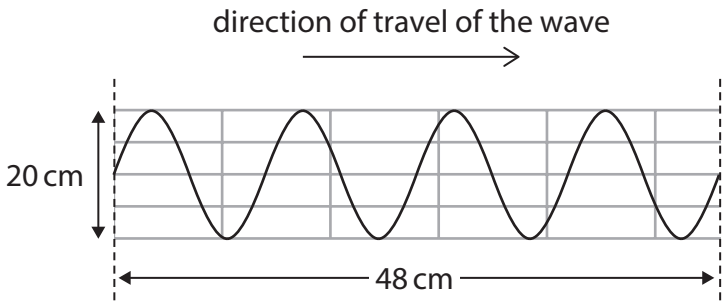

Figure 16

(i) Use data from Figure 16 to determine the amplitude of the wave.

(1)

amplitude = ... cm

(ii) Use data from Figure 16 to determine the wavelength of the wave.

(1)

wavelength = ... cm

(iii) The water wave shown in Figure 16 is generated in a large tank.

A student observes the wave.

Describe how the student could determine the wave speed of the wave.

(2)

.....

.....

.....

.....

DO NOT WRITE IN THIS AREA
DO NOT WRITE IN THIS AREA
DO NOT WRITE IN THIS AREA

(b) When an earthquake happens, waves are transmitted through the Earth.
Figure 17 is a diagram of a part of the Earth's crust.

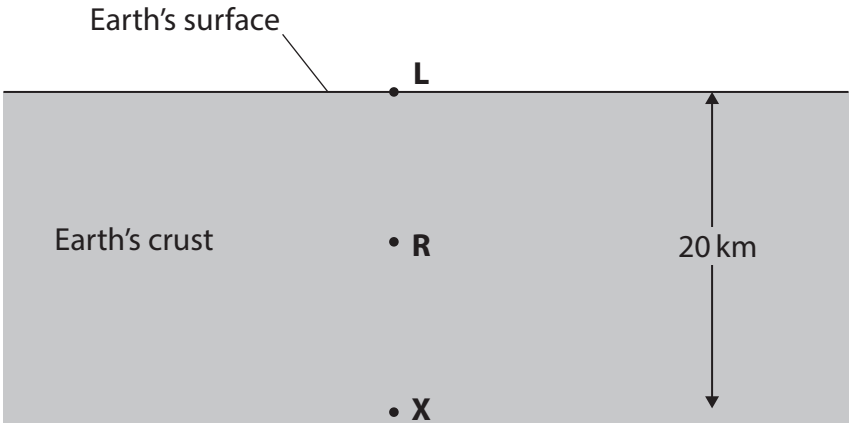

Figure 17

An earthquake happens at point **X**, 20 km below the Earth's surface.

An earthquake wave from **X** is detected at point **L**.

This earthquake wave is a transverse wave.

(i) State **one** other example of a transverse wave.

(1)

.....

(ii) A point in the crust is labelled **R** in Figure 17.
There is a rock at point **R**.

Describe the effect that this earthquake wave has on the rock at **R** as the wave passes through the rock.

You may add to Figure 17 to help your answer.

(2)

.....

.....

.....

.....

DO NOT WRITE IN THIS AREA
DO NOT WRITE IN THIS AREA
DO NOT WRITE IN THIS AREA

*(c) A scientist investigates a sample of an unknown radioactive material.

The scientist finds that the sample does **not** emit beta radiation.

The scientist sets up the experiment shown in Figure 18 and uses different absorbers to investigate alpha and gamma radiation.

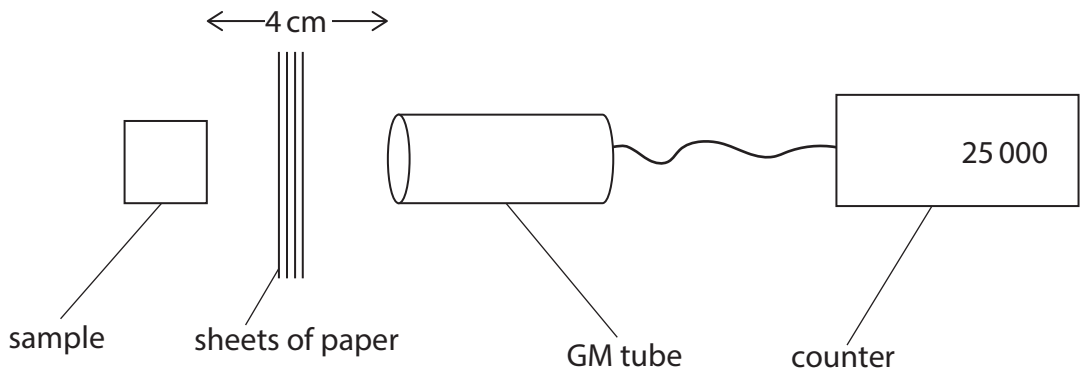

Figure 18

The results are shown in Figure 19.

The count rates are rounded to two significant figures.

The background radiation was 18 counts per minute (cpm).

absorber	count rate / cpm
none	33 000
4 sheets of paper	25 000
3 cm of lead	4 000

Figure 19

Discuss whether the sample emits alpha or gamma radiation or both.

Your answer should refer to

- the data shown in Figure 19
- how the data gives evidence for particular radiations.

(6)

.....

.....

.....

.....

DO NOT WRITE IN THIS AREA
DO NOT WRITE IN THIS AREA
DO NOT WRITE IN THIS AREA

DO NOT WRITE IN THIS AREA
DO NOT WRITE IN THIS AREA
DO NOT WRITE IN THIS AREA

(Total for Question 9 = 13 marks)

10 This question is about using radioactivity and nuclear energy.

(a) (i) Gamma ray irradiation of food kills harmful bacteria by using

(1)

☒ **A** ionising particles

☒ **B** ionising radiation

☒ **C** non-ionising particles

☒ **D** non-ionising radiation

(ii) Which part of a nuclear reactor is used to absorb neutrons?

(1)

☒ **A** control rods

☒ **B** coolant

☒ **C** moderator

☒ **D** PET scanner

DO NOT WRITE IN THIS AREA
DO NOT WRITE IN THIS AREA
DO NOT WRITE IN THIS AREA

(b) The isotope fluorine-18 is used in PET scans, which help to detect cancers.

Figure 20 shows a radioactive decay curve for a sample of fluorine-18.

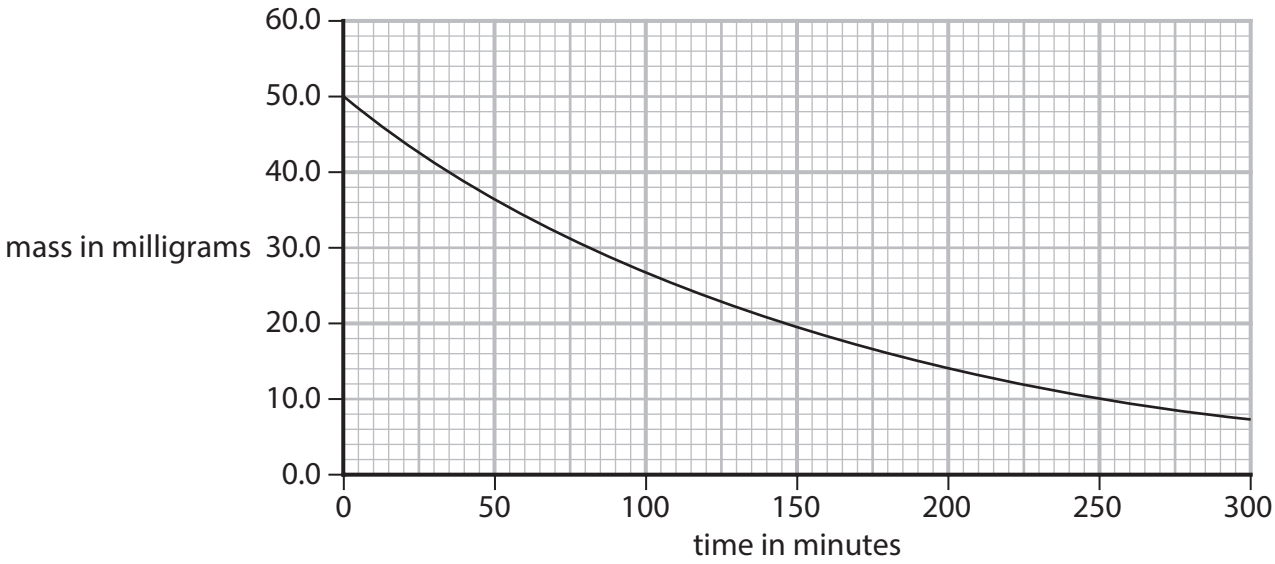

Figure 20

(i) Use the graph to calculate the percentage of fluorine-18 remaining after 150 minutes.

(2)

percentage of fluorine-18 remaining after 150 minutes = ... %

(ii) Fluorine-18 releases positrons.

Describe what happens when positrons meet electrons.

(2)

.....

.....

.....

.....

DO NOT WRITE IN THIS AREA
DO NOT WRITE IN THIS AREA
DO NOT WRITE IN THIS AREA

(c) Figure 21 shows what happens during a fission chain reaction.

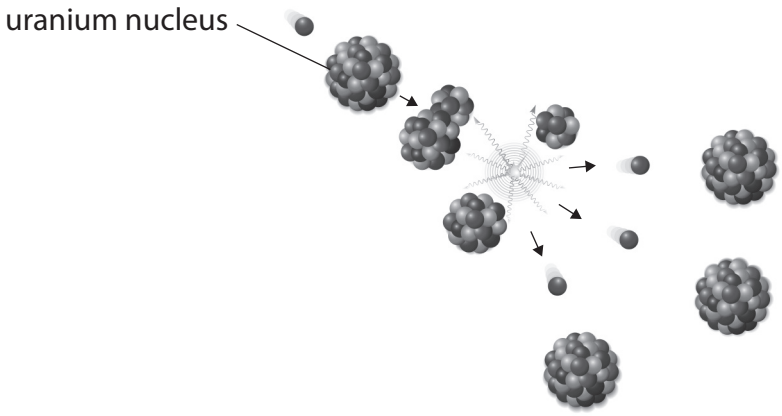

(Source: © Designua/Shutterstock)

Figure 21

Explain what happens when **one** neutron interacts with **one** uranium nucleus.

(3)

.....

.....

.....

.....

.....

.....

DO NOT WRITE IN THIS AREA
DO NOT WRITE IN THIS AREA
DO NOT WRITE IN THIS AREA

(d) In 2023, Finland produced 4.4 GW of power from nuclear power plants.

The UK produced 8.9 GW of power from nuclear power plants.

Calculate the ratio of nuclear power produced in Finland compared with the UK as

$$\frac{\text{power production in Finland}}{\text{power production in the UK}}$$

Give your answer to 2 significant figures (2 s.f.).

(2)

ratio = ...

(Total for Question 10 = 11 marks)

TOTAL FOR PAPER = 100 MARKS

DO NOT WRITE IN THIS AREA
DO NOT WRITE IN THIS AREA
DO NOT WRITE IN THIS AREA

BLANK PAGE

DO NOT WRITE IN THIS AREA
DO NOT WRITE IN THIS AREA
DO NOT WRITE IN THIS AREA

DO NOT WRITE IN THIS AREA
DO NOT WRITE IN THIS AREA
DO NOT WRITE IN THIS AREA

BLANK PAGE

BLANK PAGE

DO NOT WRITE IN THIS AREA
DO NOT WRITE IN THIS AREA
DO NOT WRITE IN THIS AREA

Pearson Edexcel Level 1/Level 2 GCSE (9–1)

Thursday 22 May 2025

Paper reference **1PH0/1F**

Physics

PAPER 1

Foundation Tier

Equation Booklet

Do not return this Booklet with the question paper.

Turn over

P78727RA

©2025 Pearson Education Ltd.
Y: 1/1/1/1/1/1/1/1/1/1/1/1/1/

P 7 8 7 2 7 R A

Pearson

If you're taking **GCSE (9–1) Combined Science** or **GCSE (9–1) Physics**, you will need these equations:

HT = higher tier

	distance travelled = average speed × time	
	acceleration = change in velocity ÷ time taken	$a = \frac{(v-u)}{t}$
	force = mass × acceleration	$F = m \times a$
	weight = mass × gravitational field strength	$W = m \times g$
HT	**momentum = mass × velocity**	$\boldsymbol{p = m \times v}$
	change in gravitational potential energy = mass × gravitational field strength × change in vertical height	$\Delta GPE = m \times g \times \Delta h$
	kinetic energy = 1/2 × mass × (speed)^2	$KE = \frac{1}{2} \times m \times v^2$
	efficiency = $\frac{(\text{useful energy transferred by the device})}{(\text{total energy supplied to the device})}$	
	wave speed = frequency × wavelength	$v = f \times \lambda$
	wave speed = distance ÷ time	$v = \frac{x}{t}$
	work done = force × distance moved in the direction of the force	$E = F \times d$
	power = work done ÷ time taken	$P = \frac{E}{t}$
	energy transferred = charge moved × potential difference	$E = Q \times V$
	charge = current × time	$Q = I \times t$
	potential difference = current × resistance	$V = I \times R$
	power = energy transferred ÷ time taken	$P = \frac{E}{t}$
	electrical power = current × potential difference	$P = I \times V$
	electrical power = (current)^2 × resistance	$P = I^2 \times R$
	density = mass ÷ volume	$\rho = \frac{m}{V}$

	force exerted on a spring = spring constant × extension	$F = k \times x$
	(final velocity)^2 – (initial velocity)^2 = 2 × acceleration × distance	$v^2 - u^2 = 2 \times a \times x$
HT	**force = change in momentum ÷ time**	$\boldsymbol{F = \frac{(mv - mu)}{t}}$
	energy transferred = current × potential difference × time	$E = I \times V \times t$
HT	**force on a conductor at right angles to a magnetic field carrying a current = magnetic flux density × current × length**	$\boldsymbol{F = B \times I \times l}$
	For transformers with 100% efficiency, potential difference across primary coil × current in primary coil = potential difference across secondary coil × current in secondary coil	$V_P \times I_P = V_S \times I_S$
	change in thermal energy = mass × specific heat capacity × change in temperature	$\Delta Q = m \times c \times \Delta\theta$
	thermal energy for a change of state = mass × specific latent heat	$Q = m \times L$
	energy transferred in stretching = 0.5 × spring constant × (extension)^2	$E = \frac{1}{2} \times k \times x^2$

If you're taking **GCSE (9–1) Physics**, you also need these extra equations:

	moment of a force = force × distance normal to the direction of the force	
	pressure = force normal to surface ÷ area of surface	$P = \frac{F}{A}$
HT	$\frac{\textit{potential difference across primary coil}}{\textit{potential difference across secondary coil}} = \frac{\textit{number of turns in primary coil}}{\textit{number of turns in secondary coil}}$	$\boldsymbol{\frac{V_p}{V_S} = \frac{N_p}{N_S}}$
	to calculate pressure or volume for gases of fixed mass at constant temperature	$P_1 \times V_1 = P_2 \times V_2$
HT	**pressure due to a column of liquid = height of column × density of liquid × gravitational field strength**	$\boldsymbol{P = h \times \rho \times g}$

END OF EQUATION LIST

BLANK PAGE