AQA

Please write clearly in block capitals.

Centre number | | | | | | Candidate number | | | | |

Surname _____

Forename(s) _____

Candidate signature _____
I declare this is my own work.

GCSE
MATHEMATICS

H

Higher Tier Paper 3 Calculator

Monday 7 November 2022 Morning Time allowed: 1 hour 30 minutes

Materials
For this paper you must have:
- a calculator
- mathematical instruments
- the Formulae Sheet (enclosed).

Instructions
- Use black ink or black ball-point pen. Draw diagrams in pencil.
- Fill in the boxes at the top of this page.
- Answer **all** questions.
- You must answer the questions in the spaces provided. Do not write outside the box around each page or on blank pages.
- If you need extra space for your answer(s), use the lined pages at the end of this book. Write the question number against your answer(s).
- Do all rough work in this book. Cross through any work you do not want to be marked.

Information
- The marks for questions are shown in brackets.
- The maximum mark for this paper is 80.
- You may ask for more answer paper, graph paper and tracing paper. These must be tagged securely to this answer book.

Advice
In all calculations, show clearly how you work out your answer.

For Examiner's Use	
Pages	Mark
2–3	
4–5	
6–7	
8–9	
10–11	
12–13	
14–15	
16–17	
18–19	
20–21	
22–23	
24–25	
26–27	
28–29	
TOTAL	

Do not write outside the box

Answer **all** questions in the spaces provided.

1 $2^x = 32$

Circle the value of x.

[1 mark]

4 5 6 7

2 What is 1.8×10^{-4} as an ordinary number?

Circle your answer.

[1 mark]

$-180\,000$ $-18\,000$ $0.000\,18$ $0.000\,018$

Do not write outside the box

3 Expand $6x^2(x^3 + 2)$

Circle your answer.

[1 mark]

$6x^5 + 2$ $6x^6 + 2$ $6x^5 + 12x^2$ $6x^6 + 12x^2$

4 $30 < x < 300$

x is 200% of y

Circle the correct inequality.

[1 mark]

$10 < y < 100$ $15 < y < 150$ $60 < y < 600$ $90 < y < 900$

Turn over for the next question

4

Do not write outside the box

5 *ABCDE* is a pentagon.

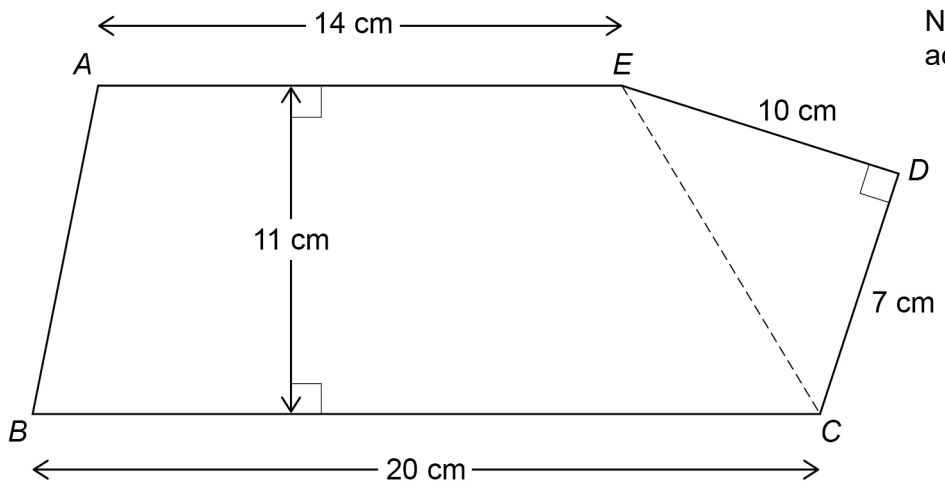

Not drawn accurately

Work out the area of the pentagon.

[3 marks]

Answer _____ cm^2

Do not write outside the box

6 Joe, Kim and Lisa each have an amount of money.

Joe has £72

Joe's amount : Kim's amount = 6 : 5

Lisa's amount is $1\frac{1}{2}$ times Joe's amount.

Show that, in total, they have **less** than £250

[3 marks]

Turn over for the next question

6

Do not write outside the box

7 (a) Here is the rule for a sequence.

After the first two terms, each term is the sum of the previous two terms

The 1st term is 33

The 2nd term is x

The 4th term is 73

Work out the value of x.

[3 marks]

$x =$ _____

7 (b) An expression for the nth term of a different sequence is $n - n^2$

Ruth says,

"All the terms will be negative because n^2 is always greater than n."

Is she correct?

Tick a box.

☐ Yes ☐ No

Give a reason for your answer.

[1 mark]

Do not write outside the box

8 Here is some information about the members of clubs A and B.

	Number of members	**Mean height of members**
Club A	24	1.8 m
Club B	20	1.92 m

Work out $\dfrac{\text{total height of the members of club A}}{\text{total height of the members of club B}}$

Give your answer as a decimal.

[2 marks]

Answer _____

Turn over for the next question

6

Do not write outside the box

9 *P* and *Q* are points.

The x-coordinate of *Q* is 4 **more** than the x-coordinate of *P*.

The y-coordinate of *Q* is 5 **less** than the y-coordinate of *P*.

Work out the gradient of the straight line through *P* and *Q*.

[2 marks]

Answer _____

Do not write outside the box

10 Here are the results after 250 spins of a coin.

Heads	128
Tails	122

The coin is spun an extra 50 times.

After all 300 spins, the relative frequency of Heads is 0.49

For the **extra 50 spins**, work out number of Heads : number of Tails

[3 marks]

Answer _____ : _____

Turn over for the next question

5

Do not write outside the box

11 Part of a running track is the arc of a semicircle joined to a straight line.

The semicircle has diameter 45 metres.

The straight line has length 75 metres.

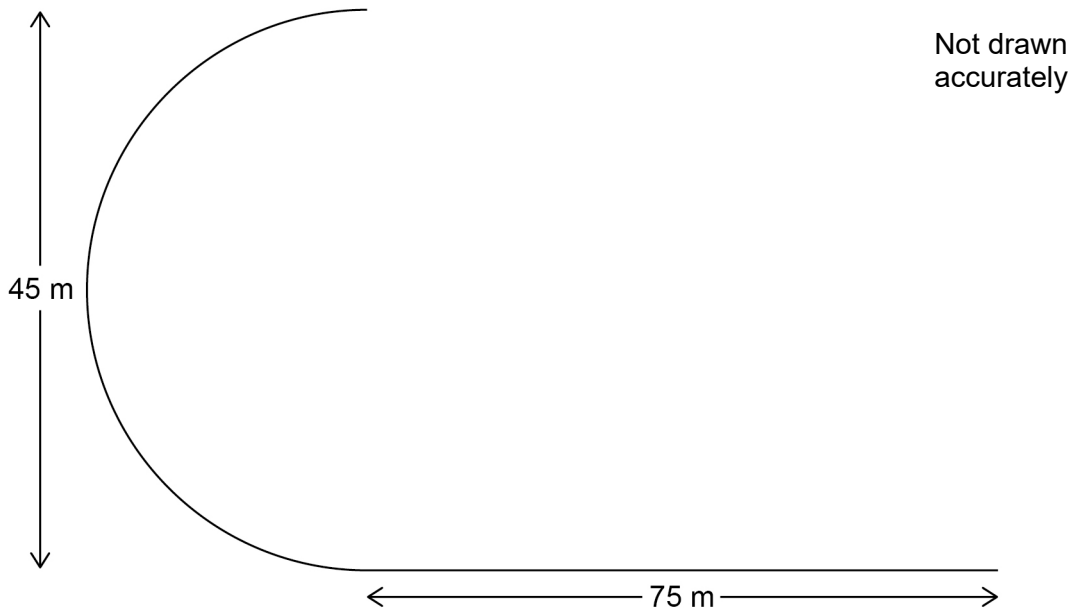

Abby runs once along this part of the track in 18 seconds.

Work out her average speed.

Give your answer to 2 significant figures.

[4 marks]

Answer _____ m/s

Do not write outside the box

12 Triangles *ABC* and *DEF* are shown on a grid.

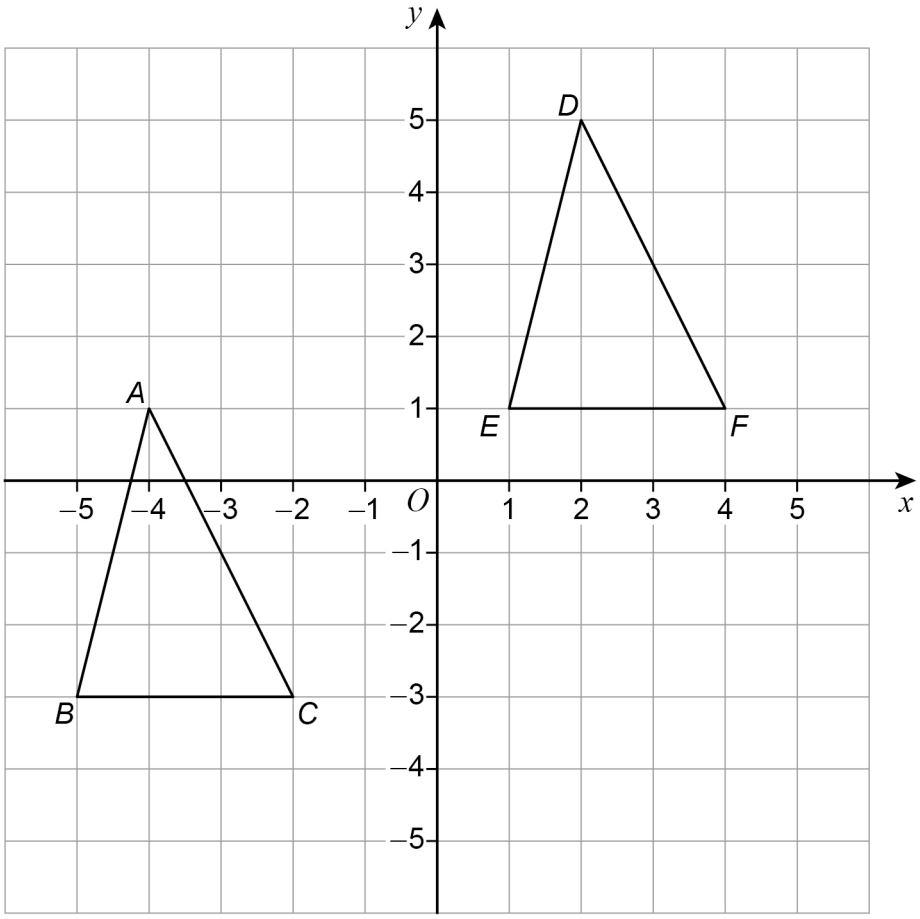

Describe a single transformation that shows the triangles are congruent.

[2 marks]

6

Turn over ►

Do not write outside the box

13 A fair, ordinary dice is rolled and a counter is taken at random from a bag.

The tree diagram shows the probabilities.

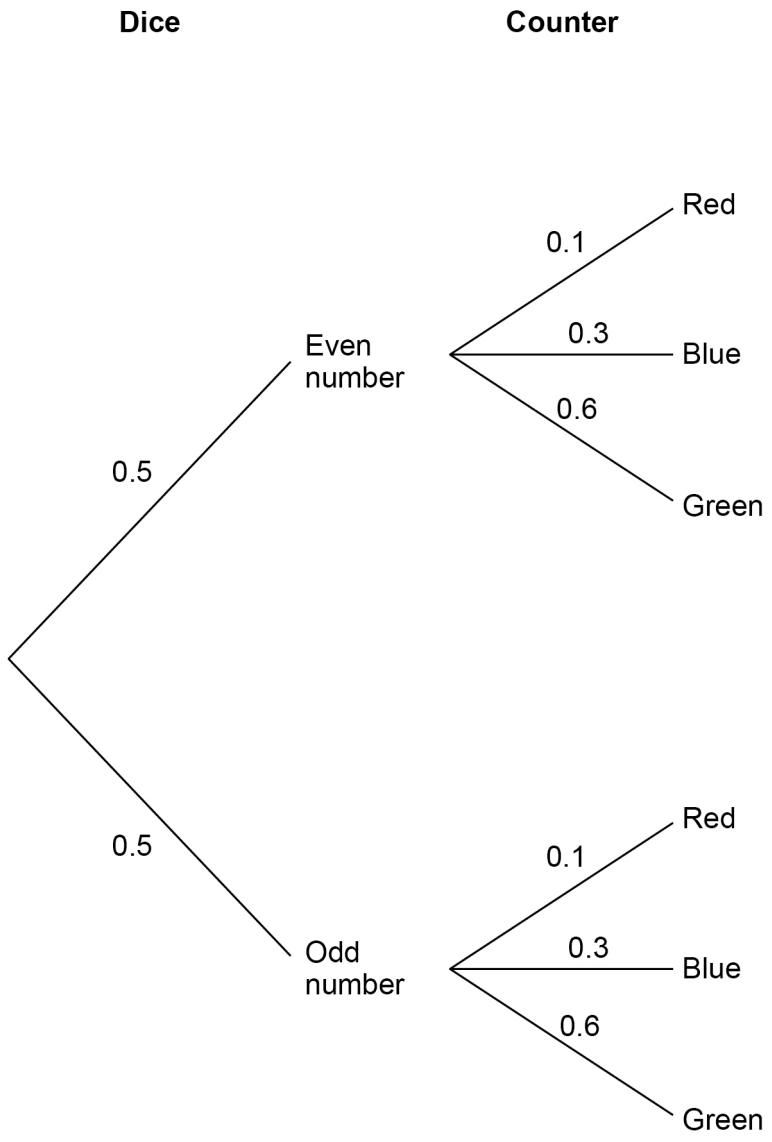

Do not write outside the box

13 (a) How do the probabilities show that **all** the counters in the bag are red, blue or green?

[1 mark]

13 (b) Circle the probability that the counter is red **or** blue.

[1 mark]

0.0009 0.8 0.03 0.4

13 (c) Circle the probability that the dice lands on an even number **and** the counter is blue.

[1 mark]

0.15 0.3 0.35 0.8

Turn over for the next question

3

Do not write outside the box

14 Here are two solid cubes, X and Y.

The mass of X is 10.976 kg

The area of **each face** of X is 784 cm^2

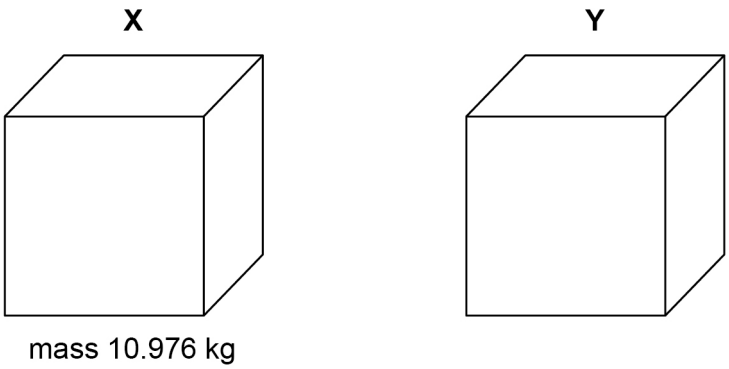

14 (a) Zayan wants to know the density of Y.

He assumes that Y is identical to X.

What density should he get for Y?

Give your answer in **grams per cubic centimetre**.

[4 marks]

Answer _____ g/cm^3

Do not write outside the box

14 (b) In fact,

the mass of Y is less than the mass of X

the area of each face of Y is greater than the area of each face of X.

What does this mean about the actual density of Y?

Tick **one** box.

[1 mark]

☐ It is less than the answer to part (a)

☐ It is equal to the answer to part (a)

☐ It is greater than the answer to part (a)

☐ It is not possible to tell

Turn over for the next question

5

Do not write outside the box

15 A mobile phone takes 2 hours to charge from empty.

When the phone is being charged, the current flow into the phone

- starts at full current flow (100%)
- continues at full current flow for a period of time
- gradually decreases until the phone is fully charged.

This is shown on **Graph A** below.

Graph A

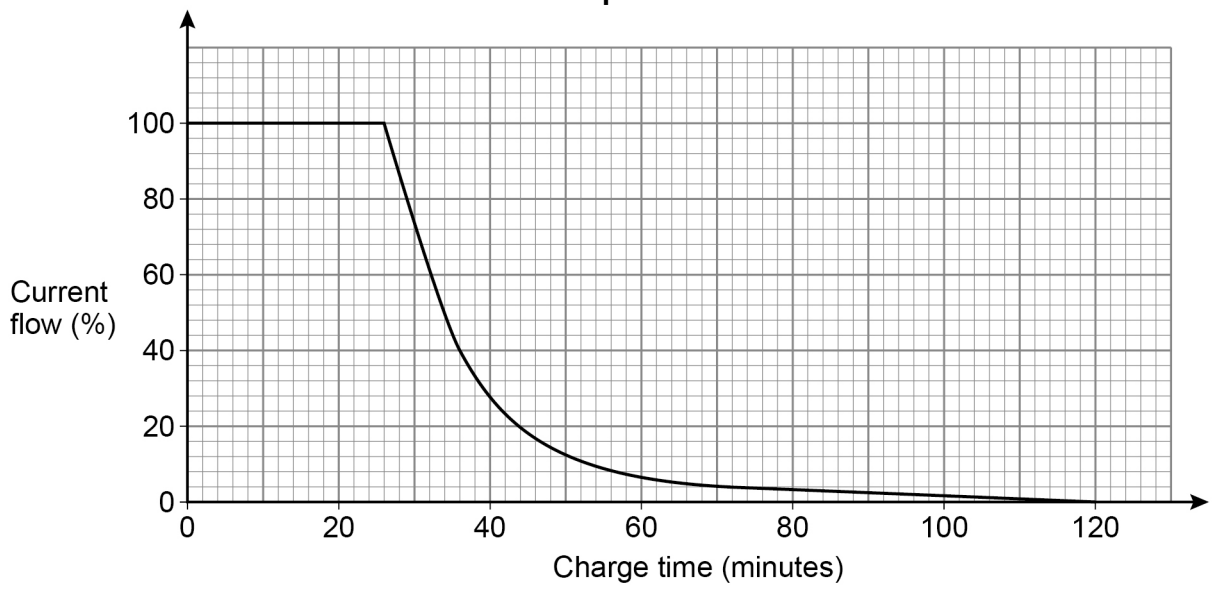

Graph B shows the percentage charge in the phone when charging from empty.

Graph B

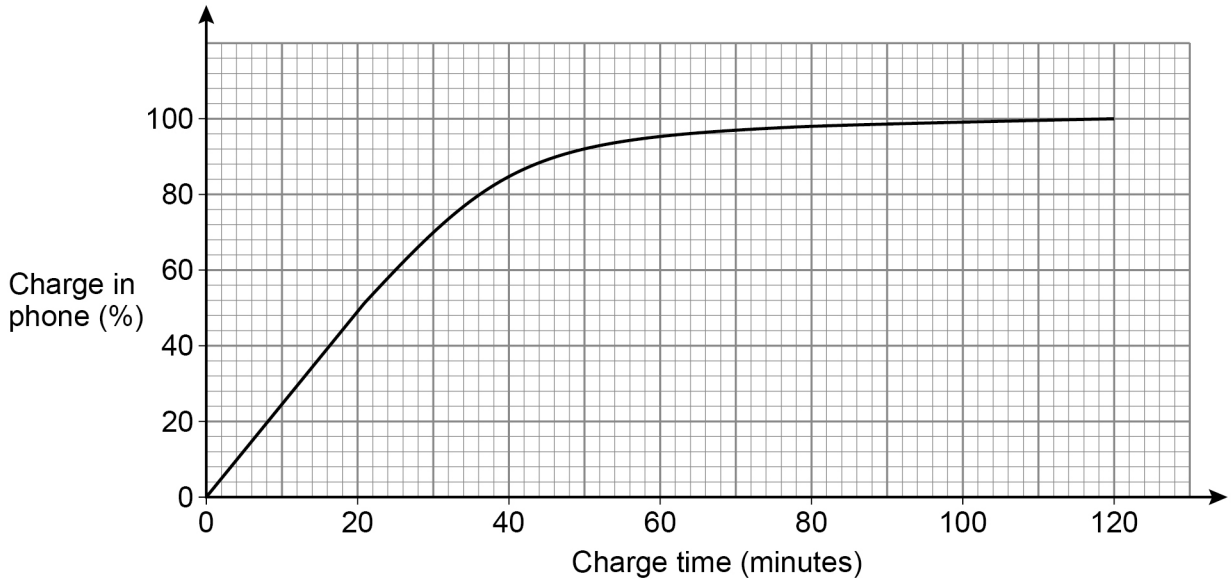

Do not write outside the box

Megan's phone is empty of charge.

She starts to charge her phone at 10.00 am

15 (a) Using **Graph A**,

estimate the time when the current flow starts to decrease.

[2 marks]

Answer _____ am

15 (b) Using **Graph A and Graph B**,

estimate the percentage charge in the phone when the current flow is 40%

[1 mark]

Answer _____ %

15 (c) Using **Graph B**,

estimate the rate of increase in the percentage charge when the phone has 90% charge.

[2 marks]

Answer _____ percent per minute

5

Turn over ►

Do not write outside the box

16 H is inversely proportional to the cube root of L.

$H = 7$ when $L = 64$

16 (a) Work out an equation connecting H and L.

[3 marks]

Answer _____

16 (b) Work out the value of H when $L = 2744$

[2 marks]

$H =$ _____

Do not write outside the box

17 *A*, *B* and *C* are points on a circle, centre *O*.

BD is a tangent to the circle.

OCD is a straight line.

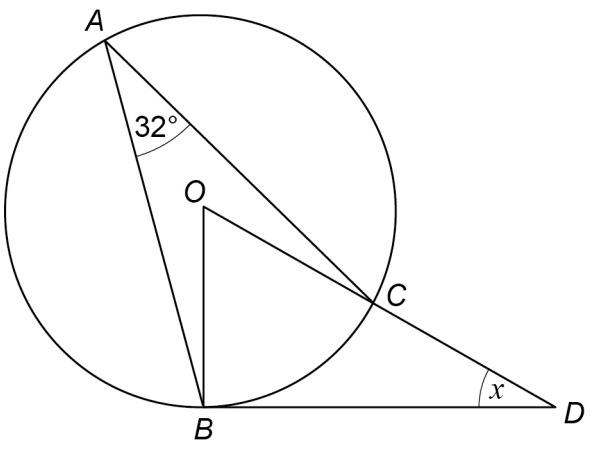

Not drawn accurately

Work out the size of angle x.

[3 marks]

$x =$ _____ degrees

8

Turn over ►

Do not write outside the box

18 Rearrange $9m + 4(2m - 1) = p^2 + pm$ to make m the subject.

[4 marks]

Answer _____

19 A circle has centre (0, 0) and passes through (0, 11)

Write down the equation of the circle.

[1 mark]

Answer _____

Do not write outside the box

20 There should be a train leaving a station every hour from 7 am

No trains leave early.

P(the **first train** leaves on time) = 0.9

For all the **other trains**,

if the previous train did leave on time, P(this train leaves on time) = 0.8

if the previous train did **not** leave on time, P(this train leaves on time) = 0.65

20 (a) Work out P(the first three trains leave on time)

[2 marks]

Answer _____

20 (b) The 2 pm train does **not** leave on time.

Work out P(exactly one of the next two trains does **not** leave on time)

[3 marks]

Answer _____

10

Turn over ►

Do not write outside the box

21 Shape A is enlarged to shape B.

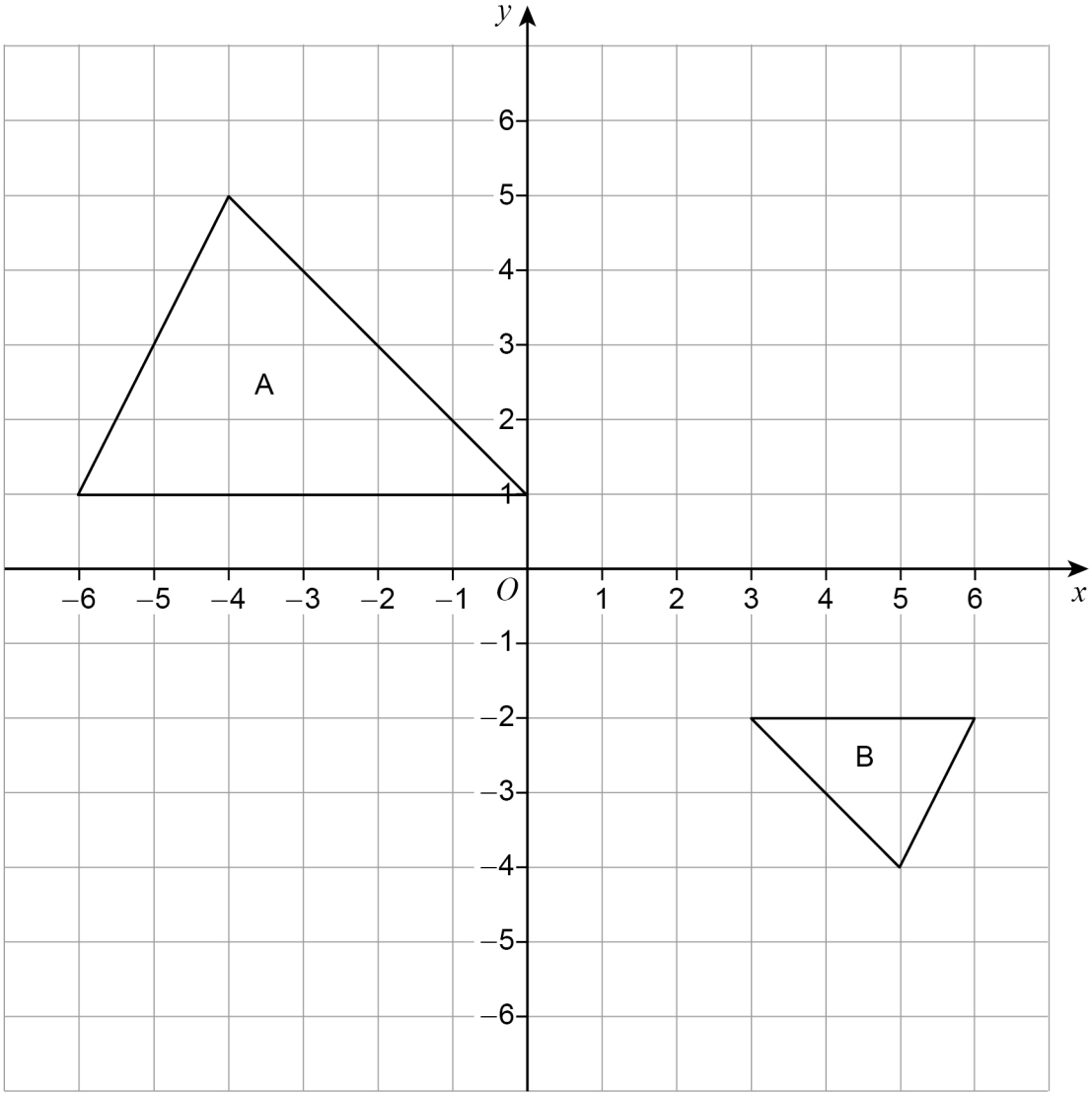

21 (a) Circle the scale factor of the enlargement.

[1 mark]

$-\frac{1}{2}$ $\quad$ -2 $\quad$ $\frac{1}{2}$ $\quad$ 2

21 (b) Write down the coordinates of the centre of enlargement.

[1 mark]

Answer (_____ , _____)

Do not write outside the box

22 Simplify fully $\dfrac{2}{x+1} + \dfrac{7-5x}{3} + 4x$

Give your answer as a single fraction.

[4 marks]

Answer _____

6

Turn over ►

Do not write outside the box

23 Alec makes a bowl for dog food from a solid wooden cone.

The sketches show how the bowl is made.

The cone has radius 9 cm and perpendicular height 30 cm

A smaller cone, with radius 6 cm, is removed.

Not drawn accurately

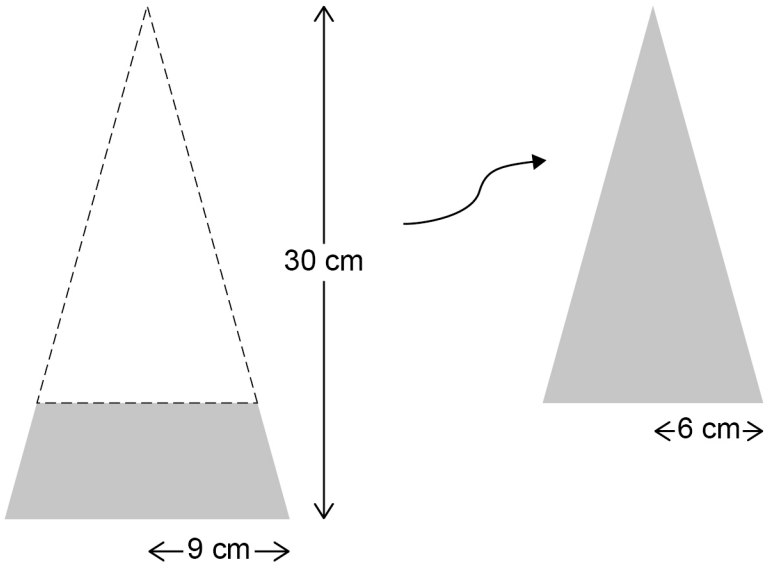

Volume of a cone $= \frac{1}{3}\pi r^2 h$

where r is the radius and h is the perpendicular height

A hemisphere with radius 6 cm is then removed.

Not drawn accurately

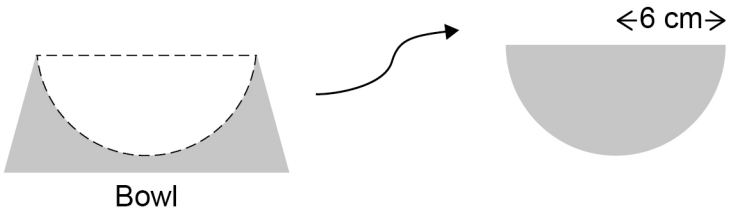

Volume of a hemisphere $= \frac{2}{3}\pi r^3$ where r is the radius

Do not write outside the box

Work out the volume of the remaining wood that forms the bowl.

[5 marks]

Answer _____ cm^3

5

Turn over ►

Do not write outside the box

24 On the same day, Kate buys

a car for £14 000

and

a painting for £5000

The value of the car decreases by 35% in the first year, and then by 10% each year.

The value of the painting increases by 4% each year.

Show that the painting becomes worth more than the car during the fifth year.

[5 marks]

Do not write outside the box

25 Two sides of a triangle are measured to 1 decimal place.

The angle between the sides is measured to the nearest degree.

Not drawn accurately

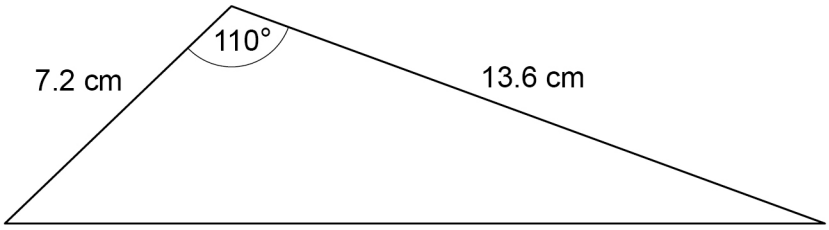

Work out the upper bound for the area of the triangle.

You **must** show your working.

[4 marks]

Answer _____ cm^2

Turn over for the next question

9

Do not write outside the box

26 Here is a sketch of the graph of $y = 5^x$

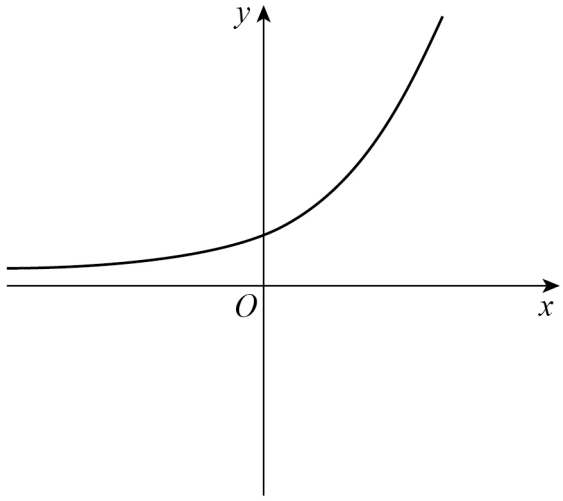

In parts (a) and (b) the sketch of $y = 5^x$ is shown as a dashed line.

26 (a) On the axes below, sketch the graph of $y = -5^x$

[1 mark]

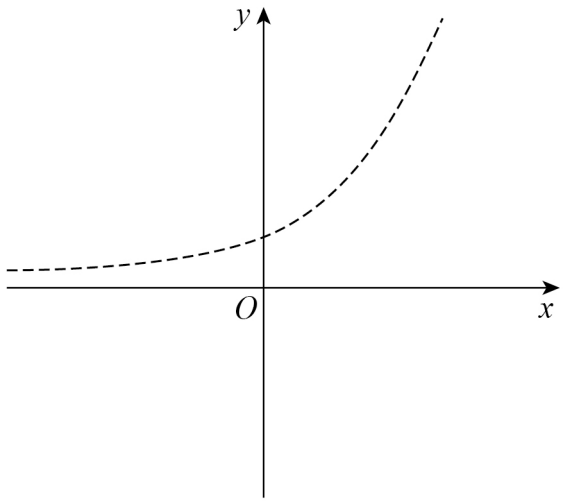

Do not write outside the box

26 (b) On the axes below, sketch the graph of $y = 5^x - 1$

[1 mark]

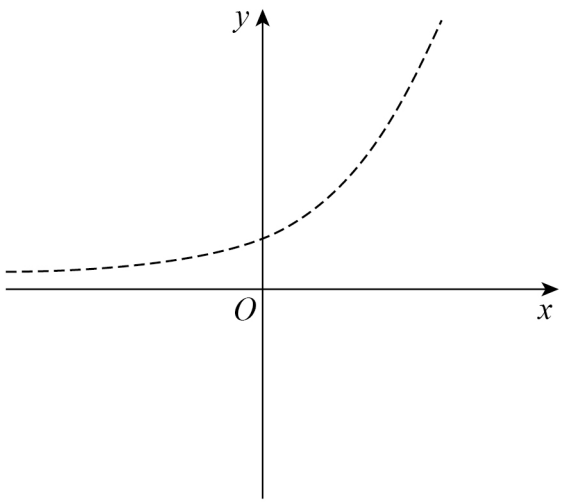

END OF QUESTIONS

2

Do not write outside the box

There are no questions printed on this page

DO NOT WRITE ON THIS PAGE
ANSWER IN THE SPACES PROVIDED

Do not write outside the box

Question number	**Additional page, if required.** **Write the question numbers in the left-hand margin.**

Do not write outside the box

Question number	**Additional page, if required.** **Write the question numbers in the left-hand margin.**

Copyright information

For confidentiality purposes, all acknowledgements of third-party copyright material are published in a separate booklet. This booklet is published after each live examination series and is available for free download from www.aqa.org.uk.

Permission to reproduce all copyright material has been applied for. In some cases, efforts to contact copyright-holders may have been unsuccessful and AQA will be happy to rectify any omissions of acknowledgements. If you have any queries please contact the Copyright Team.

Copyright © 2022 AQA and its licensors. All rights reserved.