AQA

Please write clearly in block capitals.

Centre number | | | | | | Candidate number | | | | |

Surname _____

Forename(s) _____

Candidate signature _____
I declare this is my own work.

GCSE
MATHEMATICS

F

Foundation Tier Paper 2 Calculator

Thursday 3 November 2022 Morning Time allowed: 1 hour 30 minutes

Materials

For this paper you must have:
- a calculator
- mathematical instruments
- the Formulae Sheet (enclosed).

Instructions
- Use black ink or black ball-point pen. Draw diagrams in pencil.
- Fill in the boxes at the top of this page.
- Answer **all** questions.
- You must answer the questions in the spaces provided. Do not write outside the box around each page or on blank pages.
- If you need extra space for your answer(s), use the lined pages at the end of this book. Write the question number against your answer(s).
- Do all rough work in this book. Cross through any work you do not want to be marked.

Information
- The marks for questions are shown in brackets.
- The maximum mark for this paper is 80.
- You may ask for more answer paper, graph paper and tracing paper. These must be tagged securely to this answer book.

Advice
In all calculations, show clearly how you work out your answer.

For Examiner's Use	
Pages	Mark
2–3	
4–5	
6–7	
8–9	
10–11	
12–13	
14–15	
16–17	
18–19	
20–21	
22–23	
24–25	
26	
TOTAL	

Do not write outside the box

Answer **all** questions in the spaces provided.

1 Circle the number that is a multiple of 25

[1 mark]

55 65 75 85

2 Circle the value of the digit 3 in the number 10.23

[1 mark]

$\frac{3}{1000}$ $\frac{3}{100}$ $\frac{3}{10}$ 3

3 Circle the lowest of these temperatures.

[1 mark]

–2.1°C 0.4°C –5°C 1°C

Do not write outside the box

4 Circle the letter of the shape that has **exactly one** line of symmetry.

[1 mark]

P

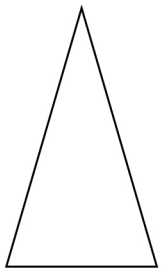

Q

R



S

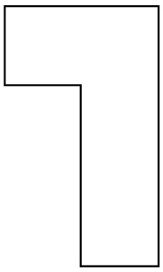

Turn over for the next question

4

Do not write outside the box

5 (a) Simplify fully $d \times d$

[1 mark]

Answer _____

5 (b) Simplify fully $n \div n$

[1 mark]

Answer _____

5 (c) Simplify fully $\frac{1}{3} \times 6t$

[1 mark]

Answer _____

Do not write outside the box

6 (a) Write a number in the box to make the calculation correct.

[1 mark]

$$16 \div \square = 0.016$$

6 (b) Write a number in the box to make the calculation correct.

[1 mark]

$$18.4 + 3.9 + \square = 27$$

6 (c) Write a fraction in the box to make the calculation correct.

[1 mark]

$$\frac{1}{2} \times \square = \frac{1}{8}$$

6 (d) Write the **same** number in both boxes to make the calculation correct.

[1 mark]

$$\square \times \square = 361$$

7

Turn over ►

Do not write outside the box

7 Three groups of people, A, B and C, have taken driving tests.

7 (a) Here is information about the number of tests taken by the people in A.

Group A

Key: ○ represents 4 people

One test	○ ○ ○
Two tests	○ ○ ○ ○
Three tests	○ (

Here is information about the number of tests taken by the people in B.

One test Half the number in A who have taken one test.

Two tests 4 fewer than the number in A who have taken two tests.

Three tests 10 more than the number in A who have taken three tests.

Complete this pictogram for the people in B.

[3 marks]

Group B

Key: ○ represents 4 people

One test	
Two tests	
Three tests	

Do not write outside the box

7 (b) In group C there are 25 people.

17 of these people have passed a test.

One person is picked at random from C.

Work out the probability that the person has **not** passed a test.

[2 marks]

Answer _____

8 Work out the value of $3r + 4t$ when $r = 13$ and $t = -2$

[2 marks]

Answer _____

Turn over for the next question

7

Do not write outside the box

9 Hamish has saved 295 coins.

Each one is a 20p coin.

He gives an equal number of 20p coins to each of his 8 grandchildren.

He gives them as many coins as possible.

How much, in £, does he have left?

[4 marks]

Answer £ _____

Do not write outside the box

10 Here are two sets of numbers.

Set A	2	12	13	27
Set B	1	15	16	30

One number from Set A is swapped with one number from Set B.
The total of the numbers in each set is now the same.

Which two numbers are swapped?

[2 marks]

Answer _____ and _____

11 Rearrange $m = p - 5$ to make p the subject.
Circle your answer.

[1 mark]

$p = \frac{m}{5}$ $\quad$ $p = m + 5$ $\quad$ $p = 5m$ $\quad$ $p = m - 5$

7

Turn over ►

Do not write outside the box

12 Here is the distance-time graph for a car between 1 pm and 3 pm

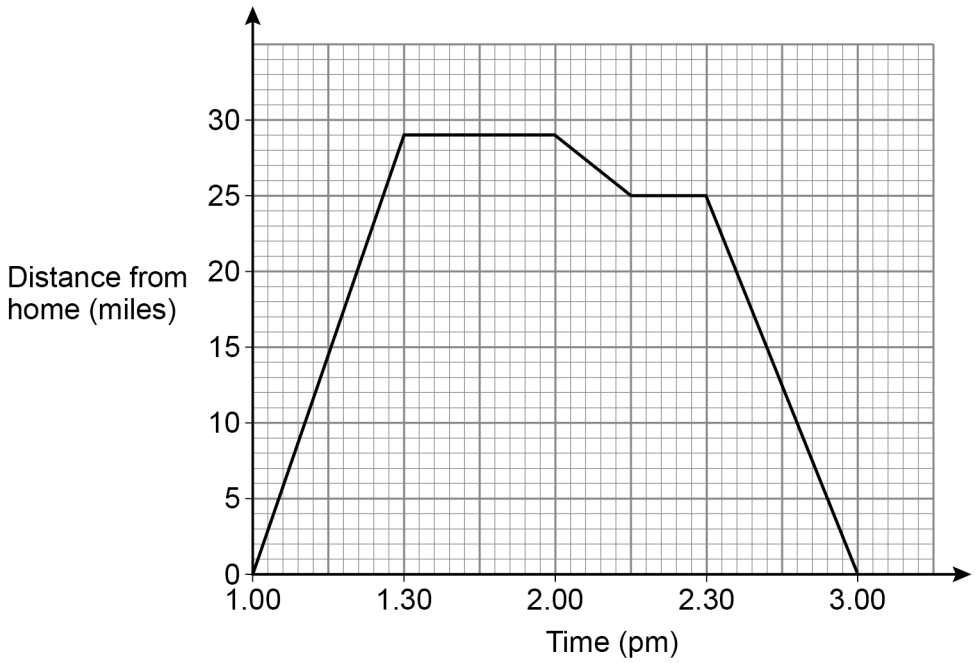

12 (a) Work out the **total** time that the car is **not** moving between 1 pm and 3 pm

State the units of your answer.

[2 marks]

Answer _____

12 (b) Work out the **total** distance the car travels between 1 pm and 3 pm

[2 marks]

Answer _____ miles

Do not write outside the box

13 *A* and *B* are points on a circle.

C is the centre of the circle.

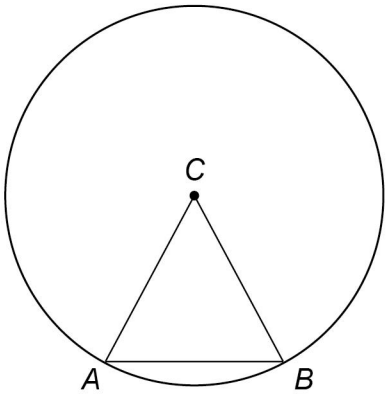

Not drawn accurately

Tick **one** box for each statement.

[3 marks]

	Definitely true	**Might be true**	**Cannot be true**
Line *AB* is a tangent to the circle	☐	☐	☐
AC is an arc of the circle	☐	☐	☐
Triangle *ABC* is equilateral	☐	☐	☐

Turn over for the next question

7

Do not write outside the box

14 To travel to a festival, a group of people will hire a minibus.

This formula has all costs in £

$$\text{Cost per person} = \frac{165 + \text{cost of the minibus}}{\text{number of people in the group}}$$

14 (a) With 12 people in the group, the cost of the minibus will be £567

Work out the cost per person.

[2 marks]

Answer £ _____

14 (b) With 15 people in the group, they will hire a different minibus.

The cost per person will be £50

Work out the cost of this minibus.

[3 marks]

Answer £ _____

Do not write outside the box

15 The sketch shows

the line $y = x$

line A, which is vertical

line B, which is horizontal.

The point (3, 5) is on both line A and line B.

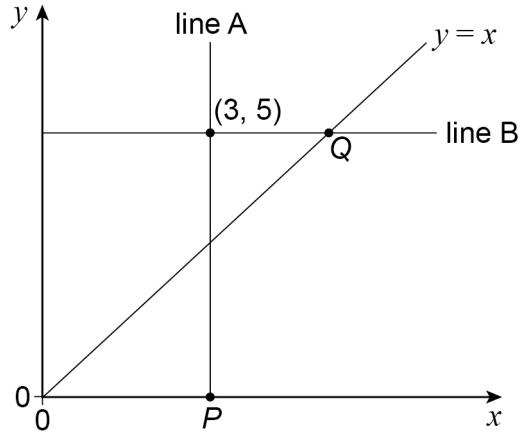

Write down the coordinates of *P* and *Q*.

[2 marks]

P (_____ , _____) *Q* (_____ , _____)

Turn over for the next question

7

Do not write outside the box

16 Some people were asked for the main way they listen to music.

A pie chart is drawn to represent their answers.

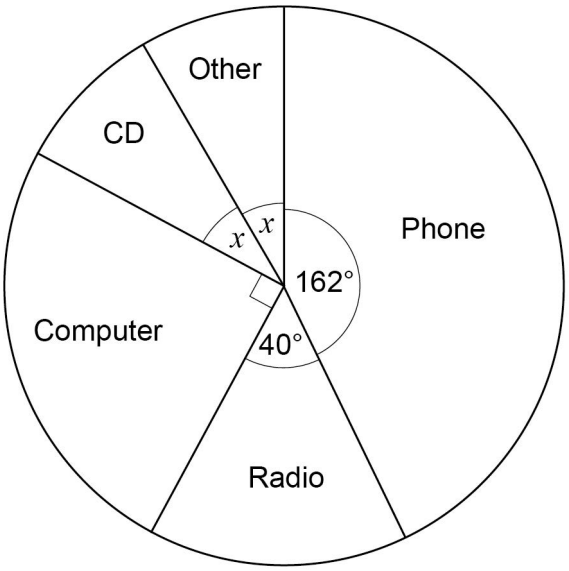

Not drawn accurately

16 (a) Work out the size of angle x.

[2 marks]

Answer _____ degrees

Do not write outside the box

16 (b) 135 people said Computer.

How many people said Phone?

[3 marks]

Answer _____

17 Complete this statement.

[1 mark]

10^8 = _____ million

Turn over for the next question

6

Do not write outside the box

18 A football team plays two matches.

18 (a) For the first match, 40 000 tickets are sold.
Assume that each ticket costs £38.50

Work out the total amount of money from ticket sales for this match.

[2 marks]

Answer £ _____

18 (b) In fact, for the first match,

some of the tickets cost less than £38.50

and

some of the tickets cost more than £38.50

What does this mean about the total amount of money from ticket sales for this match?
Tick **one** box.

[1 mark]

☐ It will be more than the answer to part (a)

☐ It will be the same as the answer to part (a)

☐ It will be less than the answer to part (a)

☐ It is not possible to tell

Do not write outside the box

18 (c) For the second match, the number of tickets sold increases from 40 000 to 55 000

Is the increase in tickets sold **more** than 35% ?

You **must** show your working.

[3 marks]

19 On a train, there are between 60 and 70 people.

The ratio of adults to children is 5 : 4

Work out the **total** number of people on the train.

[2 marks]

Answer _____

8

Turn over ►

Do not write outside the box

20 The composite bar chart shows information about the **percentage** of drinks sold by a café in 2007 and 2019

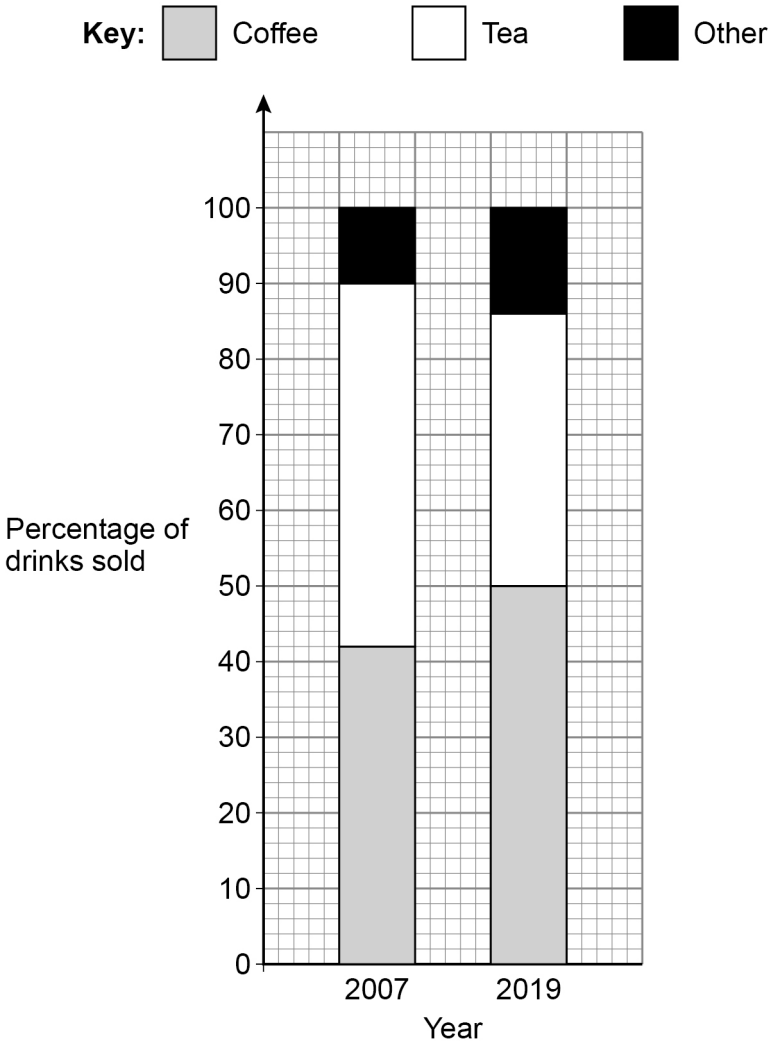

20 (a) In 2007 the café sold a total of 24 000 drinks.

How many **more** teas than coffees were sold?

[2 marks]

Answer _____

Do not write outside the box

20 (b) Were more coffees sold at the café in 2019 than in 2007 ?

Tick a box.

☐ Yes ☐ No ☐ Cannot tell

Give a reason for your answer.

[1 mark]

21 (a) k is a whole number between 40 and 50

The cube root of k is 3, to the nearest whole number.

Work out the **largest** possible value of k.

[2 marks]

Answer _____

21 (b) Fay tries to solve $x^2 = 100$

She says,

"The only possible value of x is 10"

Give a reason why she is **not** correct.

[1 mark]

6

Turn over ►

Do not write outside the box

22 (a) Here is a cuboid.

w, x and y are **different** whole numbers.

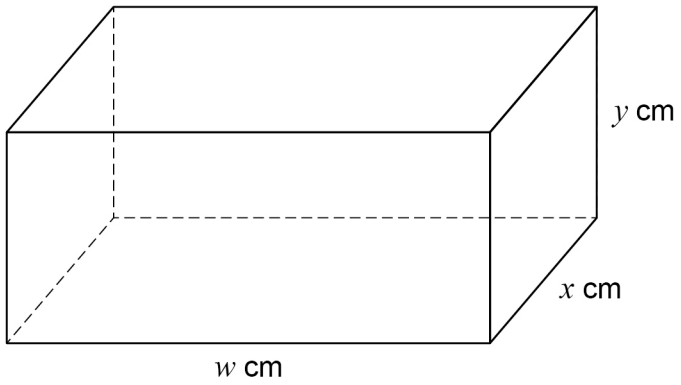

The total length of **all** the edges of the cuboid is 80 cm

The volume is **greater** than 200 cm^3

Work out one possible set of values for w, x and y.

[2 marks]

$w =$ _____ $x =$ _____ $y =$ _____

Do not write outside the box

22 (b) Here is a solid cube.

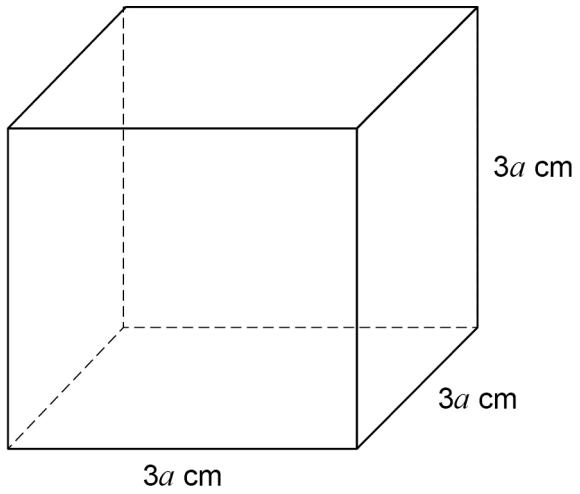

Circle the expression for the **total** surface area in cm^2

[1 mark]

$36a$ $54a$ $36a^2$ $54a^2$

23 The equation of a line is $y = 3x - 6$

Circle the coordinates of the y-intercept.

[1 mark]

(0, –6) (–6, 0) (0, 3) (3, 0)

4

Turn over ►

Do not write outside the box

24 (a) Work out $2.8^4 + \sqrt{158.76}$

Give your answer as a decimal.

[2 marks]

Answer _____

24 (b) Work out $\dfrac{6.09 \times 10^{14}}{4.2 \times 10^{9}}$

Give your answer in standard form.

[2 marks]

Answer _____

25 A tank contains 40 litres of water.

25 (a) Water leaks out of the tank at a rate of 1.2 litres per minute.

The leak is stopped after 20 minutes.

Show that, when the leak is stopped, the tank contains 16 litres of water.

[1 mark]

Do not write outside the box

25 (b) The tank is refilled with water from a tap.

The graph shows the amount of water in the tank **after** the leak is stopped.

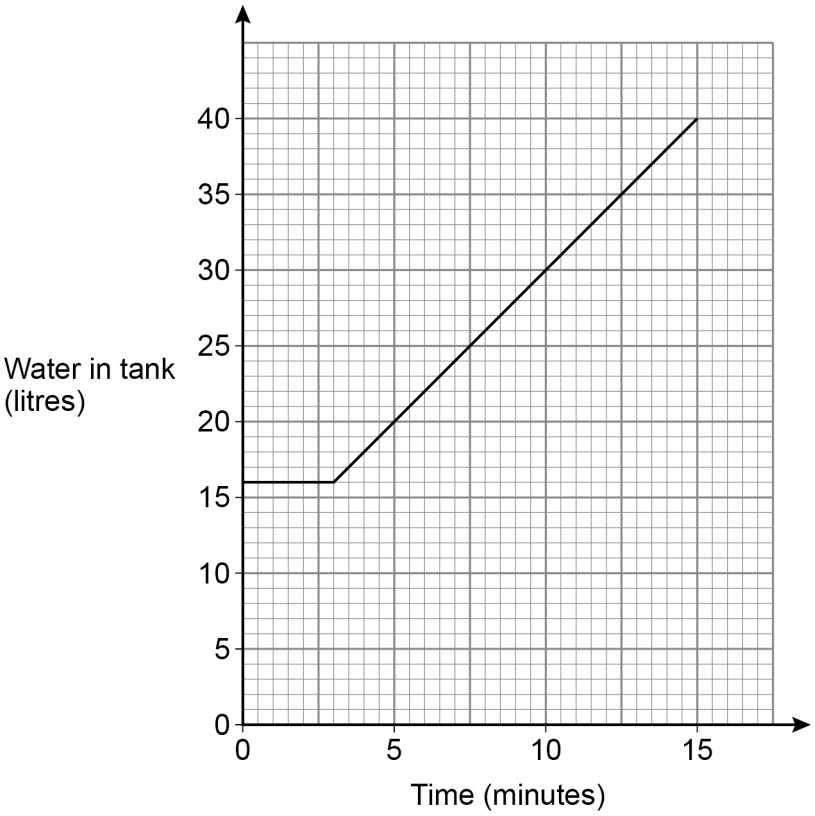

Complete this report by writing a number in each answer space.

[3 marks]

Report

_____ minutes after the leak is stopped, the tap starts to refill the tank.

The rate at which the tank refills is _____ litres per minute.

8

Turn over ►

Do not write outside the box

26 Here is a triangle.

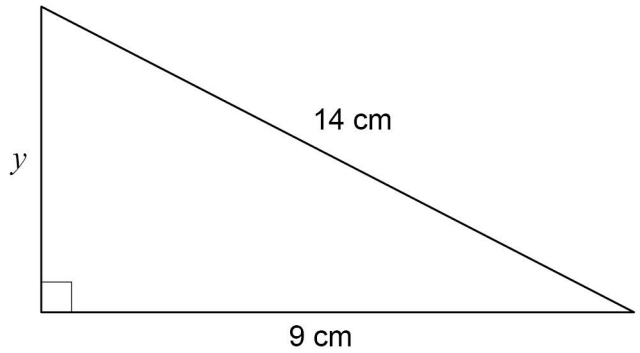

Not drawn accurately

Use Pythagoras' theorem to work out the value of y.

Give your answer as a decimal.

[3 marks]

$y =$ _____ cm

Do not write outside the box

27 The length of this rectangle is 6 times the width.

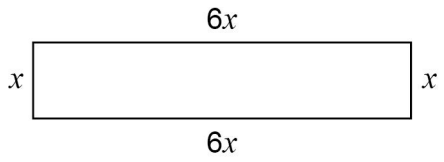

Not drawn accurately

Two of these rectangles are joined, with no overlap, to make this L-shape.



Not drawn accurately

The perimeter of the L-shape is 98.8 cm

Work out the value of the perimeter of **one** of the rectangles.

[4 marks]

Answer _____ cm

7

Turn over ►

Do not write outside the box

28 Written as the product of prime factors,

$$12\,600 = 2^3 \times 3^2 \times 5^2 \times 7$$

and

$$14\,112 = 2^5 \times 3^2 \times 7^2$$

Work out the highest common factor (HCF) of 12 600 and 14 112

Give your answer as an integer.

[2 marks]

Answer _____

END OF QUESTIONS

2

Do not write outside the box

There are no questions printed on this page

DO NOT WRITE ON THIS PAGE
ANSWER IN THE SPACES PROVIDED

Do not write outside the box

Question number	**Additional page, if required.** **Write the question numbers in the left-hand margin.**

Do not write outside the box

Question number	**Additional page, if required.** **Write the question numbers in the left-hand margin.**

Do not write outside the box

Question number	**Additional page, if required.** **Write the question numbers in the left-hand margin.**

Do not write outside the box

Question number	**Additional page, if required.** **Write the question numbers in the left-hand margin.**

Do not write outside the box

There are no questions printed on this page

DO NOT WRITE ON THIS PAGE
ANSWER IN THE SPACES PROVIDED

Copyright information

For confidentiality purposes, all acknowledgements of third-party copyright material are published in a separate booklet. This booklet is published after each live examination series and is available for free download from www.aqa.org.uk.

Permission to reproduce all copyright material has been applied for. In some cases, efforts to contact copyright-holders may have been unsuccessful and AQA will be happy to rectify any omissions of acknowledgements. If you have any queries please contact the Copyright Team.

Copyright © 2022 AQA and its licensors. All rights reserved.