AQA

Please write clearly in block capitals.

Centre number | | | | | | Candidate number | | | | |

Surname _____

Forename(s) _____

Candidate signature _____
I declare this is my own work.

GCSE
MATHEMATICS

F

Foundation Tier Paper 1 Non-Calculator

Tuesday 1 November 2022 Morning Time allowed: 1 hour 30 minutes

Materials
For this paper you must have:
- mathematical instruments
- the Formulae Sheet (enclosed).

You must **not** use a calculator.



Instructions
- Use black ink or black ball-point pen. Draw diagrams in pencil.
- Fill in the boxes at the top of this page.
- Answer **all** questions.
- You must answer the questions in the spaces provided. Do not write outside the box around each page or on blank pages.
- If you need extra space for your answer(s), use the lined pages at the end of this book. Write the question number against your answer(s).
- Do all rough work in this book. Cross through any work you do not want to be marked.

Information
- The marks for questions are shown in brackets.
- The maximum mark for this paper is 80.
- You may ask for more answer paper, graph paper and tracing paper. These must be tagged securely to this answer book.

Advice
In all calculations, show clearly how you work out your answer.

For Examiner's Use	
Pages	Mark
2–3	
4–5	
6–7	
8–9	
10–11	
12–13	
14–15	
16–17	
18–19	
20–21	
22	
TOTAL	

Do not write outside the box

Answer **all** questions in the spaces provided.

1 Circle the length of time between 4.00 pm and 5.05 pm

[1 mark]

55 min 65 min 105 min 125 min

2 A circle has diameter 10 cm

Circle the radius.

[1 mark]

5 cm 10 cm 20 cm 100 cm

3 Circle the percentage that is between $\frac{1}{2}$ and $\frac{3}{4}$

[1 mark]

40% 60% 80% 90%

Do not write outside the box

4 Circle the value of $3^2 + 4^2$

[1 mark]

14 17 25 49

5 Simplify fully $8a + 5b + 6a - 2b$

[2 marks]

Answer _____

Turn over for the next question

6

Do not write outside the box

6 200 students were each asked about the monthly cost of their phone contract.
Here are the results.

	Less than £25	**£25 or over**
School students	40	90
College students	32	38

6 (a) How many **more** school students than college students were asked?

[2 marks]

Answer _____

6 (b) What percentage of the 200 students had a monthly cost **less than £25** ?

[2 marks]

Answer _____ %

Do not write outside the box

7 The only animals on a farm are 30 cows and 80 sheep.

$\frac{1}{5}$ of the 30 cows are sold

and

$\frac{5}{8}$ of the 80 sheep are sold.

Work out the **total** number of animals that are sold.

[3 marks]

Answer _____

8 Some gamers were asked which type of video game they preferred.

65% said Action.

19% said Role-playing.

The rest said Sports.

What percentage said Sports?

[2 marks]

Answer _____ %

9

Turn over ►

Do not write outside the box

9 (a) A diagonal of a rectangle is drawn on a centimetre grid.

The sides of the rectangle are on the grid lines.

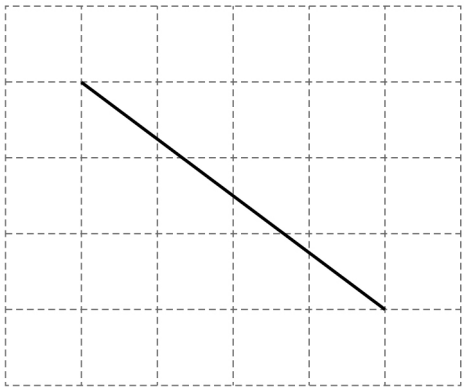

Work out the area of the rectangle.

[2 marks]

Answer _____ cm^2

9 (b) One side of a parallelogram is drawn on this centimetre grid.

The parallelogram does **not** have any right angles.

Complete the parallelogram so that it has area 24 cm^2

[2 marks]

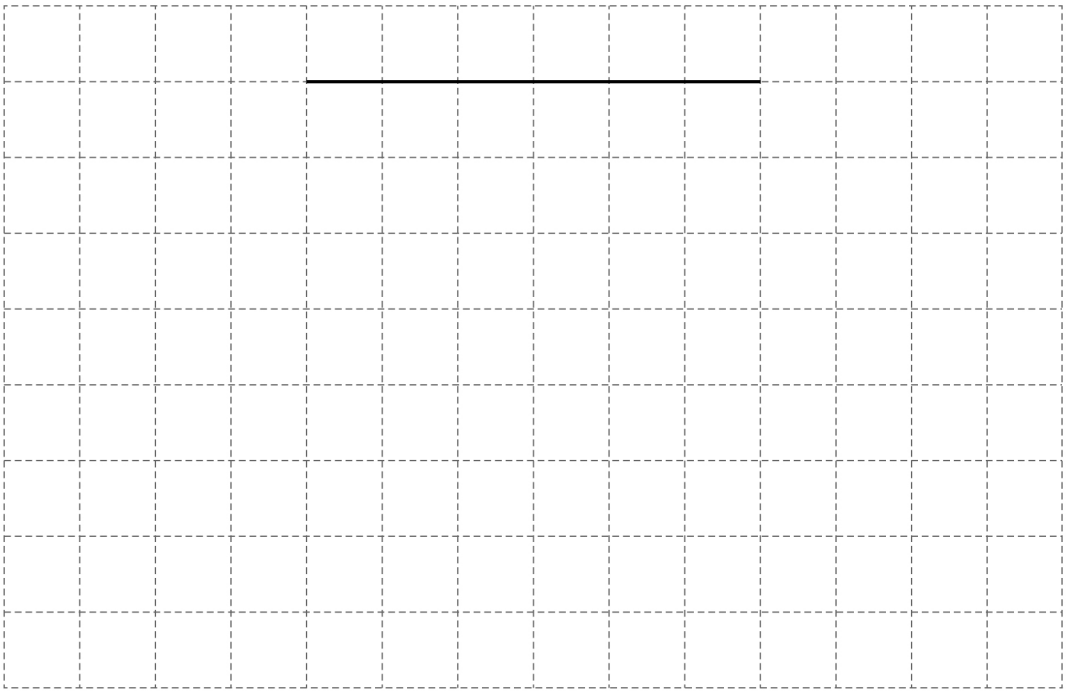

Do not write outside the box

9 (c) Two sides of a rhombus are drawn on this grid.

Complete the rhombus.

[1 mark]

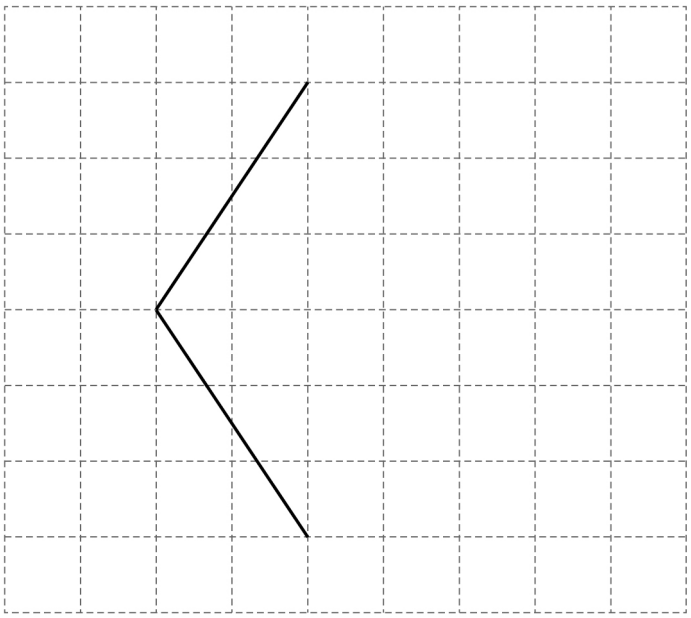

10 Here is a calculation.

$$428 \times 30 = 12\,840$$

Use the calculation to help answer the following questions.

10 (a) Write down the answer to $12\,840 \div 428$

[1 mark]

Answer _____

10 (b) Circle the answer to 214×30

[1 mark]

1284 3210 6420 25 680

7

Turn over ►

Do not write outside the box

11 A shop sells notebooks and pencils.

Notebooks	**Pencils**
Pack of 8 for £12	56p each or Pack of 6 for £2.70

11 (a) Marek buys some **packs** of notebooks.
The cost is £60

In total, how many **notebooks** does he buy?

[2 marks]

Answer _____

11 (b) Work out the cheapest cost of 10 pencils.

[3 marks]

Answer £ _____

Do not write outside the box

11 (c) The shop also sells folders for £3.20 each.

The shop has this offer.



Work out the cost of 4 folders using the offer.

[3 marks]

Answer £ _____

8

Turn over ►

Do not write outside the box

12 (a) *A*, *B* and *C* are connected by paths.

The length of each path is shown.

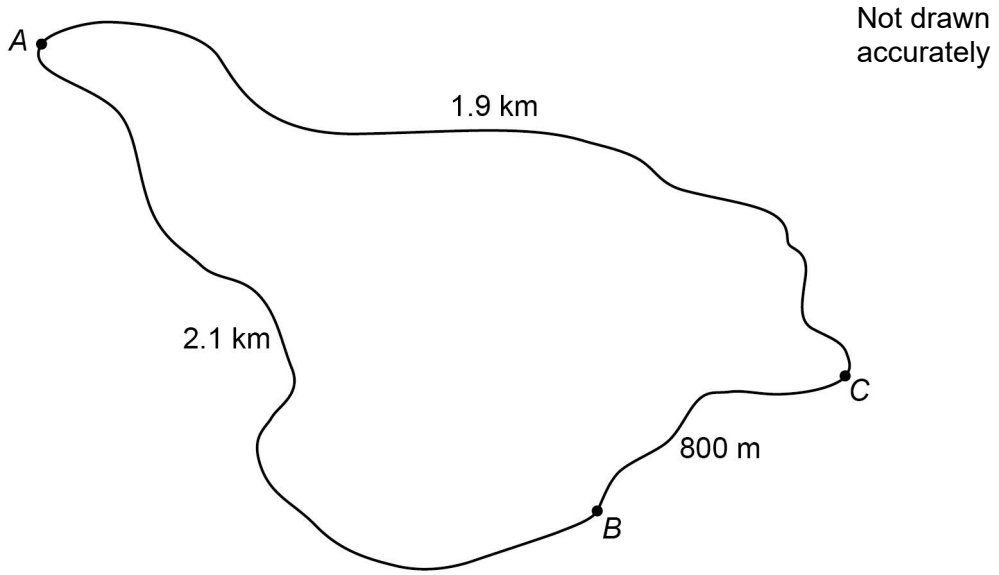

Nathan and Sue each walk from *A* to *B*.

Nathan walks along the path $A \rightarrow B$

Sue walks along the paths $A \rightarrow C \rightarrow B$

How much **further** does Sue walk than Nathan?

Give your answer in kilometres.

[3 marks]

Answer _____ km

Do not write outside the box

12 (b) A straight path between D and E passes through P.

$DE = 200$ metres

P is 60 metres **closer** to E than to D.

Not drawn accurately

Work out the ratio $DP : PE$

Give your answer in its simplest form.

[3 marks]

Answer _____ : _____

13 Emma tries to simplify $cd \times 2$

Here is her method.

$$c \times 2 = 2c$$
$$d \times 2 = 2d$$
$$2c \times 2d = 4cd$$

What is wrong with her method?

[1 mark]

7

Turn over ►

Do not write outside the box

14 Work out 0.37×0.26

Give your answer as a decimal.

[4 marks]

Answer _____

Do not write outside the box

15 (a) Solve $11x - 3 = 6x + 1$

[3 marks]

$x =$ _____

15 (b) Solve $\frac{2x}{5} = 14$

[2 marks]

$x =$ _____

9

Turn over ►

Do not write outside the box

16 Bag A and bag B each contain only red discs and green discs.

Bag A	Contains 28 red discs There are twice as many red discs as green discs
Bag B	Contains 20 green discs There are 3 red discs for every 5 green discs

16 (a) Work out the **total** number of discs.

[3 marks]

Answer _____

Do not write outside the box

16 (b) A different bag, C, is empty.

The 28 red discs from A are put into C.

The 20 green discs from B are also put into C.

One disc is now picked at random from each bag.

Complete each statement.

[3 marks]

The probability of red from A is _____

The probability of red from B is _____

The probability of red from C is _____

17 What is $\frac{1}{20}$ as a decimal?

Circle your answer.

[1 mark]

0.2 0.05 0.02 0.005

7

Turn over ►

Do not write outside the box

18 Divide 62 in the ratio 3 : 7

[3 marks]

Answer _____ and _____

19 n is an odd number.

Why is $n(n + 1)$ always an even number?

[2 marks]

Do not write outside the box

20 Here is some information about the time spent on social media by 40 women and 40 men last week.

Time spent, t (hours)	Number of women	Number of men
$2 < t \leqslant 5$	12	10
$5 < t \leqslant 8$	11	17
$8 < t \leqslant 11$	14	9
$11 < t \leqslant 14$	2	4
$14 < t \leqslant 17$	1	0

Tick **one** box for each statement.

[3 marks]

	Definitely true	Might be true	Cannot be true
Three of the **women** spent more than 11 hours on social media.	☐	☐	☐
The range for the **men** is 15 hours.	☐	☐	☐
The women have a higher median than the men.	☐	☐	☐

Turn over for the next question

8

Do not write outside the box

21 The diagram shows the vectors **a** and **b**.

As a column vector $\mathbf{a} = \begin{pmatrix} 3 \\ 2 \end{pmatrix}$

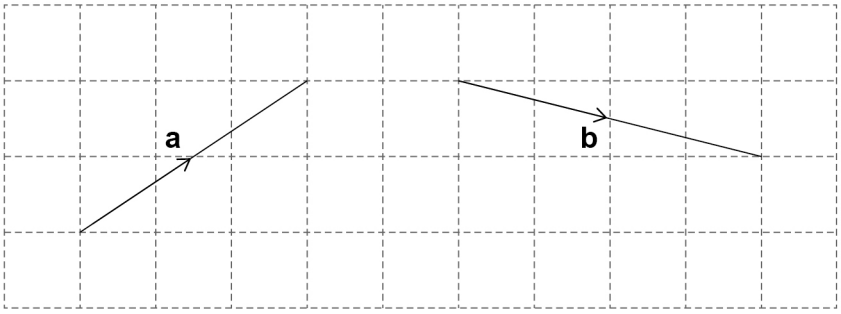

21 (a) What is **b** as a column vector?

[2 marks]

Answer $\begin{pmatrix} \quad \\ \quad \end{pmatrix}$

21 (b) Work out 4**a** as a column vector.

[1 mark]

Answer $\begin{pmatrix} \quad \\ \quad \end{pmatrix}$

21 (c) $\mathbf{a} + \mathbf{c} = \begin{pmatrix} 3 \\ 0 \end{pmatrix}$

Work out **c** as a column vector.

Circle your answer.

[1 mark]

$\begin{pmatrix} 2 \\ 0 \end{pmatrix}$ $\begin{pmatrix} 0 \\ 2 \end{pmatrix}$ $\begin{pmatrix} -2 \\ 0 \end{pmatrix}$ $\begin{pmatrix} 0 \\ -2 \end{pmatrix}$

Do not write outside the box

22 Work out $\left(\frac{7}{10} - \frac{4}{15}\right) \div \frac{2}{3}$

Give your answer as a fraction.

[3 marks]

Answer _____

23 Work out all the **integer** values of x for which $12 \leqslant 4x < 25$

[2 marks]

Answer _____

9

Turn over ►

Do not write outside the box

24 Here is some information about 120 people who visit a shop.

$\frac{3}{4}$ of the people buy neither a coat nor a dress.

19 people buy a coat.

14 people buy a dress.

Complete this Venn diagram to represent the information.

[3 marks]

ξ = 120 people who visit the shop

C = people who buy a coat

D = people who buy a dress

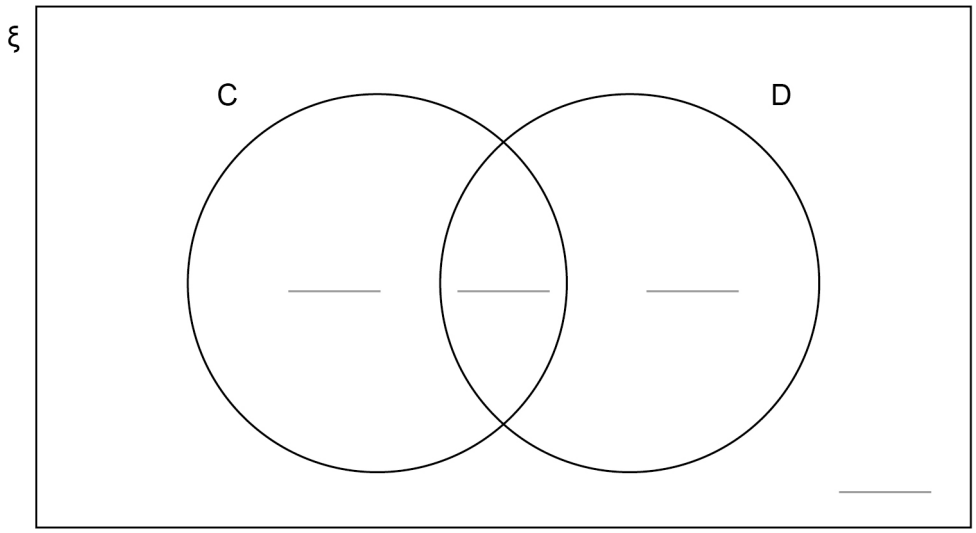

Do not write outside the box

25 Write $(3^6 \times 3^5) : 3^7$ in the form $n : 1$ where n is an integer.

[3 marks]

Answer _____ : 1

26 a is 10% more than b.

Circle the ratio $a : b$

[1 mark]

10 : 11 10 : 1 11 : 10 1 : 10

Turn over for the next question

7

Do not write outside the box

27 Use trigonometry to work out the value of x.

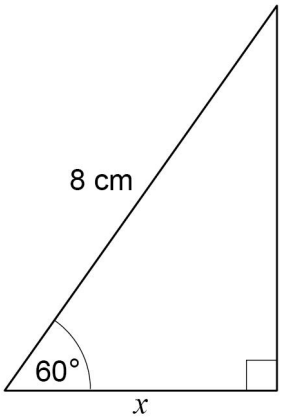

Not drawn accurately

[3 marks]

$x =$ _____ cm

END OF QUESTIONS

3

Do not write outside the box

There are no questions printed on this page

DO NOT WRITE ON THIS PAGE
ANSWER IN THE SPACES PROVIDED

Do not write outside the box

Question number	**Additional page, if required.** **Write the question numbers in the left-hand margin.**

Do not write outside the box

Question number	**Additional page, if required.** **Write the question numbers in the left-hand margin.**

Do not write outside the box

Question number	**Additional page, if required.** **Write the question numbers in the left-hand margin.**

Do not write outside the box

Question number	**Additional page, if required.** **Write the question numbers in the left-hand margin.**

Do not write outside the box

There are no questions printed on this page

DO NOT WRITE ON THIS PAGE
ANSWER IN THE SPACES PROVIDED

Copyright information

For confidentiality purposes, all acknowledgements of third-party copyright material are published in a separate booklet. This booklet is published after each live examination series and is available for free download from www.aqa.org.uk.

Permission to reproduce all copyright material has been applied for. In some cases, efforts to contact copyright-holders may have been unsuccessful and AQA will be happy to rectify any omissions of acknowledgements. If you have any queries please contact the Copyright Team.

Copyright © 2022 AQA and its licensors. All rights reserved.