Please write clearly in block capitals.

Centre number | | | | | | Candidate number | | | | |

Surname _____

Forename(s) _____

Candidate signature _____

GCSE
MATHEMATICS

F

Foundation Tier Paper 1 Non-Calculator

Tuesday 5 November 2019 Morning Time allowed: 1 hour 30 minutes

Materials

For this paper you must have:
- mathematical instruments

You must **not** use a calculator.



Instructions

- Use black ink or black ball-point pen. Draw diagrams in pencil.
- Fill in the boxes at the top of this page.
- Answer **all** questions.
- You must answer the questions in the spaces provided. Do not write outside the box around each page or on blank pages.
- Do all rough work in this book. Cross through any work you do not want to be marked.

Information

- The marks for questions are shown in brackets.
- The maximum mark for this paper is 80.
- You may ask for more answer paper, graph paper and tracing paper. These must be tagged securely to this answer book.

Advice

In all calculations, show clearly how you work out your answer.

For Examiner's Use	
Pages	Mark
2–3	
4–5	
6–7	
8–9	
10–11	
12–13	
14–15	
16–17	
18–19	
20–21	
22–23	
24–25	
26	
TOTAL	

Do not write outside the box

Answer **all** questions in the spaces provided

1 Circle the value of the digit 9 in the number 7.962

[1 mark]

$\frac{9}{1000}$ $\frac{9}{100}$ $\frac{9}{10}$ 9

2 Solve $3x = 6$

Circle your answer.

[1 mark]

$x = 0.5$ $x = 2$ $x = 3$ $x = 18$

3 Circle the correct statement.

[1 mark]

$0.3 > \frac{1}{4}$ $0.3 = \frac{1}{4}$ $0.3 \leqslant \frac{1}{4}$ $0.3 < \frac{1}{4}$

Do not write outside the box

4 Circle the number that is closest in value to $\sqrt{50}$

[1 mark]

5 7 8 25

5 Work out 76×24

[3 marks]

Answer _____

7

Do not write outside the box

6 The composite bar chart shows the number of students in some classes.

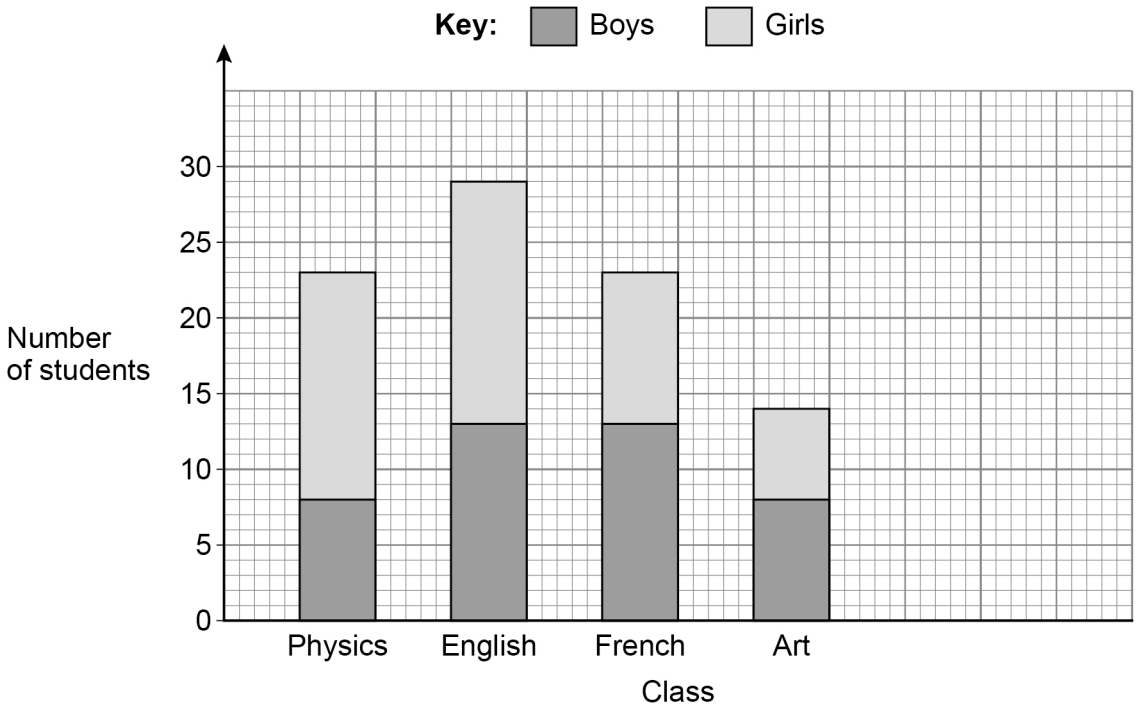

6 (a) How many boys are in the Physics class?

[1 mark]

Answer _____

6 (b) How many girls are in the English class?

[1 mark]

_____

Answer _____

6 (c) Which **two** classes have the same total number of students?

[1 mark]

Answer _____ and _____

Do not write outside the box

6 (d) In the History class

there are 18 students

number of boys = number of girls

Show this information on the bar chart.

[2 marks]

7 (a) Work out $1.86 \div 6$

[1 mark]

Answer _____

7 (b) Work out 0.4×0.2

[1 mark]

Answer _____

7

Do not write outside the box

8 Here are four number cards.

8.6	0.27	6.3	0.4

8 (a) Choose **two** of the cards to make the answer to this calculation a whole number.
Include the answer to the calculation.

[2 marks]

☐ + ☐ = _____

8 (b) Choose **two** of the cards to make the answer to this calculation as large as possible.
Include the answer to the calculation.

[2 marks]

☐ – ☐ = _____

Do not write outside the box

9

Rulers 85p each	Pens £3.50 each

Jenny buys 5 rulers and 2 pens.

She works out how much she should pay.

$5 \times 85p = £4.25$

$2 \times £3.50 = £6.10$

Total = £10.35

Jenny's total is wrong.

What mistake has she made?

Include the correct total in your answer.

[2 marks]

Mistake made _____

_____

_____

Correct total £ _____

Turn over for the next question

6

Do not write outside the box

10 Here are three calculations, A, B and C.

A	**B**	**C**
$100 \times 20\,000$	1 million $\div$ 2	$4 \times 100\,000$

Put the calculations in order.

Start with the calculation that has the smallest answer.

You **must** show the answer to each calculation.

[3 marks]

Smallest _____

_____

Largest _____

Do not write outside the box

11 In a raffle, 200 tickets are sold.
The tickets are either red or blue.

The winning ticket is picked at random.

11 (a) What is the probability that the winning ticket is green?

[1 mark]

Answer _____

11 (b) 79 children and 90 women buy one ticket each.
Men buy the rest of the tickets.

Work out the probability that a man buys the winning ticket.

[2 marks]

_____

_____

_____

Answer _____

Turn over for the next question

6

Do not write outside the box

12 A college has

a total of 105 teachers

19 more female teachers than male teachers.

What proportion of the teachers are female?

[3 marks]

Answer _____

13 By rounding each number to the nearest 10, estimate the value of $262 \div 19.8$

[2 marks]

Answer _____

Do not write outside the box

14 *ABEF* and *ACDF* are rectangles.

$AF = 10$ cm $AB = 2$ cm $BC = 4$ cm



Not drawn accurately

Work out

perimeter *ABEF* : perimeter *ACDF*

Give your answer in its simplest form.

[3 marks]

Answer _____ : _____

Turn over for the next question

8

Do not write outside the box

15 *ADB* and *CD* are straight lines.

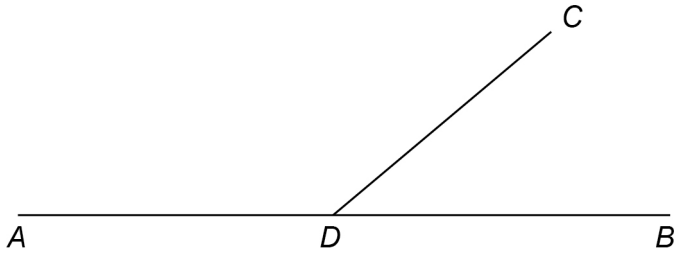

Not drawn accurately

angle *ADC* = 5 × angle *CDB*

Work out the size of angle *ADC*.

[3 marks]

Answer _____ degrees

16 Circle the value of 5^3

[1 mark]

8 15 25 125

Do not write outside the box

17 Draw the graph of $y = 3x - 1$ for values of x from -1 to 3

[3 marks]

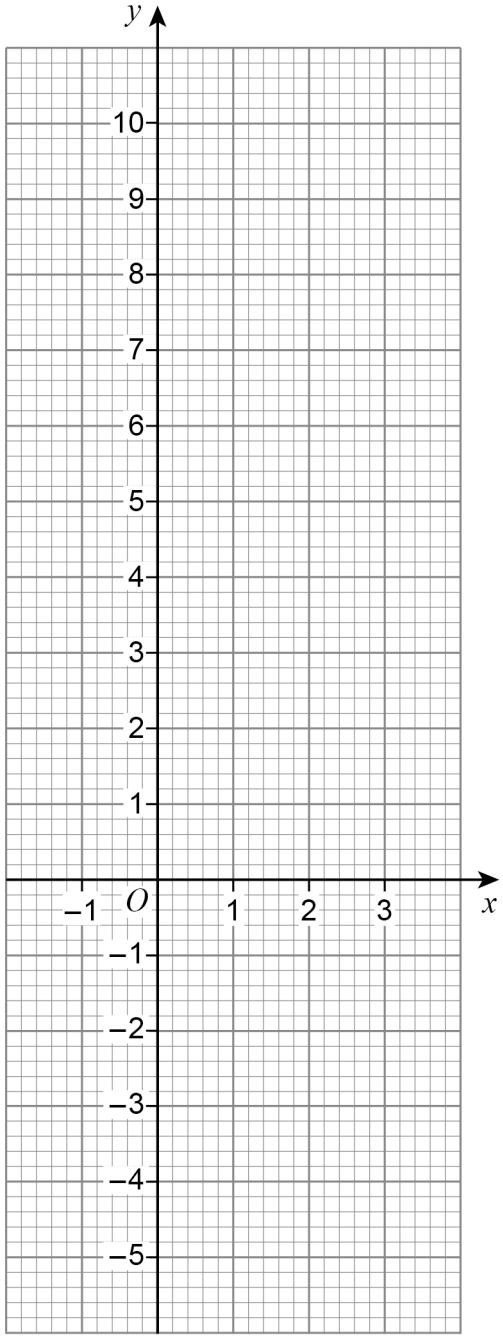

7

Turn over ►

Do not write outside the box

18 Mo played 30 games of chess.

He won 18 of these games.

18 (a) What fraction of the games did he win?

Give your answer in its simplest form.

[2 marks]

Answer _____

18 (b) He played 20 more games.

He had then won 64% of **all** of his games.

How many of the 20 games did he win?

[3 marks]

Answer _____

Do not write outside the box

19 (a) In a field

number of sheep : number of cows = 10 : 3

Zak says,

"There are 10 sheep in the field."

Give a reason why Zak **could** be wrong.

[1 mark]

19 (b) In a different field

number of goats : number of pigs = 13 : 4

Priya says,

"There are more than three times as many goats as pigs."

Is she correct?

Tick **one** box.

☐ Yes ☐ No ☐ Cannot tell

Show working to support your answer.

[1 mark]

7

Do not write outside the box

20 An ordinary fair dice is rolled.

$P(A) = \frac{5}{6}$

Which could be a correct statement about event A?

Tick **one** box.

[1 mark]

☐ The number rolled is even

☐ The number rolled is greater than 1

☐ The number rolled is less than 5

☐ The number rolled is prime

21 Solve $8x + 7 = 2x + 10$

[3 marks]

$x =$ _____

Do not write outside the box

22 In a **right-angled** triangle

smallest angle : largest angle = 2 : 5

Work out the three angles of the triangle.

[4 marks]

_____ degrees

_____ degrees

_____ degrees

23 Which **one** of the following is discrete data?

Circle your answer.

[1 mark]

length of arm height of door number of pets mass of sugar

9

Turn over ►

Do not write outside the box

24 (a) Here are two triangles, P and Q.

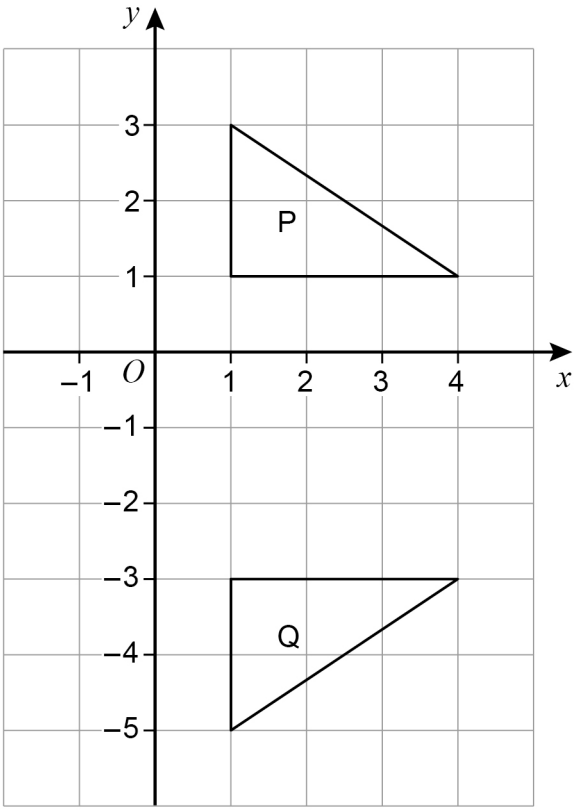

Here is a statement.

A transformation that maps P to Q is a reflection in the line $x = -1$

Make **one** criticism of the statement.

[1 mark]

Do not write outside the box

24 (b) Here are two shapes, C and D.

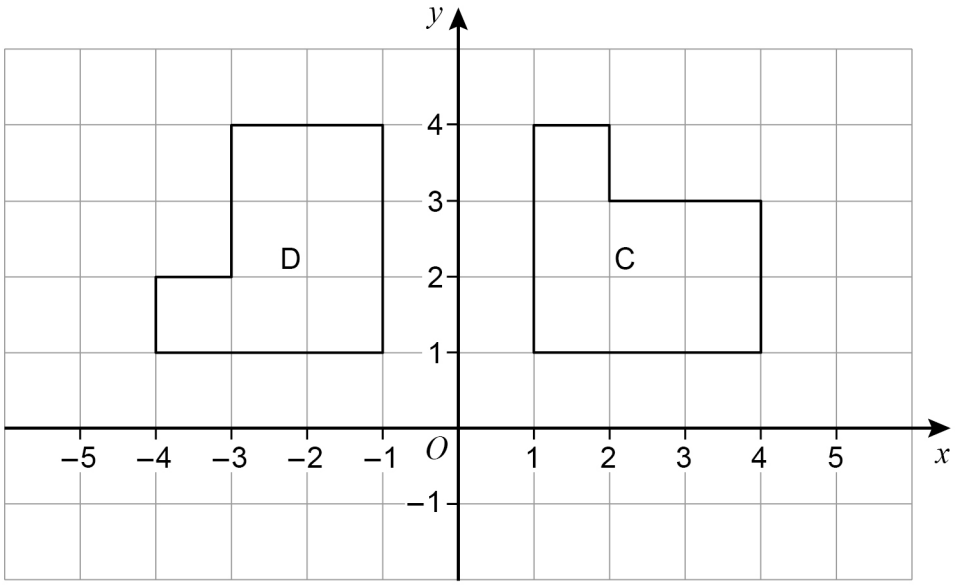

Here is a statement.

A transformation that maps C to D is a rotation through 90° anticlockwise.

Make **one** criticism of the statement.

[1 mark]

_____

_____

Turn over for the next question

2

Do not write outside the box

25 (a) A geometric progression starts 4 16

Work out the next term.

[1 mark]

Answer _____

25 (b) A Fibonacci-type sequence starts 3 –8

The sequence is continued by adding the previous two terms.

Work out the next **two** terms.

[2 marks]

Answer _____ and _____

Do not write outside the box

26 Given that $a \times 60 = b$ work out the value of $\frac{4b}{a}$

[2 marks]

Answer _____

27 Write $27 \times \left(3^2\right)^7$ as a single power of 3

[3 marks]

Answer _____

Turn over for the next question

8

Do not write outside the box

28 Here are two solids.

Cylinder

radius 4 cm height 10 cm

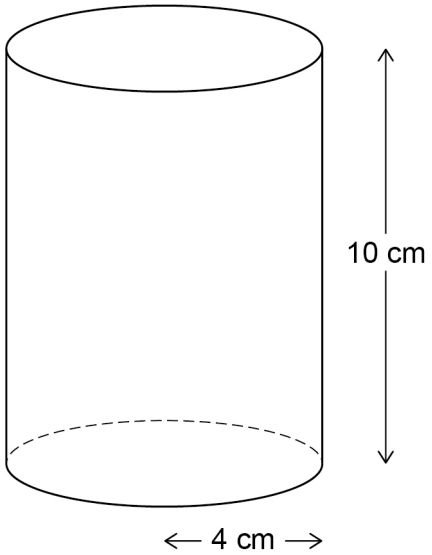

Hemisphere

radius 6 cm

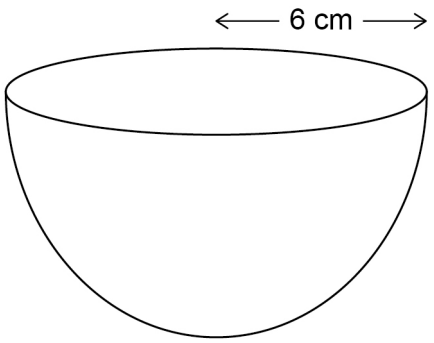

volume of a hemisphere $= \frac{2}{3}\pi r^3$ where r is the radius

Do not write outside the box

Which solid has the greater volume?

You **must** show your working.

[4 marks]

Answer _____

Turn over for the next question

4

Do not write outside the box

29 Saj makes Rose Pink paint and Cherry Pink paint.

He mixes red paint with white paint as shown.

Rose Pink	**Cherry Pink**
red : white = 1 : 2	red : white = 4 : 3

He makes 60 litres of Rose Pink paint.

To this Rose Pink paint he adds

80 litres of red paint and 28 litres of white paint.

Has he now made Cherry Pink paint?

You **must** show your working.

[4 marks]

Do not write outside the box

30 (a) Work out $\dfrac{2 \times 10^{14}}{8 \times 10^{9}}$

Give your answer in standard form.

[2 marks]

Answer _____

30 (b) $6200.07 = 6.2 \times 10^{c} + 7 \times 10^{d}$

Work out the values of c and d.

[2 marks]

$c =$ _____ $d =$ _____

Turn over for the next question

8

Do not write outside the box

31 $V = \frac{k}{H}$ where k is a constant.

Which **two** statements are correct?

Tick **two** boxes.

[1 mark]

☐ V is directly proportional to H

☐ V is inversely proportional to H

☐ V is directly proportional to $\frac{1}{H}$

☐ V is inversely proportional to $\frac{1}{H}$

END OF QUESTIONS

1

Do not write outside the box

There are no questions printed on this page

DO NOT WRITE ON THIS PAGE
ANSWER IN THE SPACES PROVIDED

Do not write outside the box

There are no questions printed on this page

DO NOT WRITE ON THIS PAGE
ANSWER IN THE SPACES PROVIDED

Copyright information

For confidentiality purposes, from the November 2015 examination series, acknowledgements of third-party copyright material are published in a separate booklet rather than including them on the examination paper or support materials. This booklet is published after each examination series and is available for free download from www.aqa.org.uk after the live examination series.

Permission to reproduce all copyright material has been applied for. In some cases, efforts to contact copyright-holders may have been unsuccessful and AQA will be happy to rectify any omissions of acknowledgements. If you have any queries please contact the Copyright Team, AQA, Stag Hill House, Guildford, GU2 7XJ.

Copyright © 2019 AQA and its licensors. All rights reserved.