Please write clearly in block capitals.

Centre number | | | | | | Candidate number | | | | |

Surname _____

Forename(s) _____

Candidate signature _____

GCSE MATHEMATICS

F

Foundation Tier Paper 1 Non-Calculator

Tuesday 6 November 2018 Morning Time allowed: 1 hour 30 minutes

Materials

For this paper you must have:
- mathematical instruments

You must **not** use a calculator.



Instructions

- Use black ink or black ball-point pen. Draw diagrams in pencil.
- Fill in the boxes at the top of this page.
- Answer **all** questions.
- You must answer the questions in the spaces provided. Do not write outside the box around each page or on blank pages.
- Do all rough work in this book. Cross through any work you do not want to be marked.

Information

- The marks for questions are shown in brackets.
- The maximum mark for this paper is 80.
- You may ask for graph paper, tracing paper and more answer paper. These must be tagged securely to this answer book.

Advice

In all calculations, show clearly how you work out your answer.

For Examiner's Use	
Pages	Mark
2–3	
4–5	
6–7	
8–9	
10–11	
12–13	
14–15	
16–17	
18–19	
20–21	
22	
TOTAL	

Do not write outside the box

Answer **all** questions in the spaces provided

1 Work out (–3) + (–8)

Circle your answer.

[1 mark]

–5 5 –11 11

2 What does the longest bar in a bar chart represent?

Circle your answer.

[1 mark]

mean median mode range

3 Work out 1.1 – 0.15

Circle your answer.

[1 mark]

0.95 1.05 0.85 1.085

Do not write outside the box

4 On a circle, which of these is **always** longer than the diameter?

Circle your answer.

[1 mark]

chord arc radius circumference

5 Work out 83 × 26

[3 marks]

Answer _____

7

Turn over ►

Do not write outside the box

6 The cost of 3 calendars is £18

Work out the cost of 5 calendars.

[2 marks]

Answer £ _____

7 A helicopter blade does 3206 full turns in 7 minutes.

Work out the number of full turns per minute.

[2 marks]

Answer _____

Do not write outside the box

8 At a cinema, films are shown on Screen 1 and Screen 2

Customers pay full price or child price.

There are three times as many customers in Screen 2 as Screen 1

68 customers paid child price.

Complete the frequency tree.

[5 marks]

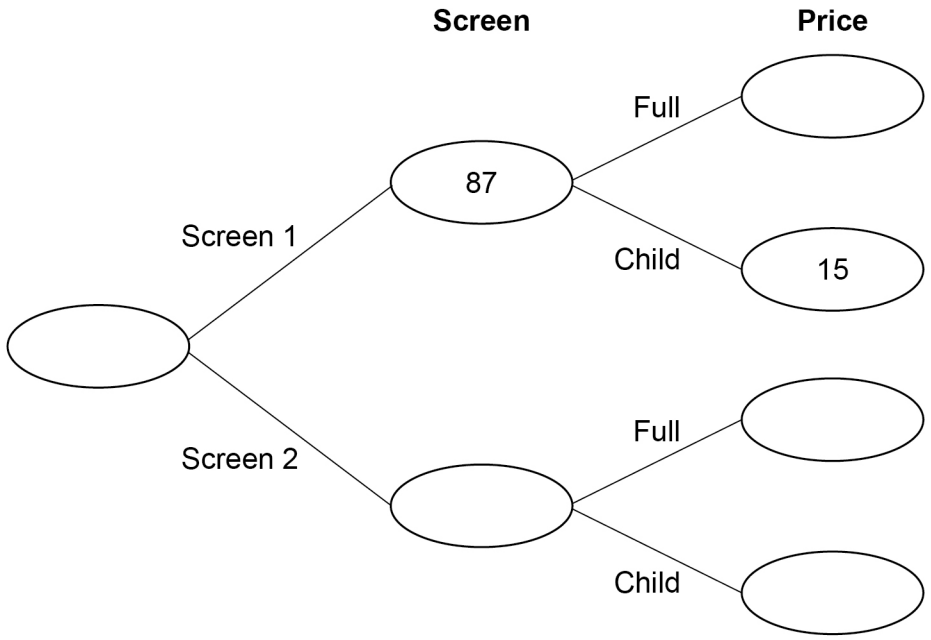

9

Do not write outside the box

9 Work out the fraction that is halfway between $\frac{1}{2}$ and $1\frac{1}{4}$

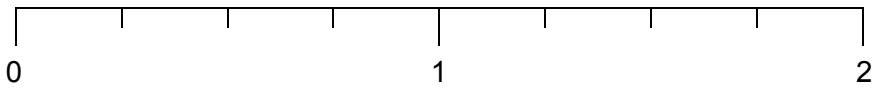

[3 marks]

Answer _____

10 x is a positive integer.

$35 \div x$ is a positive integer.

Work out the **four** possible values of x.

[2 marks]

Answer _____ _____ _____ _____

Do not write outside the box

11 A fair dice has six sides, numbered 1 to 6

After it is rolled, five of the numbers can be seen.

11 (a) Write down the probability that one of these five numbers is 2

[1 mark]

Answer _____

11 (b) Work out the **greatest** possible sum of the five numbers.

[2 marks]

_____

_____

_____

_____

Answer _____

Turn over for the next question

8

Do not write outside the box

12 Work out $\frac{2}{7} + \frac{6}{7}$

Circle your answer.

[1 mark]

$1\frac{1}{7}$ $\frac{8}{14}$ $\frac{8}{49}$ $1\frac{5}{7}$

13 Work out $4 + 3 \times 5 - 1$

Circle your answer.

[1 mark]

16 18 28 34

14 The nth term of a sequence is $5n - 2$

Work out the 3rd term.

Circle your answer.

[1 mark]

51 5 123 13

Do not write outside the box

15 Trapezium *ABCE* is made from parallelogram *ABCD* and isosceles triangle *ADE*.

AE = *DE*

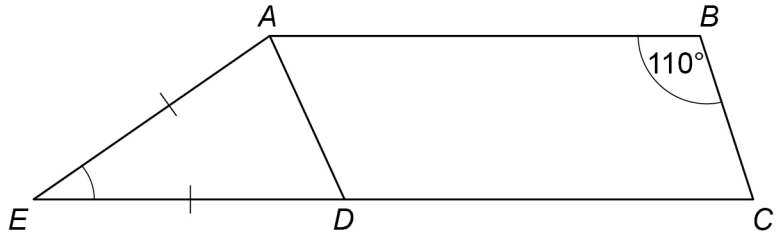

Not drawn accurately

Work out the size of angle *AED*.

[3 marks]

Answer _____ degrees

16 $a : b = 1 : 6$

$a : c = 3 : 1$

How many times bigger is b than c?

[2 marks]

Answer _____

8

Turn over ►

Do not write outside the box

17 (a) Laura wants to work out 3% of 1700

Her method is 1700×0.3

Is her method correct?

Tick a box.

☐ Yes ☐ No

Give a reason for your answer.

[1 mark]

17 (b) Laura also wants to work out $\frac{30}{29}$ of 60

Her answer is 58

Is her answer correct?

Tick a box.

☐ Yes ☐ No

Give a reason for your answer.

[1 mark]

Do not write outside the box

18 Here are five shapes, A to E.

A	Parallelogram
B	Regular pentagon
C	Rhombus
D	Scalene triangle
E	Trapezium

In the Venn diagram,

ξ is the set of all shapes

Q is the set of quadrilaterals

R is the set of shapes which **always** have rotational symmetry.

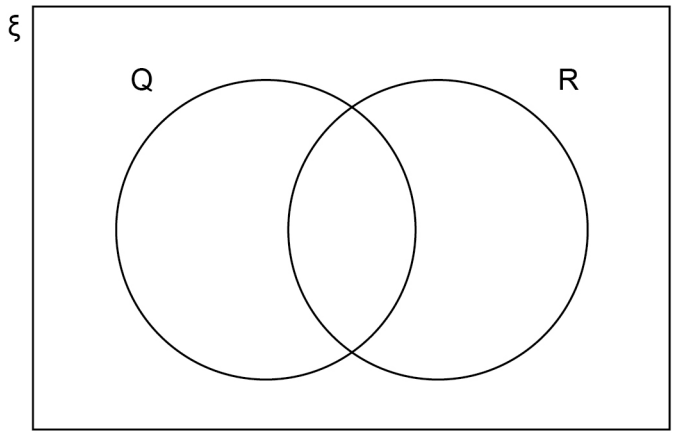

Complete the Venn diagram with the letters A to E.

[3 marks]

5

Turn over ►

Do not write outside the box

19 $a = 7$ and $b = 2$

Work out the value of $\frac{a}{b} - a^b$

[3 marks]

Answer _____

20 Solve $3x - 8 = 19$

[2 marks]

$x =$ _____

Do not write outside the box

21 Here are five number cards.

17	12	23	15	16

Two of the five cards are picked at random.

Work out the probability that the total of the two numbers is **more than** 30

[3 marks]

Answer _____

8

Turn over ►

Do not write outside the box

22 (a) Complete the table of values for $y = x^2$

[1 mark]

x	–2	–1	0	1	2
y					

22 (b) Draw the graph of $y = x^2$ for values of x from –2 to 2

[2 marks]

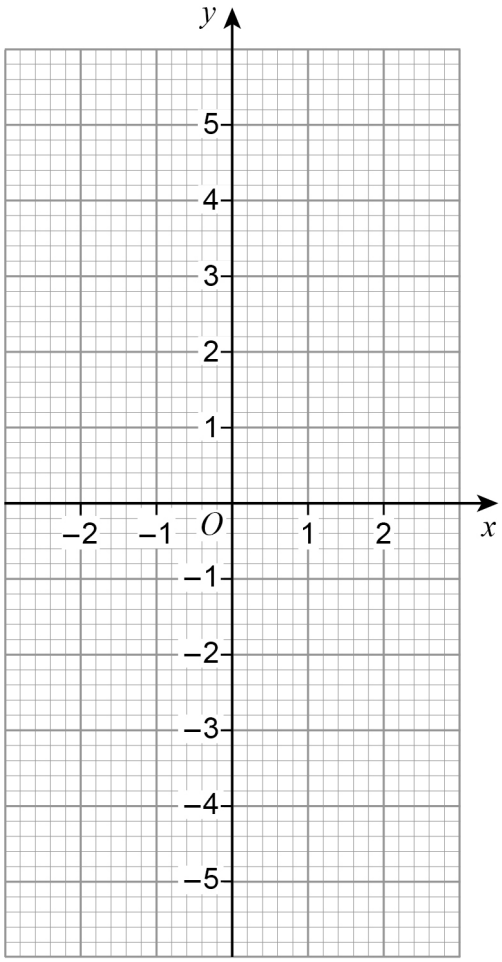

22 (c) Use your graph to estimate the value of $\sqrt{2.6}$

[2 marks]

Answer _____

Do not write outside the box

23 Two consecutive whole numbers are n and $n + 1$

23 (a) Simplify $n - (n + 1)$

[1 mark]

Answer _____

23 (b) Multiply out $n(n + 1)$

[1 mark]

Answer _____

23 (c) The two numbers are added.

Show that the answer must be an odd number.

[2 marks]

9

Turn over ►

Do not write outside the box

24 Circle the value of cos 30°

[1 mark]

$\frac{1}{2}$ $\frac{\sqrt{3}}{2}$ 0 1

25 Work out $8\frac{1}{2} \div 2\frac{2}{3}$

Give your answer as a mixed number.

[4 marks]

Answer _____

Do not write outside the box

26 A ship is sailing in a straight line from its home port.

The distance-time graph shows 4 hours of the journey.

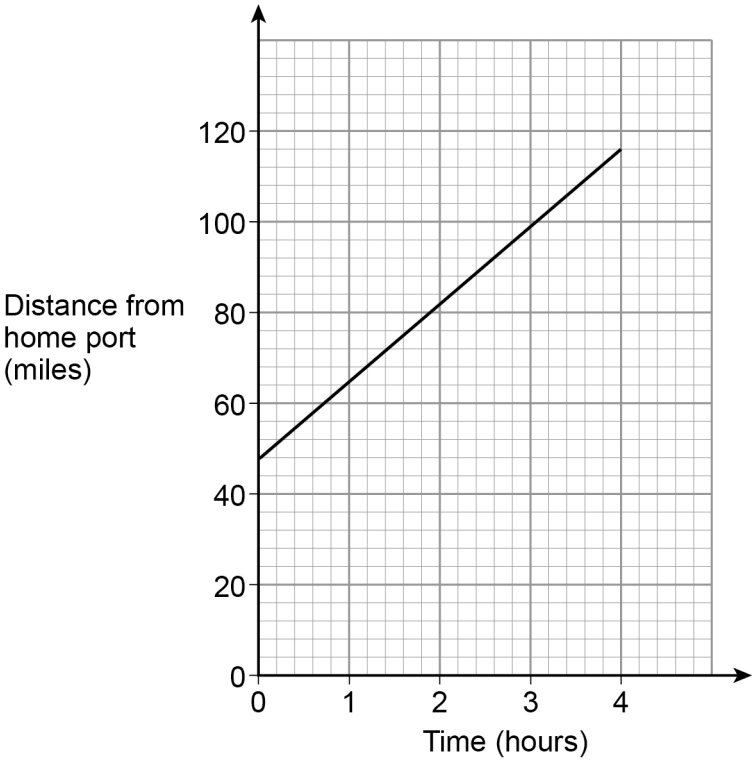

Work out the speed of the ship during these 4 hours.

[3 marks]

Answer _____ mph

8

Turn over ►

Do not write outside the box

27 Kim works at an airport in the UK.

She records the number of planes landing between 10 am and 2 pm each day.

The table shows the data for the first 10 days in January.

Day	1	2	3	4	5	6	7	8	9	10
Number of planes	148	151	147	155	153	147	155	102	151	154

27 (a) The airport was affected by fog on one of the days.

Which day do you think it was?

Give a reason for your answer.

[1 mark]

Day _____

Reason _____

_____

27 (b) Kim uses the data to predict how many planes will land at the airport in a year.

In her method, she

uses an estimate of 150 planes in each 4-hour period throughout the day

assumes the same number of planes each day.

Work out her prediction.

[3 marks]

_____

_____

_____

_____

Answer _____

Do not write outside the box

27 (c) In fact,

fewer planes land in winter than in summer

fewer planes land at night than during the day.

What does this tell you about Kim's prediction?

Tick **one** box.

☐ Her prediction is too low

☐ Her prediction is too high

☐ Her prediction could be too low or too high

Give a reason for your answer.

[2 marks]

Turn over for the next question

6

Do not write outside the box

28 The sum of the angles in any quadrilateral is 360°

For example, in a rectangle $4 \times 90° = 360°$

Zak writes,

$5 \times 90° = 450°$ so the sum of the angles in any pentagon must be 450°

Is he correct?

Tick a box.

☐ Yes ☐ No

Show working to support your answer.

[2 marks]

Do not write outside the box

29 $\sqrt{6^2 + 8^2} = \sqrt[3]{125a^3}$

Work out the value of a.

[4 marks]

Answer _____

30 Work out the percentage increase from 80 to 280

[3 marks]

Answer _____ %

Turn over for the next question

9

Do not write outside the box

31 Solve $x^2 - x - 12 = 0$

[3 marks]

Answer _____

END OF QUESTIONS

3

Do not write outside the box

There are no questions printed on this page

DO NOT WRITE ON THIS PAGE
ANSWER IN THE SPACES PROVIDED

Do not write outside the box

There are no questions printed on this page

DO NOT WRITE ON THIS PAGE
ANSWER IN THE SPACES PROVIDED

Copyright information

For confidentiality purposes, from the November 2015 examination series, acknowledgements of third-party copyright material will be published in a separate booklet rather than including them on the examination paper or support materials. This booklet is published after each examination series and is available for free download from www.aqa.org.uk after the live examination series.

Permission to reproduce all copyright material has been applied for. In some cases, efforts to contact copyright-holders may have been unsuccessful and AQA will be happy to rectify any omissions of acknowledgements. If you have any queries please contact the Copyright Team, AQA, Stag Hill House, Guildford, GU2 7XJ.

Copyright © 2018 AQA and its licensors. All rights reserved.