Please write clearly in block capitals.

Centre number | | | | | | Candidate number | | | | |

Surname _____

Forename(s) _____

Candidate signature _____
I declare this is my own work.

GCSE
MATHEMATICS

F

Foundation Tier Paper 2 Calculator

Monday 3 June 2024 Morning Time allowed: 1 hour 30 minutes

Materials
For this paper you must have:
- a calculator
- mathematical instruments
- the Formulae Sheet (enclosed).



Instructions
- Use black ink or black ball-point pen. Draw diagrams in pencil.
- Fill in the boxes at the top of this page.
- Answer **all** questions.
- You must answer the questions in the spaces provided. Do not write outside the box around each page or on blank pages.
- If you need extra space for your answer(s), use the lined pages at the end of this book. Write the question number against your answer(s).
- Do all rough work in this book. Cross through any work you do not want to be marked.

Information
- The marks for questions are shown in brackets.
- The maximum mark for this paper is 80.
- You may ask for more answer paper, graph paper and tracing paper. These must be tagged securely to this answer book.

Advice
In all calculations, show clearly how you work out your answer.

For Examiner's Use	
Pages	Mark
2–3	
4–5	
6–7	
8–9	
10–11	
12–13	
14–15	
16–17	
18–19	
20–21	
22	
TOTAL	

Do not write outside the box

Answer **all** questions in the spaces provided.

1 (a) Write 0.27 as a fraction.

[1 mark]

Answer _____

1 (b) Write $\frac{2}{5}$ as a decimal.

[1 mark]

Answer _____

1 (c) Write 0.35 as a percentage.

[1 mark]

Answer _____ %

Do not write outside the box

2 (a) Simplify fully $x + 4x$

[1 mark]

Answer _____

2 (b) Simplify fully $5 \times 2w$

[1 mark]

Answer _____

2 (c) Simplify fully $2m \div m$

[1 mark]

Answer _____

2 (d) Simplify fully $y \times y \times y$

[1 mark]

Answer _____

7

Do not write outside the box

3 Here is a quadrilateral.

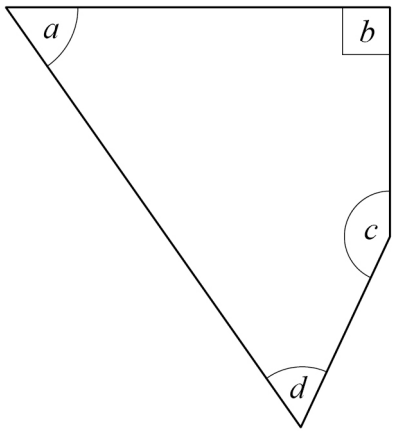

3 (a) Write down the letter of the obtuse angle.

[1 mark]

Answer _____

3 (b) Write down the letter of an acute angle.

[1 mark]

Answer _____

3 (c) How many lines of symmetry does the shape have?

[1 mark]

Answer _____

Do not write outside the box

4 (a) One lettuce costs £1.29

How much do **seven** of these lettuces cost?

[1 mark]

Answer £ _____

4 (b) Five cucumbers cost £6.40 in total.

How much do **two** of these cucumbers cost?

[1 mark]

Answer £ _____

Turn over for the next question

5

Do not write outside the box

5 A company sells three types of bottle.

The pictogram shows how many bottles they sold one week.

Key: 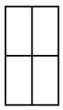 represents 20 bottles



5 (a) The company sold **more** plastic bottles than glass bottles that week.

How many more?

[2 marks]

Answer _____

5 (b) The company sells each **steel** bottle for £17.50

Work out the total amount of money made from selling **steel** bottles that week.

[3 marks]

Answer £ _____

Do not write outside the box

6 Shape *ABCDE* is drawn on a centimetre grid.

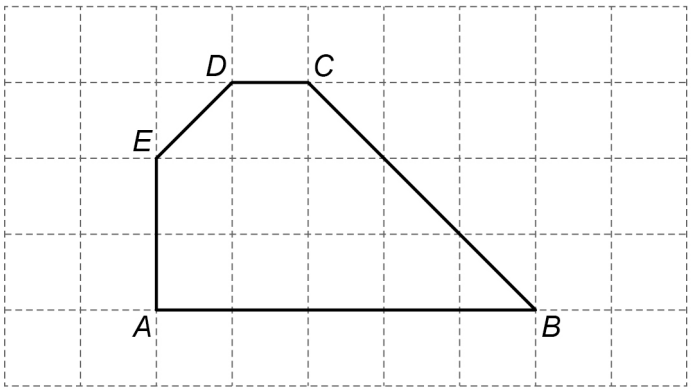

6 (a) Complete this statement.

[1 mark]

AB : _____ = 5 : 1

6 (b) On this centimetre grid,

draw a **rectangle** with the same area as shape *ABCDE*.

[2 marks]

8

Turn over ►

Do not write outside the box

7 Use a ruler for this question.

Here is an **accurate** drawing of an equilateral triangle.

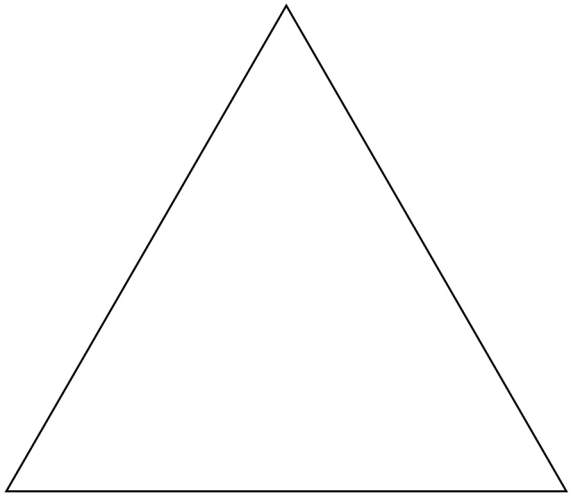

By measuring, work out the perimeter of the triangle.

State the units of your answer.

[3 marks]

Answer _____

Do not write outside the box

8 There are 56 cubes in a box.

The cubes are green, red, blue or white.

17 cubes are green.

There are an **equal** number of red, blue and white cubes.

8 (a) How many red cubes are in the box?

[2 marks]

Answer _____

8 (b) 24 **more** cubes are added to the box.

A cube is picked at random.

The probability that the cube is green is 0.4

How many of the 24 cubes added to the box are green?

[3 marks]

Answer _____

8

Do not write outside the box

9 An electric car uses 1 unit of electricity to travel 3 miles.

1 unit of electricity costs 50 pence.

Work out the cost of electricity, in pounds, to travel 270 miles.

[3 marks]

Answer £ _____

Do not write outside the box

10 (a) Leema buys 2 metres of linen at £8.50 per metre.

She also buys 5 metres of cotton.

The **total** cost is £38

What is the cost of **one** metre of cotton?

[4 marks]

Answer £ _____

10 (b) Buttons cost 65p each.

The greatest number of buttons Leema can buy with £5 is 7

She says,

"The greatest number of buttons I can buy with £10 is 14 because £10 is double £5"

Is she correct?

Tick a box.

Yes ☐ No ☐

Show working to support your answer.

[2 marks]

9

Turn over ►

Do not write outside the box

11 Here is a table of values for the equation $y = 3x + 1$

x	1	2	3	4
y	4	7	10	13

11 (a) Draw the graph of $y = 3x + 1$ for values of x from 1 to 4

[2 marks]

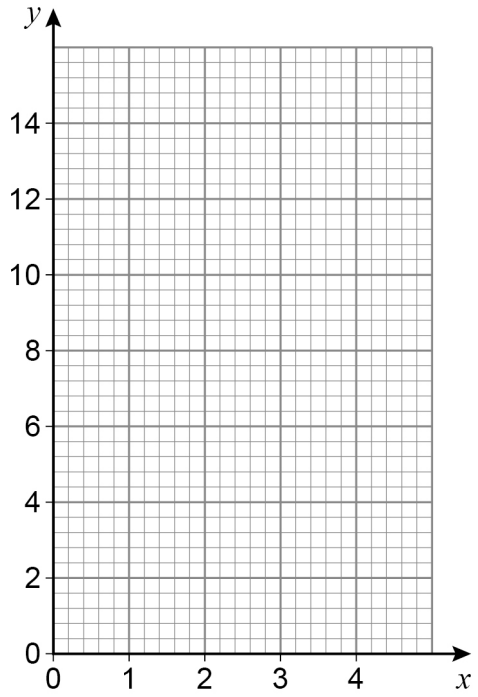

11 (b) Work out the value of y when $x = 2.5$

[2 marks]

$y =$ _____

Do not write outside the box

12 A code has five **different** digits written in order, starting with the smallest.

The last digit is the **only** square number.

The middle digit is the **only** even number.

Work out the code.

[3 marks]

Answer _____ _____ _____ _____ _____

13 Four numbers have a mean of 10

Three of the numbers are 5 8 9

Work out the other number.

[3 marks]

Answer _____

10

Turn over ►

Do not write outside the box

14 (a) Rearrange $d = h - 4$ to make h the subject.

[1 mark]

$h =$ _____

14 (b) Rearrange $p = \frac{w}{3}$ to make w the subject.

[1 mark]

$w =$ _____

15 A linear sequence begins

2 5 8 11

Work out an expression for the nth term.

[2 marks]

Answer _____

Do not write outside the box

16 The diagram shows a circle, centre *O*, and three straight lines.

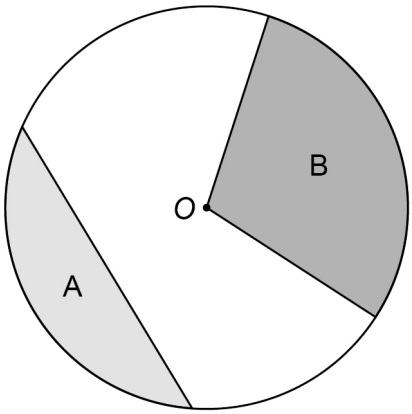

Use **one** word to describe each shaded region.

Choose from

arc	chord	sector	segment	tangent

[2 marks]

Region A _____

Region B _____

17 Work out $\begin{pmatrix} 1 \\ 2 \end{pmatrix} + \begin{pmatrix} 4 \\ 6 \end{pmatrix}$

[1 mark]

_____

_____

Answer $\begin{pmatrix} \quad \\ \quad \end{pmatrix}$

7

Turn over ►

Do not write outside the box

18 Bag A and bag B contain counters.

Bag A	**Bag B**
$\frac{1}{4}$ are red	3 are white
The rest are blue	2 are green

18 (a) Complete the tree diagram.

[2 marks]

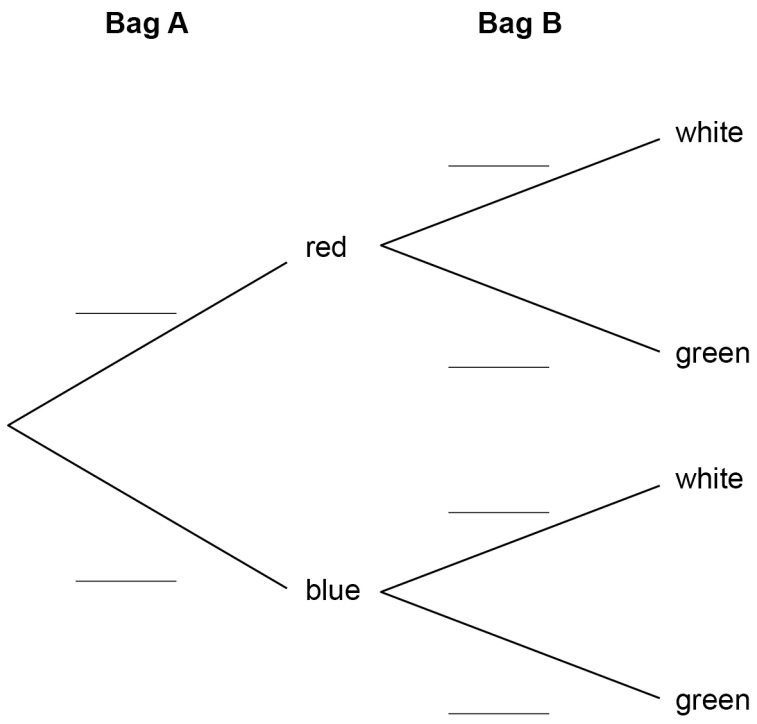

18 (b) One counter is taken at random from each bag.

Work out the probability that one is red and one is white.

[2 marks]

Answer _____

Do not write outside the box

19

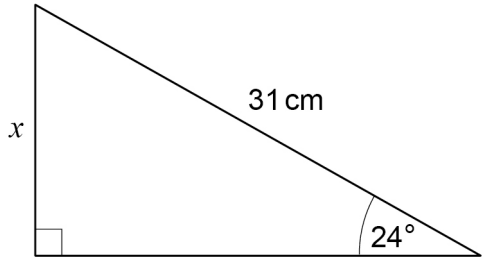

Not drawn accurately

Use trigonometry to work out the value of x.

[3 marks]

$x =$ _____ cm

20 The mass of an iceberg is 2 200 000 kg

This value is a 12% reduction from the **original** mass of the iceberg.

Work out the **original** mass of the iceberg.

Give your answer in standard form.

[3 marks]

Answer _____ kg

10

Turn over ►

Do not write outside the box

21 A chef has a tub of blueberries.

She wants to

use all the blueberries

put the same number of blueberries on each dessert.

$$D = \frac{k}{b}$$

D is the number of desserts.

b is the number of blueberries on each dessert.

21 (a) What does the constant k represent?

Tick the correct box.

[1 mark]

☐ The number of blueberries in the tub

☐ The number of desserts

☐ The number of blueberries on each dessert

☐ None of the above

21 (b) Complete the table.

[2 marks]

b	2	6	
D	120		30

Do not write outside the box

22 (a) A fair spinner has six equal sections, each with the number 5, 6, 7 or 8

Each number appears at least once.

P(even number) = P(7)

Work out P(5)

You may use the blank spinner to help you.

[3 marks]

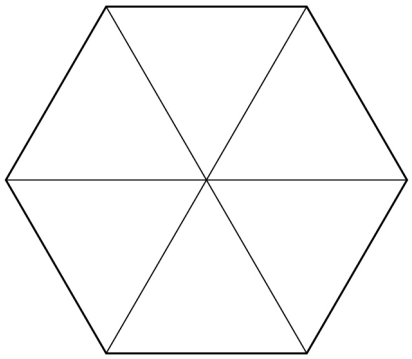

Answer _____

22 (b) A different spinner has ten sections, each labelled A, B, C or D.

	A	**B**	**C**	**D**
Probability	0.1	0.5	0.2	0.3

Give **one** reason why there **must** be a mistake in the table.

[1 mark]

_____

_____

_____

7

Turn over ►

Do not write outside the box

23 (a) Here is a sketch of the graph $y = -2x + 6$

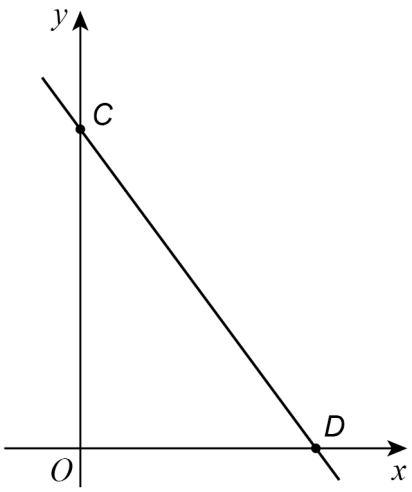

Complete the coordinates of *C* and *D*.

[2 marks]

C (0 , _____) *D* (_____ , 0)

23 (b) Here is a sketch of a quadratic graph.

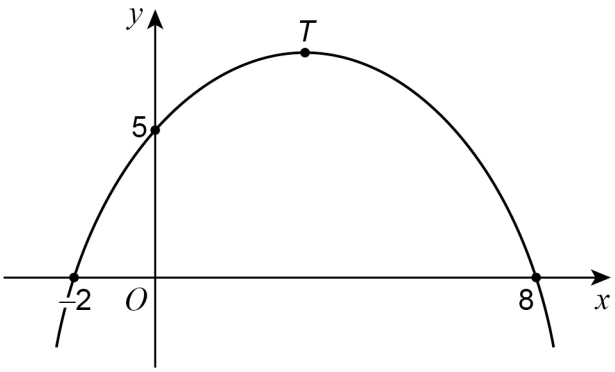

Complete the following statements.

[2 marks]

The value of the ***y*-intercept** is _____

The ***x*-coordinate** of the turning point, *T*, is _____

Do not write outside the box

24 Archie flips a biased coin 200 times.

Here is some information about the outcomes after each 50 flips.

Total number of flips	50	100	150	200
Number of heads	10	27	37	52

Work out the best estimate for the probability of flipping a head.

Give a reason for your answer.

[2 marks]

Answer _____

Reason _____

_____

_____

Turn over for the next question

6

Do not write outside the box

25 A lion is sprinting in a straight line away from its den.

The graph shows the lion's distance from the den.

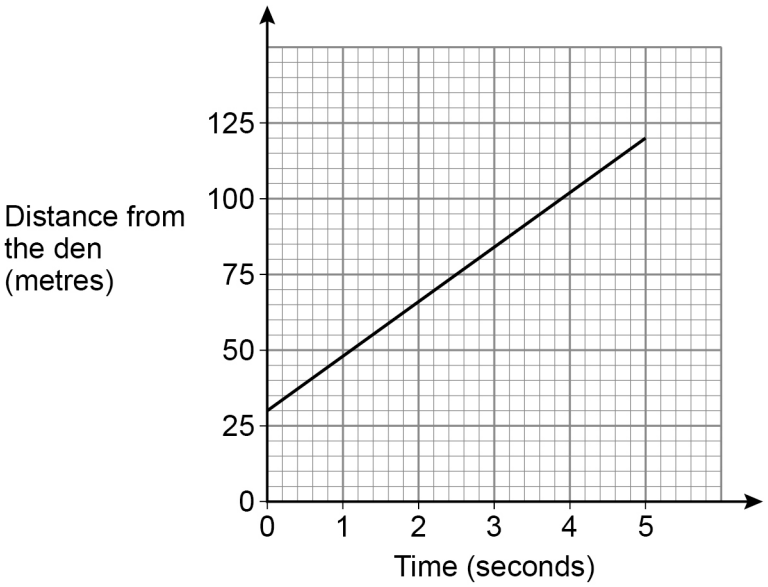

Work out the speed of the lion in metres per second.

[3 marks]

Answer _____ m/s

END OF QUESTIONS

3

Do not write outside the box

There are no questions printed on this page

DO NOT WRITE ON THIS PAGE
ANSWER IN THE SPACES PROVIDED

Do not write outside the box

Question number	**Additional page, if required.** **Write the question numbers in the left-hand margin.**

Do not write outside the box

Question number	**Additional page, if required.** **Write the question numbers in the left-hand margin.**

Do not write outside the box

Question number	**Additional page, if required.** **Write the question numbers in the left-hand margin.**

Do not write outside the box

Question number	**Additional page, if required.** **Write the question numbers in the left-hand margin.**

Do not write outside the box

There are no questions printed on this page

DO NOT WRITE ON THIS PAGE
ANSWER IN THE SPACES PROVIDED

Copyright information

For confidentiality purposes, all acknowledgements of third-party copyright material are published in a separate booklet. This booklet is published after each live examination series and is available for free download from www.aqa.org.uk.

Permission to reproduce all copyright material has been applied for. In some cases, efforts to contact copyright-holders may have been unsuccessful and AQA will be happy to rectify any omissions of acknowledgements. If you have any queries please contact the Copyright Team.

Copyright © 2024 AQA and its licensors. All rights reserved.