AQA

Please write clearly in block capitals.

Centre number | | | | | | Candidate number | | | | |

Surname _____

Forename(s) _____

Candidate signature _____
I declare this is my own work.

GCSE
MATHEMATICS

F

Foundation Tier Paper 2 Calculator

Time allowed: 1 hour 30 minutes

Materials

For this paper you must have:
- a calculator
- mathematical instruments
- the Formulae Sheet (enclosed).

Instructions

- Use black ink or black ball-point pen. Draw diagrams in pencil.
- Fill in the boxes at the top of this page.
- Answer **all** questions.
- You must answer the questions in the spaces provided. Do not write outside the box around each page or on blank pages.
- If you need extra space for your answer(s), use the lined pages at the end of this book. Write the question number against your answer(s).
- Do all rough work in this book. Cross through any work you do not want to be marked.

Information

- The marks for questions are shown in brackets.
- The maximum mark for this paper is 80.
- You may ask for more answer paper, graph paper and tracing paper. These must be tagged securely to this answer book.

Advice

In all calculations, show clearly how you work out your answer.

For Examiner's Use	
Pages	Mark
2–3	
4–5	
6–7	
8–9	
10–11	
12–13	
14–15	
16–17	
18–19	
20–21	
22–23	
24–25	
26–27	
TOTAL	

Do not write outside the box

Answer **all** questions in the spaces provided.

1 Here is a number line.

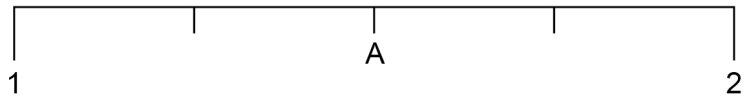

Which number is at A?

Circle your answer.

[1 mark]

1.2 1.4 1.5 1.8

2 Here is an expression $5a + 7b + 9c$

Which is the second term?

Circle your answer.

[1 mark]

a 7 $7b$ 9

3 How many hours are there in 5 days?

Circle your answer.

[1 mark]

35 120 150 300

Do not write outside the box

4 Which of these parts of a circle is a curve?

Circle your answer.

[1 mark]

circumference diameter centre radius

5 (a) Write $1\frac{4}{9}$ as an improper fraction.

[1 mark]

Answer _____

5 (b) Convert $\frac{7}{16}$ to a decimal.

[1 mark]

Answer _____

5 (c) Round 2.84 to 1 decimal place.

[1 mark]

Answer _____

7

Turn over ►

Do not write outside the box

6 A machine to clean carpets can be hired.

Machine hire
£25 per day

Cleaning fluid	
1-litre bottle	£10
2-litre bottle	£18

Rana wants to

hire the machine for 1 day

and

buy 5 litres of cleaning fluid.

Work out the **smallest** total amount she could pay.

[3 marks]

Answer £ _____

Do not write outside the box

7 Quadrilateral *ABCD* has

- angle *ABC* = 90°
- *BC* = 4 cm
- *CD* is parallel to *BA*
- *CD* = 6 cm

Draw *ABCD* on the centimetre grid.

AB has been drawn for you.

[3 marks]

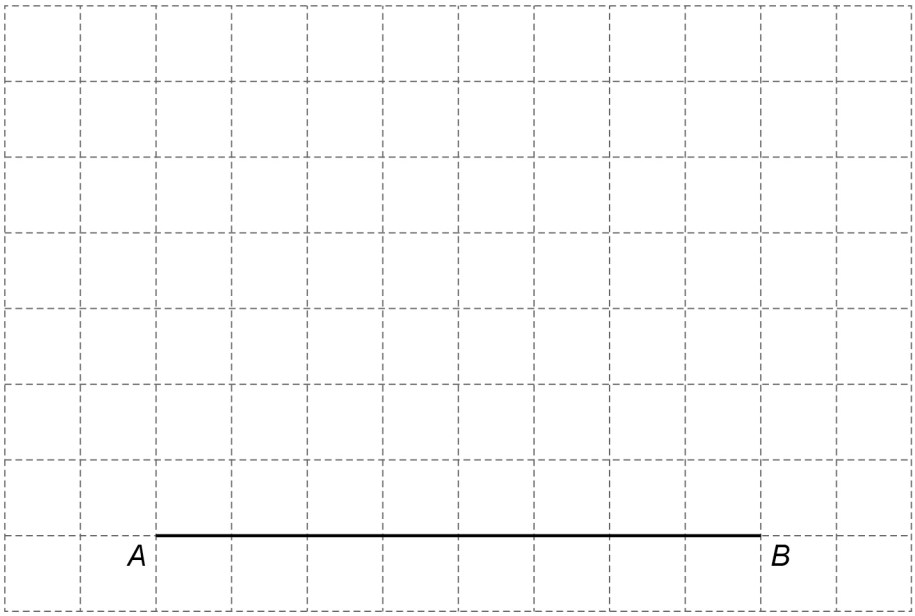

Turn over for the next question

6

Do not write outside the box

8 The masses of some puppies were recorded.

The smallest mass was 7 kilograms 200 grams.

The range of the masses was 650 grams.

What was the **largest** mass?

Give your answer in kilograms and grams.

[2 marks]

Answer _____ kilograms _____ grams

9 (a) Ali revises each day for five days.

On each of the first **four** days he revises from 5 pm to 8 pm

On the fifth day he starts revising at 1 pm

He finishes when he has revised for a **total** of 18 hours for the five days.

What time does he finish on the fifth day?

[3 marks]

Answer _____

Do not write outside the box

9 (b) Sofia is revising for Maths.

She tries to work out $3 \times (4 + 2)$

Here is her working.

$$3 \times (4 + 2) = 12 + 3$$
$$= 15$$

What mistake has she made?

[1 mark]

Turn over for the next question

6

Do not write outside the box

10 Lines *AB* and *BC* are shown.

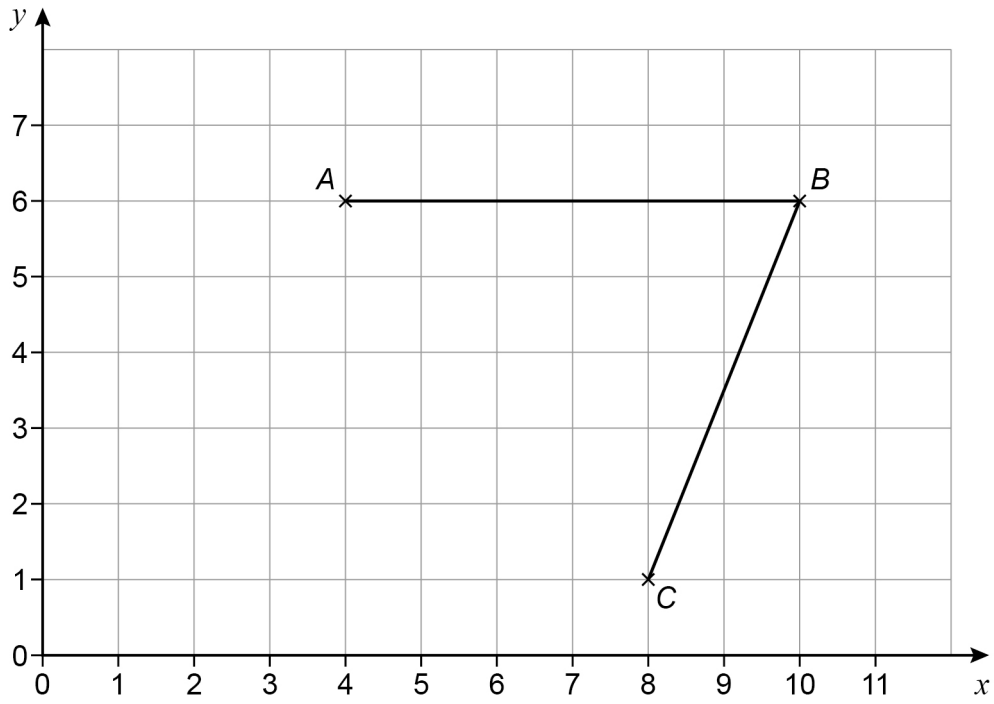

10 (a) Write down the coordinates of *C*.

[1 mark]

Answer (_____ , _____)

10 (b) Write down the coordinates of the midpoint of *AB*.

[1 mark]

Answer (_____ , _____)

Do not write outside the box

10 (c) *D* is the point on the grid that makes *ABCD* a parallelogram.

Work out the coordinates of *D*.

[1 mark]

Answer (_____ , _____)

10 (d) Write down the equation of the line passing through *A* and *B*.

[1 mark]

Answer _____

Turn over for the next question

4

Do not write outside the box

11 Nihal has savings of £168

He uses $\frac{5}{7}$ of his savings to buy sports equipment.

11 (a) Assume that he will use $\frac{1}{3}$ of the **rest** of the money to buy a shirt.

How much of his savings, in £, will he have left?

[3 marks]

Answer £ _____

Do not write outside the box

11 (b) In fact, he uses **more** than $\frac{1}{3}$ of the rest of the money to buy a shirt.

What does this tell you about how much of his savings he has left?

Tick **one** box.

[1 mark]

☐ It is more than the answer to part (a)

☐ It is the same as the answer to part (a)

☐ It is less than the answer to part (a)

☐ It is not possible to tell

Turn over for the next question

4

Do not write outside the box

12 Sue is working with 2-digit numbers.

She multiplies the digits together to get an answer.

For 63, she multiplies 6 by 3 so 63 gives an answer of 18

12 (a) Write down a different 2-digit number that gives an answer of 18

[1 mark]

Answer _____

12 (b) Write down a 2-digit number that gives an answer of 0

[1 mark]

Answer _____

12 (c) Write down a 2-digit number that gives an answer **greater** than 70

[1 mark]

Answer _____

Do not write outside the box

13 Steve and Molly each buy 480 tea bags.

Small packs	**Large packs**
80 tea bags for £1.90	160 tea bags for £3.25

Steve buys only small packs.

Molly buys only large packs.

In total, how much **more** than Molly does Steve pay?

[4 marks]

Answer £ _____

7

Turn over ►

Do not write outside the box

14 Match each expression on the left with one on the right.

One has been done for you.

[3 marks]

$a + 3 + 2$	$a + 6$
$a + 3 \times 2$	$a + 5$
$a \times 3 \times 2$	$3a + 6$
$a \times 3 + 2$	$6a$
	$3a + 2$

Do not write outside the box

15 The scale drawing shows a tree and a student.

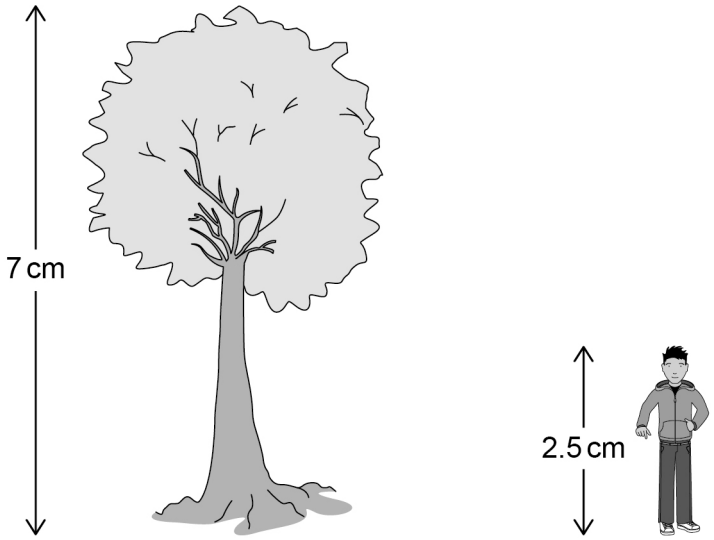

The actual height of the tree is 4.2 metres.

Work out the actual height of the student.

[3 marks]

Answer _____ m

6

Turn over ►

Do not write outside the box

16 60 people were asked if they would vote in an election.

- $\frac{1}{4}$ of the people said No
- 20 people said Yes
- The rest said Maybe

Draw and label a pie chart to show this information.

[3 marks]

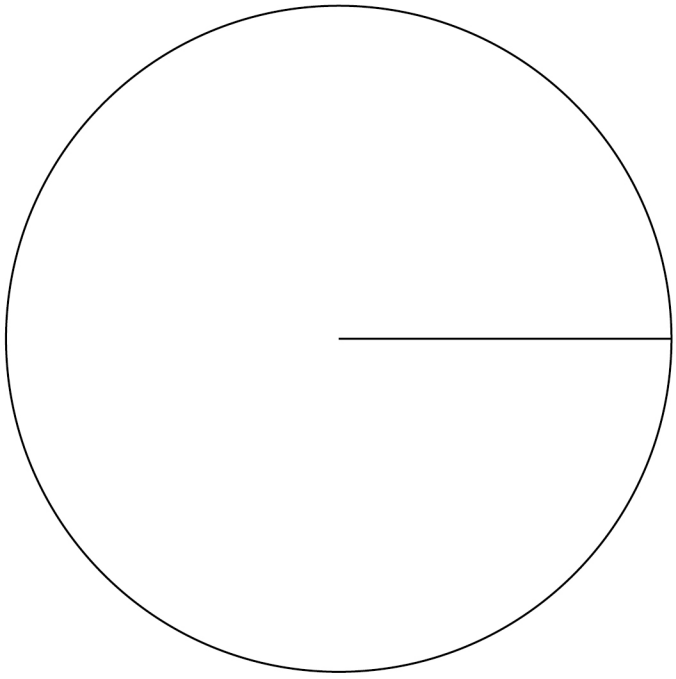

Do not write outside the box

17 (a) x is at least 7

Circle the correct inequality.

[1 mark]

$x < 7$ $\quad$ $x \leqslant 7$ $\quad$ $x > 7$ $\quad$ $x \geqslant 7$

17 (b) Multiply out $5c(2d + 1)$

[2 marks]

Answer _____

17 (c) Factorise $21x + 28$

[1 mark]

Answer _____

7

Turn over ►

Do not write outside the box

18 (a) The people at a party are either adults or children.

adults : children = 9 : 11

What percentage are adults?

[2 marks]

Answer _____ %

18 (b) The people at a different party are from Spain, France or Germany.

68% are from Spain

number from France = number from Germany

Work out number from Spain : number from France

Give your answer in the form n : 1

[3 marks]

Answer _____ : 1

Do not write outside the box

19 (a) Circle the point that is on the line $4x + y = 7$

[1 mark]

(2, 1) (2, –1) (1, 2) (–1, 2)

19 (b) Write down the coordinates of the y-intercept of the line $y = 3x + 8$

[1 mark]

Answer (_____ , _____)

19 (c) Work out the gradient of the line $2y = 10x$

[1 mark]

Answer _____

Turn over for the next question

8

Do not write outside the box

20 Jose and Maria each take a test.

The probability that Jose passes is 0.8

The probability that Maria passes is 0.4

20 (a) Complete the tree diagram.

[2 marks]

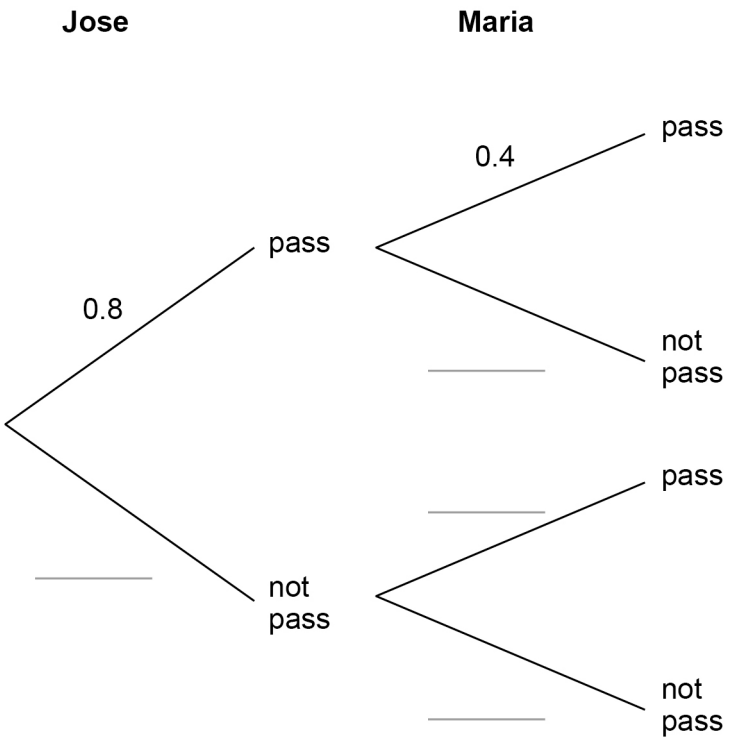

20 (b) Work out the probability that they **both** pass.

[1 mark]

Answer _____

Do not write outside the box

21 Show that 2125 can be written as

a cube number **multiplied** by a prime number between 10 and 20

[2 marks]

Turn over for the next question

5

Do not write outside the box

22 A school play takes place each day from Monday to Friday.

Here are the attendances on four of the days.

Monday	Tuesday	Wednesday	Thursday
72	83	88	97

For all **five** days, the mean attendance is 90

Work out the attendance on Friday.

[3 marks]

Answer _____

Do not write outside the box

23 Sam types a constant number of words per minute.

He takes 8 minutes to type a report of 416 words.

How long does it take him to type an essay of 1534 words?

Give your answer in minutes and seconds.

[3 marks]

Answer _____ minutes _____ seconds

24 $4y = 5x$

Which statement is correct?

Tick **one** box.

[1 mark]

☐ y is 80% of x

☐ y is 125% of x

☐ x is 20% of y

☐ x is 400% of y

7

Do not write outside the box

25 Rosie makes phone calls to try to sell broadband.

Today, she made 120 calls.

The table shows the results.

Result of call	Frequency
Not answered	33
Answered but sale not made	81
Answered and sale made	6

25 (a) Write down the relative frequency that a call was **not answered**.

[1 mark]

Answer _____

25 (b) During the **rest of the week**, Rosie will make 500 calls.

Using the results in the table, how many sales does she expect to make during the **rest of the week**?

[2 marks]

_____

_____

_____

_____

Answer _____

Do not write outside the box

26 Harry and Ellie each bought a printer and a hard drive.

Here is some information about how much they paid.

	Printer	**Hard drive**
Harry	£80	£25
Ellie	10% less than Harry	20% more than Harry

Ellie says,

"In total, I paid more than Harry because 20% is greater than 10%"

Is she correct?

Tick a box.

Yes ☐ No ☐

Show calculations to support your answer.

[2 marks]

5

Do not write outside the box

27 A shape is made by joining a right-angled triangle to a rectangle.

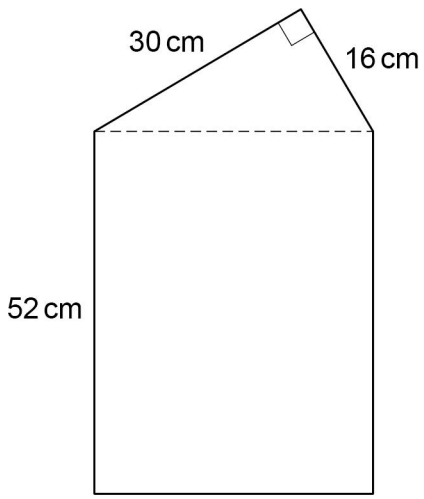

Not drawn accurately

Work out the area of the shape.

[5 marks]

Answer _____ cm^2

Do not write outside the box

28 Solve $5(2x - 1) = 6x + 9$

[3 marks]

$x =$ _____

END OF QUESTIONS

8

Do not write outside the box

There are no questions printed on this page

DO NOT WRITE ON THIS PAGE
ANSWER IN THE SPACES PROVIDED

Do not write outside the box

Question number	**Additional page, if required.** **Write the question numbers in the left-hand margin.**

Do not write outside the box

Question number	**Additional page, if required.** **Write the question numbers in the left-hand margin.**

Do not write outside the box

Question number	**Additional page, if required.** **Write the question numbers in the left-hand margin.**

Do not write outside the box

There are no questions printed on this page

DO NOT WRITE ON THIS PAGE
ANSWER IN THE SPACES PROVIDED

Copyright information

For confidentiality purposes, all acknowledgements of third-party copyright material are published in a separate booklet. This booklet is published after each live examination series and is available for free download from www.aqa.org.uk.

Permission to reproduce all copyright material has been applied for. In some cases, efforts to contact copyright-holders may have been unsuccessful and AQA will be happy to rectify any omissions of acknowledgements. If you have any queries please contact the Copyright Team.

Copyright © 2022 AQA and its licensors. All rights reserved.